GradeMax

Cambridge Assessment International Education

Cambridge International AS & A Level

CANDIDATE NAME	
CENTRE NUMBER	
CANDIDATE NUMBER	

3967186601

MATHEMATICS **9709/11**

Paper 1 Pure Mathematics 1 **May/June 2023**

1 hour 50 minutes

You must answer on the question paper.

You will need: List of formulae (MF19)

INSTRUCTIONS

- Answer **all** questions.
- Use a black or dark blue pen. You may use an HB pencil for any diagrams or graphs.
- Write your name, centre number and candidate number in the boxes at the top of the page.
- Write your answer to each question in the space provided.
- Do **not** use an erasable pen or correction fluid.
- Do **not** write on any bar codes.
- If additional space is needed, you should use the lined page at the end of this booklet; the question number or numbers must be clearly shown.
- You should use a calculator where appropriate.
- You must show all necessary working clearly; no marks will be given for unsupported answers from a calculator.
- Give non-exact numerical answers correct to 3 significant figures, or 1 decimal place for angles in degrees, unless a different level of accuracy is specified in the question.

INFORMATION

- The total mark for this paper is 75.
- The number of marks for each question or part question is shown in brackets [ ].

This document has **20** pages. Any blank pages are indicated.

© UCLES 2023

[Turn over

1 Solve the equation $4 \sin \theta + \tan \theta = 0$ for $0° < \theta < 180°$. [3]

GradeMax

2 **(a)** Find the first three terms in the expansion, in ascending powers of x, of $(2 + 3x)^4$. [2]

.....

.....

.....

.....

.....

.....

.....

(b) Find the first three terms in the expansion, in ascending powers of x, of $(1 - 2x)^5$. [2]

.....

.....

.....

.....

.....

.....

.....

.....

(c) Hence find the coefficient of x^2 in the expansion of $(2 + 3x)^4(1 - 2x)^5$. [2]

.....

.....

.....

.....

.....

.....

.....

© UCLES 2023

[Turn over

3

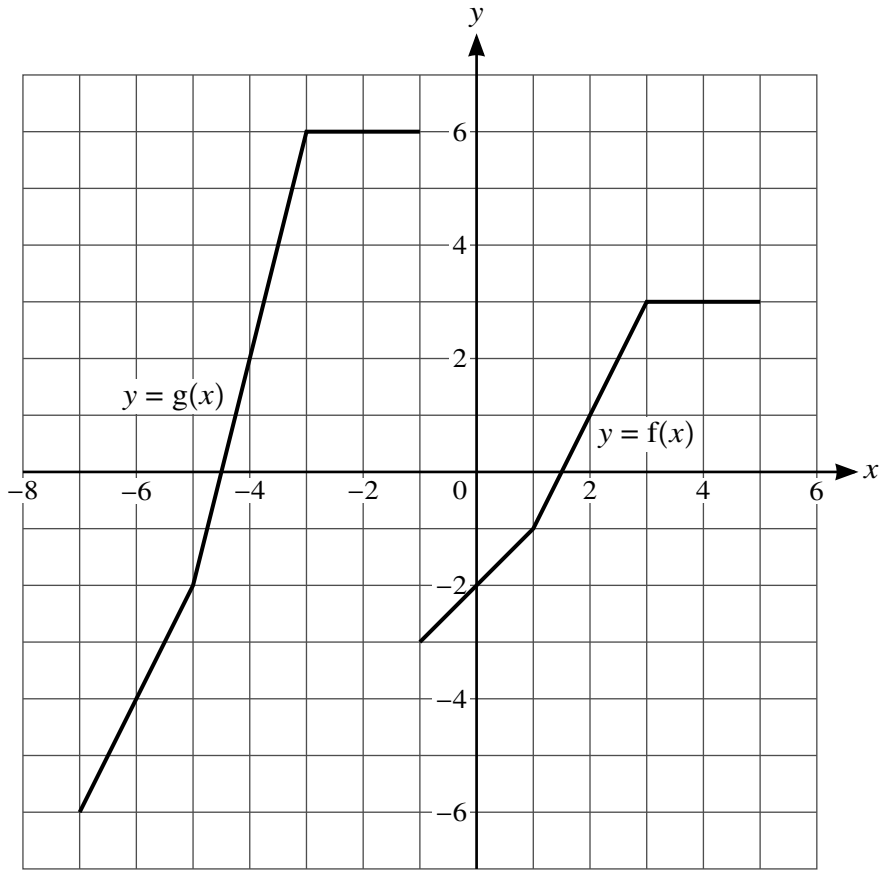

The diagram shows graphs with equations $y = f(x)$ and $y = g(x)$.

Describe fully a sequence of two transformations which transforms the graph of $y = f(x)$ to $y = g(x)$. [4]

.....

.....

.....

.....

.....

.....

.....

.....

.....

.....

.....

.....

© UCLES 2023

GradeMax

4

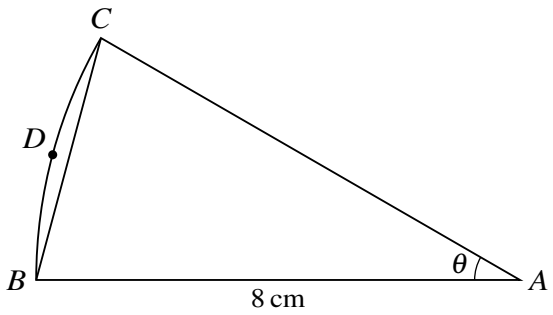

The diagram shows a sector ABC of a circle with centre A and radius 8 cm. The area of the sector is $\frac{16}{3}\pi\,\text{cm}^2$. The point D lies on the arc BC.

Find the perimeter of the segment BCD. [4]

GradeMax

5 The line with equation $y = kx - k$, where k is a positive constant, is a tangent to the curve with equation $y = -\frac{1}{2x}$.

Find, in either order, the value of k and the coordinates of the point where the tangent meets the curve. [5]

GradeMax

6 The first three terms of an arithmetic progression are $\frac{p^2}{6}$, $2p - 6$ and p.

(a) Given that the common difference of the progression is not zero, find the value of p. [3]

.....

.....

.....

.....

.....

.....

.....

.....

.....

.....

.....

.....

.....

.....

.....

(b) Using this value, find the sum to infinity of the geometric progression with first two terms $\frac{p^2}{6}$ and $2p - 6$. [2]

.....

.....

.....

.....

.....

.....

© UCLES 2023

[Turn over

GradeMax

BLANK PAGE

© UCLES 2023

7 A curve has equation $y = 2 + 3\sin\frac{1}{2}x$ for $0 \leqslant x \leqslant 4\pi$.

(a) State greatest and least values of y. [2]

.....

.....

.....

.....

(b) Sketch the curve. [2]

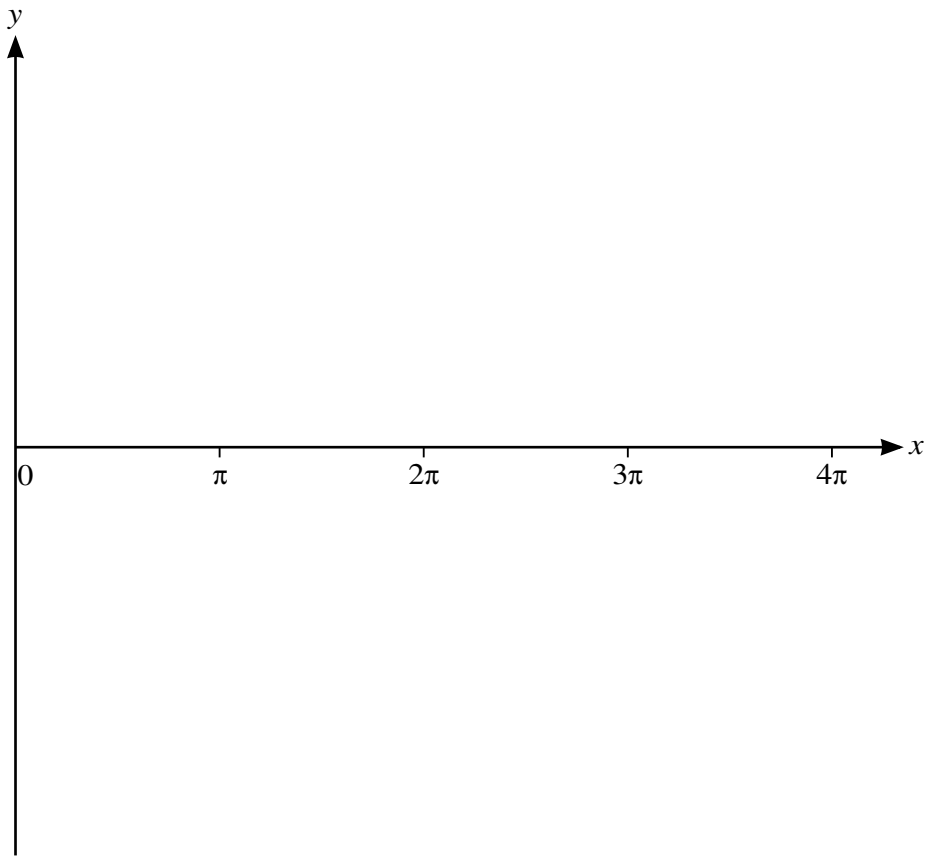

(c) State the number of solutions of the equation

$$2 + 3\sin\tfrac{1}{2}x = 5 - 2x$$

for $0 \leqslant x \leqslant 4\pi$. [1]

.....

.....

.....

.....

8 The functions f and g are defined as follows, where a and b are constants.

$$\mathrm{f}(x) = 1 + \frac{2a}{x - a} \text{ for } x > a$$

$$\mathrm{g}(x) = bx - 2 \text{ for } x \in \mathbb{R}$$

(a) Given that $\mathrm{f}(7) = \frac{5}{2}$ and $\mathrm{gf}(5) = 4$, find the values of a and b. [4]

For the rest of this question, you should use the value of a which you found in **(a)**.

(b) Find the domain of f^{-1}. [1]

.....

.....

.....

.....

.....

.....

(c) Find an expression for $\mathrm{f}^{-1}(x)$. [3]

.....

.....

.....

.....

.....

.....

.....

.....

.....

.....

.....

.....

.....

.....

.....

.....

.....

© UCLES 2023

GradeMax

9 Water is poured into a tank at a constant rate of $500\,\text{cm}^3$ per second. The depth of water in the tank, t seconds after filling starts, is h cm. When the depth of water in the tank is h cm, the volume, $V\,\text{cm}^3$, of water in the tank is given by the formula $V = \frac{4}{3}(25 + h)^3 - \frac{62\,500}{3}$.

(a) Find the rate at which h is increasing at the instant when $h = 10$ cm. [3]

GradeMax

(b) At another instant, the rate at which h is increasing is 0.075 cm per second.

Find the value of V at this instant. [3]

10

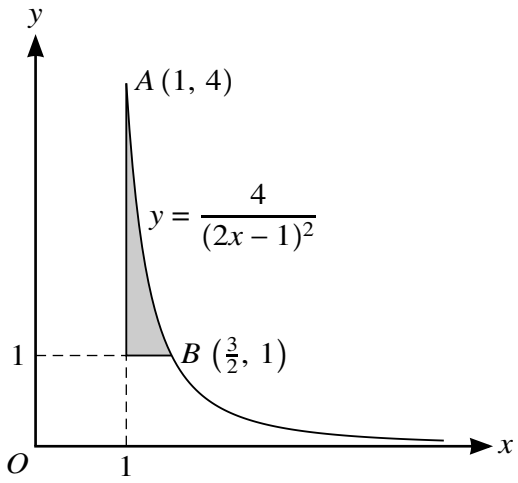

The diagram shows part of the curve with equation $y = \frac{4}{(2x-1)^2}$ and parts of the lines $x = 1$ and $y = 1$. The curve passes through the points $A\,(1,\ 4)$ and $B, \left(\frac{3}{2},\ 1\right)$.

(a) Find the exact volume generated when the shaded region is rotated through 360° about the x-axis. [5]

.....

.....

.....

.....

.....

.....

.....

.....

.....

.....

.....

.....

.....

.....

.....

© UCLES 2023

GradeMax

(b) A triangle is formed from the tangent to the curve at B, the normal to the curve at B and the x-axis.

Find the area of this triangle. [6]

11 The equation of a curve is such that $\frac{dy}{dx} = 6x^2 - 30x + 6a$, where a is a positive constant. The curve has a stationary point at $(a, -15)$.

(a) Find the value of a. [2]

.....

.....

.....

.....

.....

.....

.....

.....

.....

.....

(b) Determine the nature of this stationary point. [2]

.....

.....

.....

.....

.....

.....

.....

.....

.....

.....

.....

.....

© UCLES 2023

GradeMax

(c) Find the equation of the curve. [3]

.....

.....

.....

.....

.....

.....

.....

.....

.....

.....

.....

.....

.....

(d) Find the coordinates of any other stationary points on the curve. [2]

.....

.....

.....

.....

.....

.....

.....

.....

.....

.....

.....

.....

12

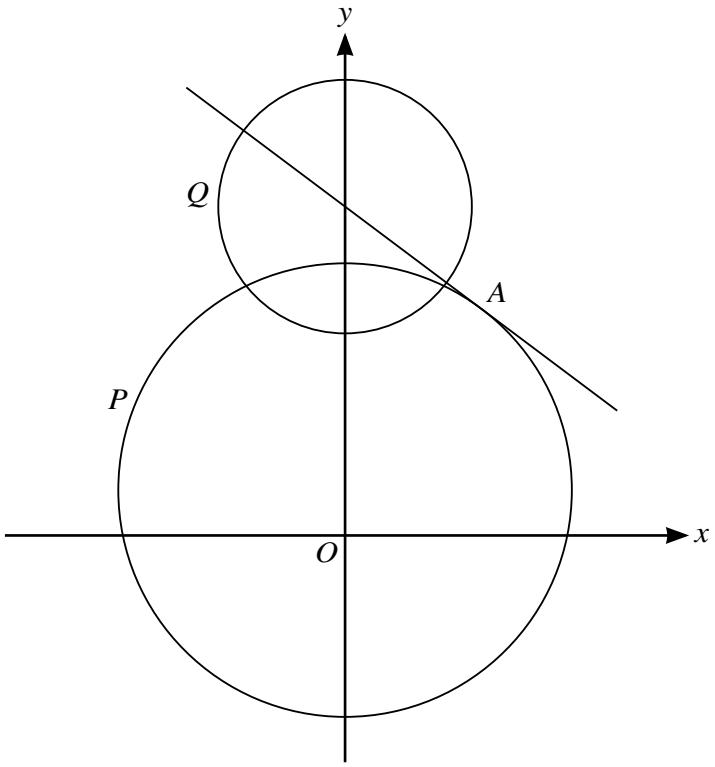

The diagram shows a circle P with centre (0, 2) and radius 10 and the tangent to the circle at the point A with coordinates (6, 10). It also shows a second circle Q with centre at the point where this tangent meets the y-axis and with radius $\frac{5}{2}\sqrt{5}$.

(a) Write down the equation of circle P. [1]

.....

.....

.....

(b) Find the equation of the tangent to the circle P at A. [2]

.....

.....

.....

.....

.....

.....

.....

© UCLES 2023

GradeMax

(c) Find the equation of circle Q and hence verify that the y-coordinates of both of the points of intersection of the two circles are 11. [3]

.....

.....

.....

.....

.....

.....

.....

.....

.....

.....

.....

.....

(d) Find the coordinates of the points of intersection of the tangent and circle Q, giving the answers in surd form. [3]

.....

.....

.....

.....

.....

.....

.....

.....

.....

.....

.....

.....

© UCLES 2023

GradeMax

Additional Page

If you use the following lined page to complete the answer(s) to any question(s), the question number(s) must be clearly shown.

.....

.....

.....

.....

.....

.....

.....

.....

.....

.....

.....

.....

.....

.....

.....

.....

.....

.....

.....

Permission to reproduce items where third-party owned material protected by copyright is included has been sought and cleared where possible. Every reasonable effort has been made by the publisher (UCLES) to trace copyright holders, but if any items requiring clearance have unwittingly been included, the publisher will be pleased to make amends at the earliest possible opportunity.

To avoid the issue of disclosure of answer-related information to candidates, all copyright acknowledgements are reproduced online in the Cambridge Assessment International Education Copyright Acknowledgements Booklet. This is produced for each series of examinations and is freely available to download at www.cambridgeinternational.org after the live examination series.

Cambridge Assessment International Education is part of Cambridge Assessment. Cambridge Assessment is the brand name of the University of Cambridge Local Examinations Syndicate (UCLES), which is a department of the University of Cambridge.

© UCLES 2023