GradeMax

* 0000800000001 * DFD

CAMBRIDGE
International Education

Cambridge International AS & A Level

CANDIDATE NAME

CENTRE NUMBER

CANDIDATE NUMBER

2163113079

MATHEMATICS **9709/13**

Paper 1 Pure Mathematics 1 **May/June 2026**

1 hour 50 minutes

You must answer on the question paper.

You will need: List of formulae (MF19)

INSTRUCTIONS

- Answer **all** questions.
- Use a black or dark blue pen. You may use an HB pencil for any diagrams or graphs.
- Write your name, centre number and candidate number in the boxes at the top of the page.
- Write your answer to each question in the space provided.
- Do **not** use an erasable pen. Do **not** use correction fluid or tape.
- Do **not** write on any bar codes.
- If additional space is needed, you should use the lined page at the end of this booklet; the question number or numbers must be clearly shown.
- You should use a calculator where appropriate.
- You must show all necessary working clearly; no marks will be given for unsupported answers from a calculator.
- Give non-exact numerical answers correct to 3 significant figures, or 1 decimal place for angles in degrees, unless a different level of accuracy is specified in the question.

INFORMATION

- The total mark for this paper is 75.
- The number of marks for each question or part question is shown in brackets [ ].

This document has **16** pages. Any blank pages are indicated.

DC (DE/TC) 358747/2
© Cambridge University Press & Assessment 2026

[Turn over

GradeMax

BLANK PAGE

DO NOT WRITE IN THIS MARGIN
DO NOT WRITE IN THIS MARGIN
DO NOT WRITE IN THIS MARGIN
DO NOT WRITE IN THIS MARGIN
DO NOT WRITE IN THIS MARGIN

© Cambridge University Press & Assessment 2026

GradeMax

1 **(a)** Find the coordinates of the points of intersection of the curve $y = 3x^2 - 12x + 17$ and the line $y = 6x + 2$. [4]

(b) Hence, solve $6x + 2 \geqslant 3x^2 - 12x + 17$. [1]

DO NOT WRITE IN THIS MARGIN

GradeMax

2 **(a)** Express $x\sqrt{x}$ in the form x^n, where n is a rational number. [1]

(b) Hence, solve the equation

$$x^3 - 9x\sqrt{x} + 8 = 0.$$ [3]

DO NOT WRITE IN THIS MARGIN

© Cambridge University Press & Assessment 2026

GradeMax

3 **(a)** Prove the identity

$$\frac{1}{\cos\theta} - \cos\theta \equiv \tan\theta \sin\theta.$$ [3]

(b) Hence, solve the equation

$$\frac{2}{\cos\theta} - 2\cos\theta = \tan\theta$$

for $0° \leqslant \theta \leqslant 360°$. [4]

DO NOT WRITE IN THIS MARGIN
DO NOT WRITE IN THIS MARGIN
DO NOT WRITE IN THIS MARGIN
DO NOT WRITE IN THIS MARGIN
DO NOT WRITE IN THIS MARGIN

GradeMax

4 The equation of a curve is

$$y = 3x - kx^3 + 4,$$

where k is a constant. The point P on the curve has x-coordinate 1. The normal to the curve at P is parallel to the straight line $3y = x$.

(a) Find the value of k. [3]

.....

.....

.....

.....

.....

.....

.....

.....

.....

.....

(b) The point Q is also on the curve. The normal to the curve at Q is also parallel to the line $3y = x$.

Find the coordinates of the point Q. [4]

.....

.....

.....

.....

.....

.....

.....

.....

.....

.....

.....

DO NOT WRITE IN THIS MARGIN
DO NOT WRITE IN THIS MARGIN
DO NOT WRITE IN THIS MARGIN
DO NOT WRITE IN THIS MARGIN
DO NOT WRITE IN THIS MARGIN

© Cambridge University Press & Assessment 2026

GradeMax

5 **(a)** Find the first four terms, in ascending powers of x, in the expansion of $(2+3x)^5$. [3]

.....

.....

.....

.....

.....

.....

.....

(b) Hence, find the expansion up to and including the term in x^3 of $(1-3x)(2+3x)^5$. [2]

.....

.....

.....

.....

.....

.....

.....

(c) Use your answer to **5(b)**, with a suitable value of x, to find an approximation to 0.97×2.03^5.
Write down your answer to 5 decimal places. [3]

.....

.....

.....

.....

.....

.....

.....

.....

.....

.....

DO NOT WRITE IN THIS MARGIN
DO NOT WRITE IN THIS MARGIN
DO NOT WRITE IN THIS MARGIN
DO NOT WRITE IN THIS MARGIN
DO NOT WRITE IN THIS MARGIN

PapaCambridge papacambridge.com

GradeMax

6 The function f is defined by $\mathrm{f}(x) = \frac{16}{x^3} + 3x + 5$ for $x \neq 0$.

(a) Find the coordinates of all stationary points on the curve $y = \mathrm{f}(x)$. [4]

.....

.....

.....

.....

.....

.....

.....

.....

.....

.....

.....

(b) The function g is defined by $\mathrm{g}(x) = \mathrm{f}(x) + a$ where a is a constant. It is given that $\mathrm{g}(-x) \equiv -\mathrm{g}(x)$.

Find the value of a. [3]

.....

.....

.....

.....

.....

.....

.....

.....

.....

.....

.....

.....

© Cambridge University Press & Assessment 2026

DO NOT WRITE IN THIS MARGIN
DO NOT WRITE IN THIS MARGIN
DO NOT WRITE IN THIS MARGIN
DO NOT WRITE IN THIS MARGIN
DO NOT WRITE IN THIS MARGIN

GradeMax

7

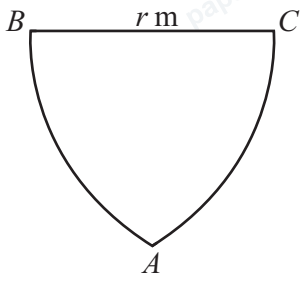

The diagram shows the design for a garden. The points A, B and C form the vertices of an equilateral triangle of side length r metres. The arcs AC and AB are parts of circles with centres B and C respectively and are both of radius r metres.

(a) Find an expression for the perimeter of the garden. Give your answer in terms of π and r. [2]

.....

.....

.....

.....

.....

.....

(b) Given that $r = 18$, find the exact area of the garden. Give your answer in terms of π and $\sqrt{3}$. [4]

.....

.....

.....

.....

.....

.....

.....

.....

.....

.....

.....

.....

© Cambridge University Press & Assessment 2026

DO NOT WRITE IN THIS MARGIN
DO NOT WRITE IN THIS MARGIN
DO NOT WRITE IN THIS MARGIN
DO NOT WRITE IN THIS MARGIN
DO NOT WRITE IN THIS MARGIN

8

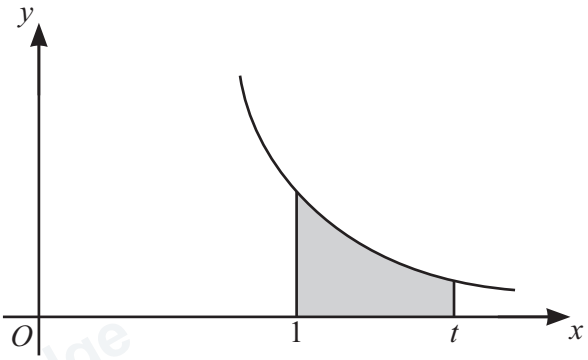

The diagram shows part of the curve with equation $y = \frac{2}{5x^3}$.

The shaded region is bounded by the curve, the x-axis and the lines $x = 1$ and $x = t$. It is given that the area of the shaded region is $\frac{1}{9}$.

Find the value of t. [5]

.....

.....

.....

.....

.....

.....

.....

.....

.....

.....

.....

.....

.....

.....

.....

.....

© Cambridge University Press & Assessment 2026

GradeMax

DO NOT WRITE IN THIS MARGIN

DO NOT WRITE IN THIS MARGIN

DO NOT WRITE IN THIS MARGIN

DO NOT WRITE IN THIS MARGIN

DO NOT WRITE IN THIS MARGIN

GradeMax

9 The equation of a curve is $y = \sqrt{3x+1}$.

(a) Find $\frac{\mathrm{d}y}{\mathrm{d}x}$. [2]

.....

.....

.....

.....

.....

.....

.....

(b) A point P is moving along the curve such that its x-coordinate is increasing at a rate of 6 units per second.

Find the rate at which the y-coordinate of P is changing when $y = 4$. [5]

.....

.....

.....

.....

.....

.....

.....

.....

.....

.....

.....

.....

.....

.....

.....

DO NOT WRITE IN THIS MARGIN
DO NOT WRITE IN THIS MARGIN
DO NOT WRITE IN THIS MARGIN
DO NOT WRITE IN THIS MARGIN
DO NOT WRITE IN THIS MARGIN

© Cambridge University Press & Assessment 2026

GradeMax

10 The first, second and third terms of a geometric progression are equal to the first, fourth and sixth terms of an arithmetic progression respectively. The first term of both progressions is non-zero. The geometric progression has common ratio r.

(a) Show that

$$3r^2 - 5r + 2 = 0.$$ [3]

DO NOT WRITE IN THIS MARGIN

© Cambridge University Press & Assessment 2026

GradeMax

(b) It is given that the sum to infinity of the geometric progression is 54.

Find the common difference of the arithmetic progression. [4]

DO NOT WRITE IN THIS MARGIN

11

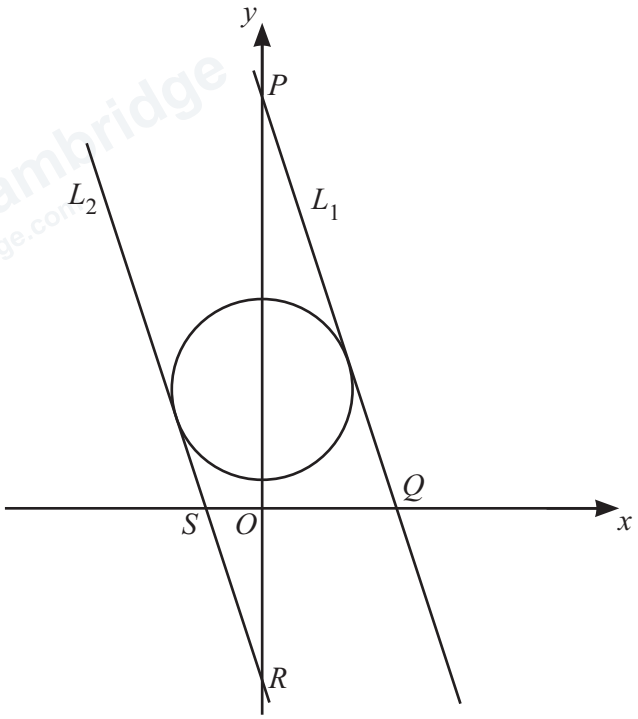

The diagram shows a circle with two tangents, L_1 and L_2. The tangent L_1 intersects the x-axis at Q and the y-axis at P. The tangent L_2 intersects the x-axis at S and the y-axis at R.

(a) The end-points of a diameter of the circle are $\left(0,\ 4-\sqrt{10}\right)$ and $\left(0,\ 4+\sqrt{10}\right)$.

Show that the equation of the circle can be expressed as

$$x^2+y^2-8y+6=0.$$ [3]

.....

.....

.....

.....

.....

.....

.....

.....

.....

.....

.....

© Cambridge University Press & Assessment 2026

DO NOT WRITE IN THIS MARGIN
DO NOT WRITE IN THIS MARGIN
DO NOT WRITE IN THIS MARGIN
DO NOT WRITE IN THIS MARGIN
DO NOT WRITE IN THIS MARGIN

GradeMax

(b) The two tangents, L_1 and L_2, have equations of the form $y = -3x + c$.

Show that $c^2 - 8c - 84 = 0$. [4]

.....

.....

.....

.....

.....

.....

.....

.....

.....

(c) Find the exact area of quadrilateral *PQRS*. [5]

.....

.....

.....

.....

.....

.....

.....

.....

.....

.....

.....

.....

.....

.....

.....

DO NOT WRITE IN THIS MARGIN
DO NOT WRITE IN THIS MARGIN
DO NOT WRITE IN THIS MARGIN
DO NOT WRITE IN THIS MARGIN
DO NOT WRITE IN THIS MARGIN

© Cambridge University Press & Assessment 2026

GradeMax

Additional page

If you use the following page to complete the answer to any question, the question number must be clearly shown.

DO NOT WRITE IN THIS MARGIN
DO NOT WRITE IN THIS MARGIN
DO NOT WRITE IN THIS MARGIN
DO NOT WRITE IN THIS MARGIN
DO NOT WRITE IN THIS MARGIN

Permission to reproduce items where third-party owned material protected by copyright is included has been sought and cleared where possible. Every reasonable effort has been made by the publisher (Cambridge University Press & Assessment) to trace copyright holders, but if any items requiring clearance have unwittingly been included, the publisher will be pleased to make amends at the earliest possible opportunity.

To avoid the issue of disclosure of answer-related information to candidates, all copyright acknowledgements are reproduced online in our Copyright Acknowledgements Booklet. This is produced for each series of examinations and is freely available to download at www.cambridgeinternational.org after the live examination series.

Cambridge International Education is the name of our awarding body and a part of Cambridge University Press & Assessment, which is a department of the University of Cambridge.

© Cambridge University Press & Assessment 2026