GradeMax

* 0000800000001 *





Cambridge IGCSE™

CANDIDATE NAME									
CENTRE NUMBER						CANDIDATE NUMBER			



ADDITIONAL MATHEMATICS

0606/22

Paper 2

February/March 2025

2 hours

You must answer on the question paper.

No additional materials are needed.

INSTRUCTIONS

- Answer **all** questions.
- Use a black or dark blue pen. You may use an HB pencil for any diagrams or graphs.
- Write your name, centre number and candidate number in the boxes at the top of the page.
- Write your answer to each question in the space provided.
- Do **not** use an erasable pen or correction fluid.
- Do **not** write on any bar codes.
- You should use a scientific calculator where appropriate.
- You must show all necessary working clearly.
- Give non-exact numerical answers correct to 3 significant figures, or 1 decimal place for angles in degrees, unless a different level of accuracy is specified in the question.
- For π, use either your calculator value or 3.142.

INFORMATION

- The total mark for this paper is 80.
- The number of marks for each question or part question is shown in brackets [ ].

This document has **16** pages.

DC (DE/SG) 346700/1
© UCLES 2025

[Turn over

GradeMax

List of formulas

Equation of a circle with centre (a, b) and radius r. $(x-a)^2+(y-b)^2=r^2$

Curved surface area, A, of cone of radius r, sloping edge l. $A=\pi rl$

Surface area, A, of sphere of radius r. $A=4\pi r^2$

Volume, V, of pyramid or cone, base area A, height h. $V=\frac{1}{3}Ah$

Volume, V, of sphere of radius r. $V=\frac{4}{3}\pi r^3$

Quadratic equation

For the equation $ax^2+bx+c=0$,

$$x=\frac{-b\pm\sqrt{b^2-4ac}}{2a}$$

Binomial theorem

$$(a+b)^n=a^n+\binom{n}{1}a^{n-1}b+\binom{n}{2}a^{n-2}b^2+\ldots+\binom{n}{r}a^{n-r}b^r+\ldots+b^n,$$

where n is a positive integer and $\binom{n}{r}=\frac{n!}{(n-r)!r!}$

Arithmetic series

$$u_n=a+(n-1)d$$
$$S_n=\frac{1}{2}n(a+l)=\frac{1}{2}n\{2a+(n-1)d\}$$

Geometric series

$$u_n=ar^{n-1}$$
$$S_n=\frac{a(1-r^n)}{1-r}\quad(r\neq 1)$$
$$S_\infty=\frac{a}{1-r}\quad(|r|<1)$$

Identities

$$\sin^2A+\cos^2A=1$$
$$\sec^2A=1+\tan^2A$$
$$\operatorname{cosec}^2A=1+\cot^2A$$

Formulas for ΔABC

$$\frac{a}{\sin A}=\frac{b}{\sin B}=\frac{c}{\sin C}$$
$$a^2=b^2+c^2-2bc\cos A$$
$$\Delta=\frac{1}{2}ab\sin C$$

DO NOT WRITE IN THIS MARGIN
DO NOT WRITE IN THIS MARGIN
DO NOT WRITE IN THIS MARGIN
DO NOT WRITE IN THIS MARGIN
DO NOT WRITE IN THIS MARGIN

* 0000800000003 *

DO NOT WRITE IN THIS MARGIN
DO NOT WRITE IN THIS MARGIN
DO NOT WRITE IN THIS MARGIN
DO NOT WRITE IN THIS MARGIN
DO NOT WRITE IN THIS MARGIN

1

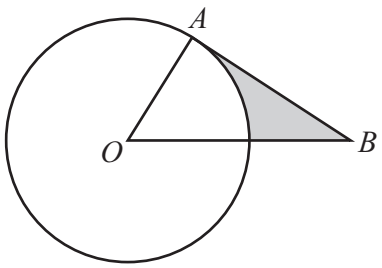

The diagram shows a circle with centre O and radius 5 cm.
The point A lies on the circle.
The point B is such that the line AB is a tangent to the circle.
OB has length 13 cm.

(a) Find angle AOB, giving your answer in radians. [2]

(b) Find the perimeter of the shaded region. [3]

(c) Find the area of the shaded region. [3]

© UCLES 2025

[Turn over

GradeMax

2 **(a)** Find the x-coordinates of the stationary points on the curve $y = \frac{1}{2}(3-2x)(x+2)^2$. [4]

DO NOT WRITE IN THIS MARGIN
DO NOT WRITE IN THIS MARGIN
DO NOT WRITE IN THIS MARGIN
DO NOT WRITE IN THIS MARGIN
DO NOT WRITE IN THIS MARGIN

(b) On the axes, sketch the graph of $y = \frac{1}{2}(3-2x)(x+2)^2$ stating the intercepts with the coordinate axes. [3]

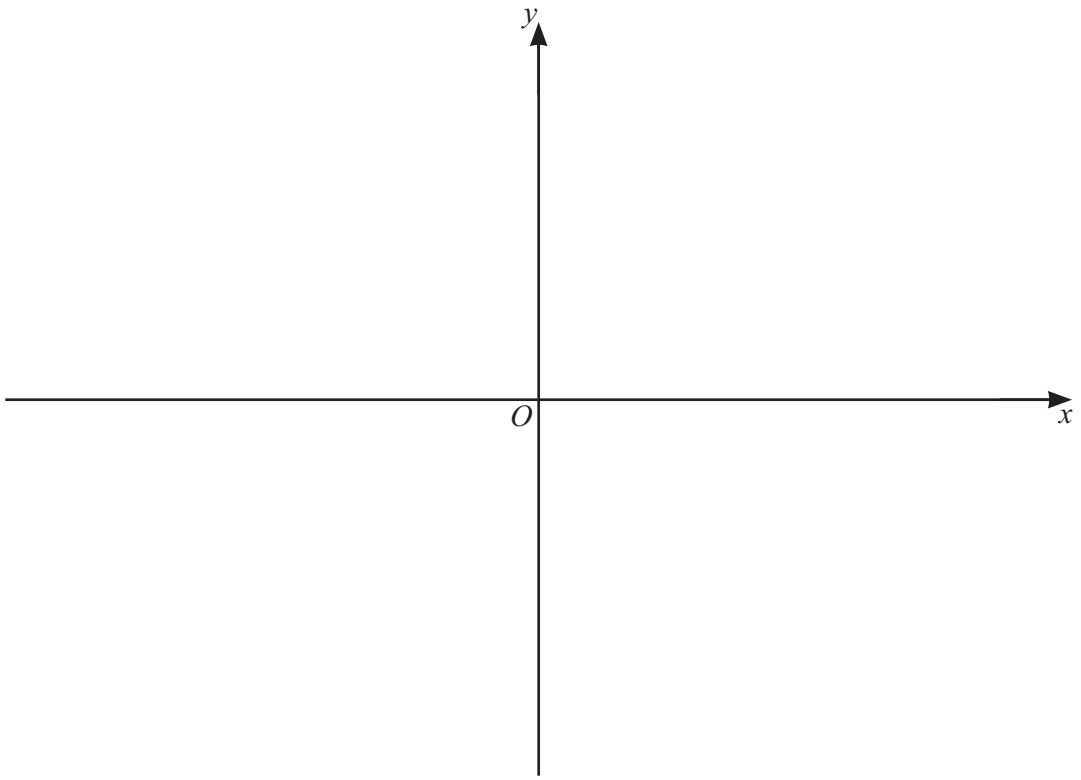

(c) Find the values of k for which the equation $\frac{1}{2}(3-2x)(x+2)^2 = k$ has three real and distinct roots. [2]

DO NOT WRITE IN THIS MARGIN
DO NOT WRITE IN THIS MARGIN
DO NOT WRITE IN THIS MARGIN
DO NOT WRITE IN THIS MARGIN
DO NOT WRITE IN THIS MARGIN

GradeMax

3 Solve the equation $6x^{\frac{3}{5}} + 1 = \dfrac{12}{x^{\frac{3}{5}}}$, giving your answers correct to 2 decimal places. [4]

DO NOT WRITE IN THIS MARGIN
DO NOT WRITE IN THIS MARGIN
DO NOT WRITE IN THIS MARGIN
DO NOT WRITE IN THIS MARGIN
DO NOT WRITE IN THIS MARGIN

GradeMax

DO NOT WRITE IN THIS MARGIN
DO NOT WRITE IN THIS MARGIN
DO NOT WRITE IN THIS MARGIN
DO NOT WRITE IN THIS MARGIN
DO NOT WRITE IN THIS MARGIN

4 **(a)** A team of 10 players is to be chosen from 15 players.

(i) Find the number of different teams that can be chosen if there are no restrictions. [1]

The 15 players include 3 sisters who must **not** be separated.

(ii) Find the number of different teams that can be chosen. [3]

(b) A 6-digit number is to be formed using the digits 0, 1, 2, 3, 4, 5, 6, 7, 8 and 9.
The 6-digit number cannot start with 0 and all six digits must be different.

Find how many 6-digit numbers can be formed if the 6-digit number is even. [3]

GradeMax

5 When e^{y} is plotted against x^2, a straight-line graph with gradient -3 is obtained. The line passes through the point $(4.30, 5.85)$.

(a) Find y in terms of x. [4]

(b) Find the values of x for which y exists. [3]

DO NOT WRITE IN THIS MARGIN
DO NOT WRITE IN THIS MARGIN
DO NOT WRITE IN THIS MARGIN
DO NOT WRITE IN THIS MARGIN
DO NOT WRITE IN THIS MARGIN

GradeMax

DO NOT WRITE IN THIS MARGIN
DO NOT WRITE IN THIS MARGIN
DO NOT WRITE IN THIS MARGIN
DO NOT WRITE IN THIS MARGIN
DO NOT WRITE IN THIS MARGIN

6 It is given that $y = \dfrac{\ln\left(2x^2+1\right)}{x+2}$.

(a) Find $\dfrac{\mathrm{d}y}{\mathrm{d}x}$. [3]

(b) Given that x increases from 2 to $2+h$, where h is small, find the approximate change in y. [2]

(c) Given that y is decreasing by 0.4 units per second, find the corresponding rate of change in x when $x = 2$. [3]

GradeMax

7 It is given that $f(x) = 2e^x + a$ for $x \geqslant 0$, where a is an integer

and $g(x) = \sqrt{x-1}$ for $x \geqslant 1$.

(a) Find the least value of a so that the function gf exists for all $x \geqslant 0$. [2]

(b) In the case where $a = 5$, solve the equation $gf(x) = 3$.
Give your answer correct to 3 decimal places. [3]

DO NOT WRITE IN THIS MARGIN
DO NOT WRITE IN THIS MARGIN
DO NOT WRITE IN THIS MARGIN
DO NOT WRITE IN THIS MARGIN
DO NOT WRITE IN THIS MARGIN

GradeMax

DO NOT WRITE IN THIS MARGIN
DO NOT WRITE IN THIS MARGIN
DO NOT WRITE IN THIS MARGIN
DO NOT WRITE IN THIS MARGIN
DO NOT WRITE IN THIS MARGIN

8 **(a)** Show that $\dfrac{\sin\theta\tan^2\theta}{1+\tan^2\theta}$ can be written as $\sin^3\theta$. [2]

(b) Hence solve the equation $\dfrac{\sin 3x\tan^2 3x}{1+\tan^2 3x} = \dfrac{1}{8}$ for $-180° \leqslant x \leqslant 180°$. [5]

GradeMax

9 In this question, all lengths are in metres and time is in seconds.

A particle, P, moves in a straight line such that t seconds after passing through a fixed point O its displacement, s, is given by $s = 5\ln(2t+1) - 5t$.

(a) Find the value of t for which P is instantaneously at rest. [4]

(b) Find the distance P travels between $t = 0$ and $t = 2$. [4]

DO NOT WRITE IN THIS MARGIN
DO NOT WRITE IN THIS MARGIN
DO NOT WRITE IN THIS MARGIN
DO NOT WRITE IN THIS MARGIN
DO NOT WRITE IN THIS MARGIN

GradeMax

(c) Find an expression for the acceleration of P in terms of t. [2]

(d) Find the acceleration when $t = 4.5$. [1]

DO NOT WRITE IN THIS MARGIN
DO NOT WRITE IN THIS MARGIN
DO NOT WRITE IN THIS MARGIN
DO NOT WRITE IN THIS MARGIN
DO NOT WRITE IN THIS MARGIN

GradeMax

10 The expansion of $(ax-2)^4\left(1+\frac{b}{x}\right)^3$ is written in descending powers of x.

The first 3 terms of this expansion are $81x^4+999x^3+cx^2$.
It is given that a, b and c are positive integers.

Find the values of a, b and c. [10]

DO NOT WRITE IN THIS MARGIN
DO NOT WRITE IN THIS MARGIN
DO NOT WRITE IN THIS MARGIN
DO NOT WRITE IN THIS MARGIN
DO NOT WRITE IN THIS MARGIN

GradeMax

Continuation of working space for Question 10.

DO NOT WRITE IN THIS MARGIN
DO NOT WRITE IN THIS MARGIN
DO NOT WRITE IN THIS MARGIN
DO NOT WRITE IN THIS MARGIN
DO NOT WRITE IN THIS MARGIN

Question 11 is printed on the next page.

GradeMax

11 Solve the equation $\cot(y+1.5)=3$ where y is in radians and $0<y<6$. [4]

DO NOT WRITE IN THIS MARGIN
DO NOT WRITE IN THIS MARGIN
DO NOT WRITE IN THIS MARGIN
DO NOT WRITE IN THIS MARGIN
DO NOT WRITE IN THIS MARGIN

Permission to reproduce items where third-party owned material protected by copyright is included has been sought and cleared where possible. Every reasonable effort has been made by the publisher (UCLES) to trace copyright holders, but if any items requiring clearance have unwittingly been included, the publisher will be pleased to make amends at the earliest possible opportunity.

To avoid the issue of disclosure of answer-related information to candidates, all copyright acknowledgements are reproduced online in the Cambridge Assessment International Education Copyright Acknowledgements Booklet. This is produced for each series of examinations and is freely available to download at www.cambridgeinternational.org after the live examination series.

Cambridge Assessment International Education is part of Cambridge Assessment. Cambridge Assessment is the brand name of the University of Cambridge Local Examinations Syndicate (UCLES), which is a department of the University of Cambridge.

© UCLES 2025