GradeMax

* 0000800000001 * DFD

CAMBRIDGE
International Education

Cambridge IGCSE™

CANDIDATE NAME

CENTRE NUMBER

CANDIDATE NUMBER

8930678237

ADDITIONAL MATHEMATICS **0606/22**

Paper 2 **February/March 2026**

2 hours

You must answer on the question paper.

No additional materials are needed.

INSTRUCTIONS

- Answer **all** questions.
- Use a black or dark blue pen. You may use an HB pencil for any diagrams or graphs.
- Write your name, centre number and candidate number in the boxes at the top of the page.
- Write your answer to each question in the space provided.
- Do **not** use an erasable pen. Do **not** use correction fluid or tape.
- Do **not** write on any bar codes.
- You should use a scientific calculator where appropriate.
- You must show all necessary working clearly.
- Give non-exact numerical answers correct to 3 significant figures, or 1 decimal place for angles in degrees, unless a different level of accuracy is specified in the question.
- For π, use either your calculator value or 3.142.

INFORMATION

- The total mark for this paper is 80.
- The number of marks for each question or part question is shown in brackets [ ].

PapaCambridge papacambridge.com

This document has **16** pages.

DC (DE/CB) 359464/1
© Cambridge University Press & Assessment 2026

[Turn over

GradeMax

List of formulas

Equation of a circle with centre (a, b) and radius r. $(x-a)^2+(y-b)^2=r^2$

Curved surface area, A, of cone of radius r, sloping edge l. $A=\pi rl$

Surface area, A, of sphere of radius r. $A=4\pi r^2$

Volume, V, of pyramid or cone, base area A, height h. $V=\frac{1}{3}Ah$

Volume, V, of sphere of radius r. $V=\frac{4}{3}\pi r^3$

Quadratic equation

For the equation $ax^2+bx+c=0$,

$$x=\frac{-b\pm\sqrt{b^2-4ac}}{2a}$$

Binomial theorem

$$(a+b)^n=a^n+\binom{n}{1}a^{n-1}b+\binom{n}{2}a^{n-2}b^2+\ldots+\binom{n}{r}a^{n-r}b^r+\ldots+b^n,$$

where n is a positive integer and $\binom{n}{r}=\frac{n!}{(n-r)!r!}$

Arithmetic series

$$u_n=a+(n-1)d$$
$$S_n=\frac{1}{2}n(a+l)=\frac{1}{2}n\{2a+(n-1)d\}$$

Geometric series

$$u_n=ar^{n-1}$$
$$S_n=\frac{a(1-r^n)}{1-r}\quad(r\neq 1)$$
$$S_\infty=\frac{a}{1-r}\quad(|r|<1)$$

Identities

$$\sin^2A+\cos^2A=1$$
$$\sec^2A=1+\tan^2A$$
$$\operatorname{cosec}^2A=1+\cot^2A$$

Formulas for ΔABC

$$\frac{a}{\sin A}=\frac{b}{\sin B}=\frac{c}{\sin C}$$
$$a^2=b^2+c^2-2bc\cos A$$
$$\Delta=\frac{1}{2}ab\sin C$$

© Cambridge University Press & Assessment 2026

DO NOT WRITE IN THIS MARGIN
DO NOT WRITE IN THIS MARGIN
DO NOT WRITE IN THIS MARGIN
DO NOT WRITE IN THIS MARGIN
DO NOT WRITE IN THIS MARGIN

GradeMax

1 The function f is defined by $f(x) = 2x^2 - 6x + 4$ for all real values of x.

(a) Write $f(x)$ in the form $a(x+b)^2 + c$ where a, b and c are constants. [3]

(b) Hence find the range of f. [1]

(c) The function g is defined by $g(x) = 2x^2 - 6x + 4$ for $x \leqslant k$, where k is a constant.

Given that g has an inverse, state the largest possible value of k. [1]

(d) The function h is defined by $h(x) = e^{3x} - 1$ for $x \leqslant 0$.

Given that $gh(x)$ exists, find $gh(x)$, simplifying your answer. [3]

DO NOT WRITE IN THIS MARGIN
DO NOT WRITE IN THIS MARGIN
DO NOT WRITE IN THIS MARGIN
DO NOT WRITE IN THIS MARGIN
DO NOT WRITE IN THIS MARGIN

© Cambridge University Press & Assessment 2026

GradeMax

2 Points A and B have coordinates $(1, 3)$ and $(-7, 1)$.
The point P with coordinates $(2, a)$ lies on the perpendicular bisector of AB.

(a) Find the value of a. [4]

(b) The point Q is the reflection of P in the line AB.

Find the coordinates of Q. [2]

DO NOT WRITE IN THIS MARGIN
DO NOT WRITE IN THIS MARGIN
DO NOT WRITE IN THIS MARGIN
DO NOT WRITE IN THIS MARGIN
DO NOT WRITE IN THIS MARGIN

© Cambridge University Press & Assessment 2026

GradeMax

3

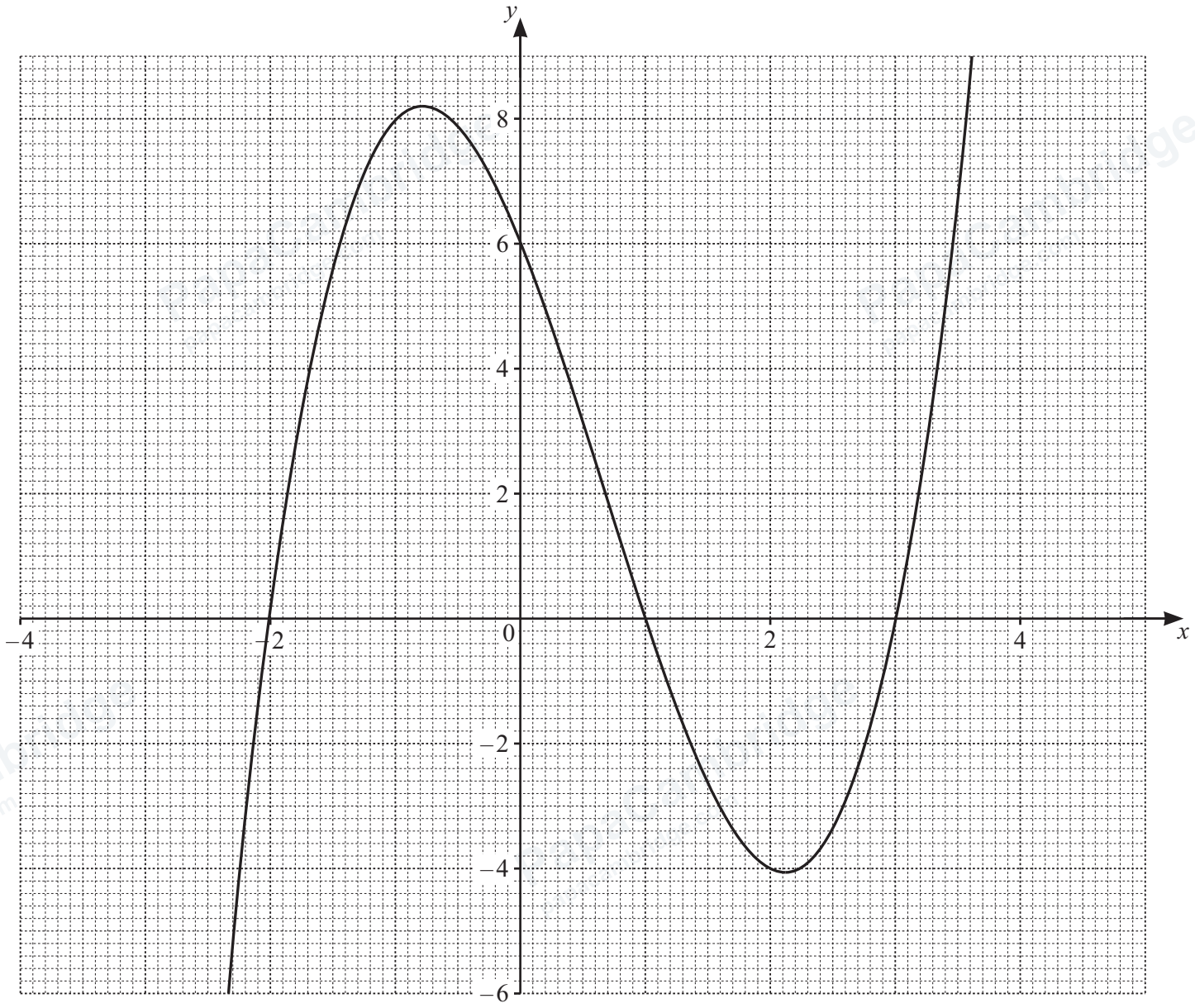

The diagram shows the graph of $y = (x+2)(x-1)(x-3)$.

By drawing a suitable line on the diagram, solve the inequality $(x+2)(x-1)(x-3) > 7$. [4]

DO NOT WRITE IN THIS MARGIN
DO NOT WRITE IN THIS MARGIN
DO NOT WRITE IN THIS MARGIN
DO NOT WRITE IN THIS MARGIN
DO NOT WRITE IN THIS MARGIN

PapaCambridge
papacambridge.com

GradeMax

4 **(a)** A 6-digit number is to be formed from the digits 1, 2, 3, 4, 5, 6, 7, 8, 9.
No digit may be used more than once in any 6-digit number.

Find how many 6-digit numbers can be formed in the following cases.

(i) There are no further restrictions. [1]

(ii) The 6-digit number includes the digit 4. [2]

(b) A class contains 10 girls and 12 boys.
A group of 6 students is to be selected from the class.
There must be at least 2 girls and at least 2 boys in the group.

Find the number of different selections that can be made. [3]

DO NOT WRITE IN THIS MARGIN
DO NOT WRITE IN THIS MARGIN
DO NOT WRITE IN THIS MARGIN
DO NOT WRITE IN THIS MARGIN
DO NOT WRITE IN THIS MARGIN

© Cambridge University Press & Assessment 2026

GradeMax

5 The diagram shows a design for a badge.

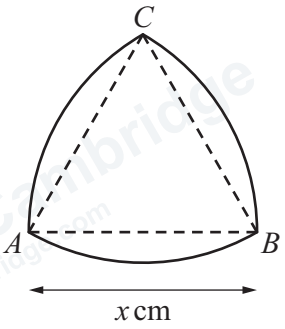

ABC is an equilateral triangle with side x cm.
The arcs *BC*, *CA* and *AB* are parts of the circles with centres *A*, *B* and *C* respectively.

(a) Write down the size of angle *ABC* in radians.
Give your answer in terms of π. [1]

(b) The area of the badge is $2(\pi - \sqrt{3})\ \text{cm}^2$.

Find x. [5]

DO NOT WRITE IN THIS MARGIN
DO NOT WRITE IN THIS MARGIN
DO NOT WRITE IN THIS MARGIN
DO NOT WRITE IN THIS MARGIN
DO NOT WRITE IN THIS MARGIN

© Cambridge University Press & Assessment 2026

GradeMax

6 **(a)** The diagram shows part of the graph of $y = 1 + \tan\frac{1}{2}x$ where x is measured in degrees.

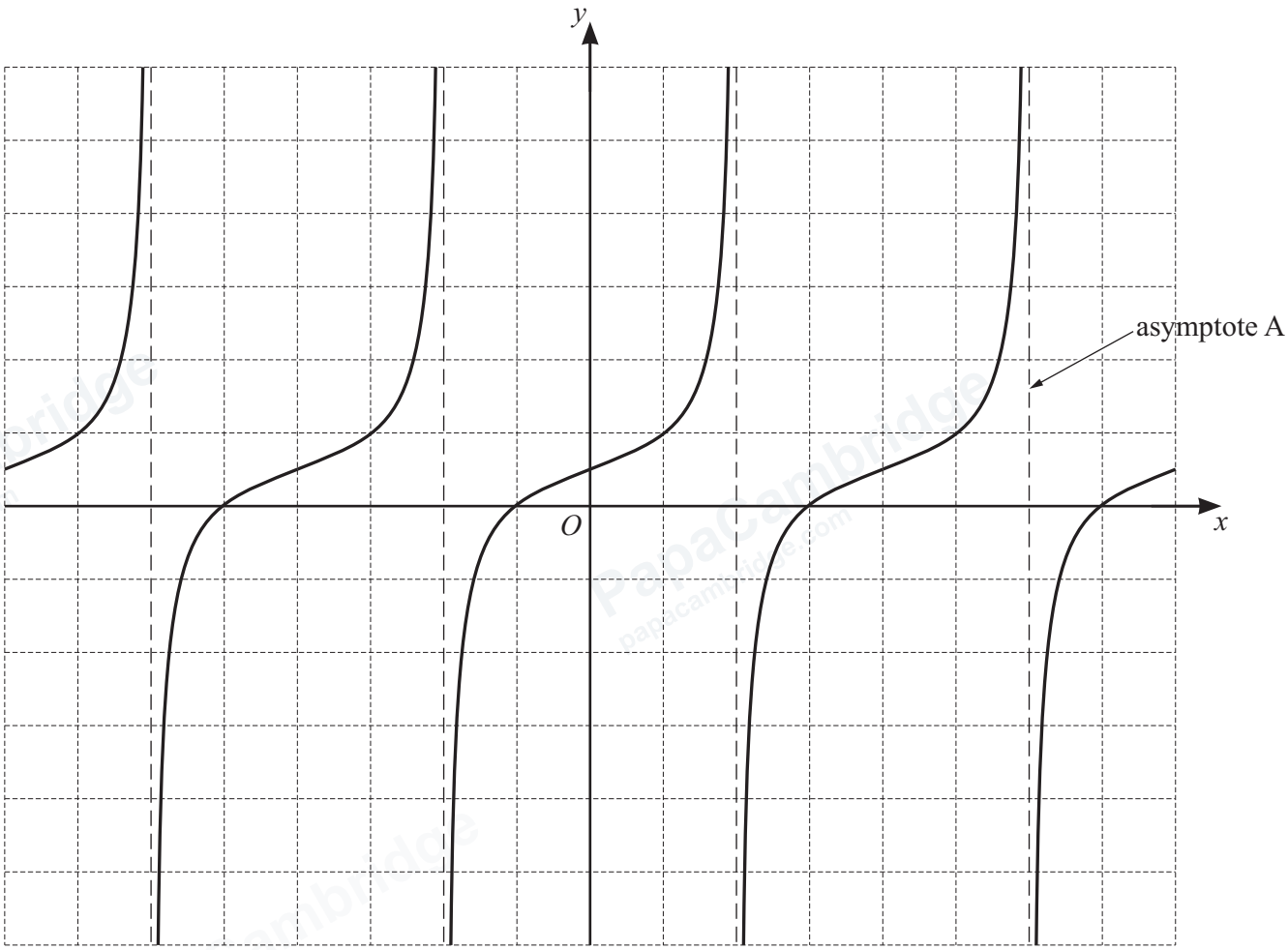

(i) Write down the period of $1 + \tan\frac{1}{2}x$. [1]

(ii) Write down the equation of the asymptote A. [1]

DO NOT WRITE IN THIS MARGIN
DO NOT WRITE IN THIS MARGIN
DO NOT WRITE IN THIS MARGIN
DO NOT WRITE IN THIS MARGIN
DO NOT WRITE IN THIS MARGIN

© Cambridge University Press & Assessment 2026

GradeMax

(b) On the axes below, sketch the graph of $y = 3\cos 2x + 1$ for $-180° \leqslant x \leqslant 180°$. [3]

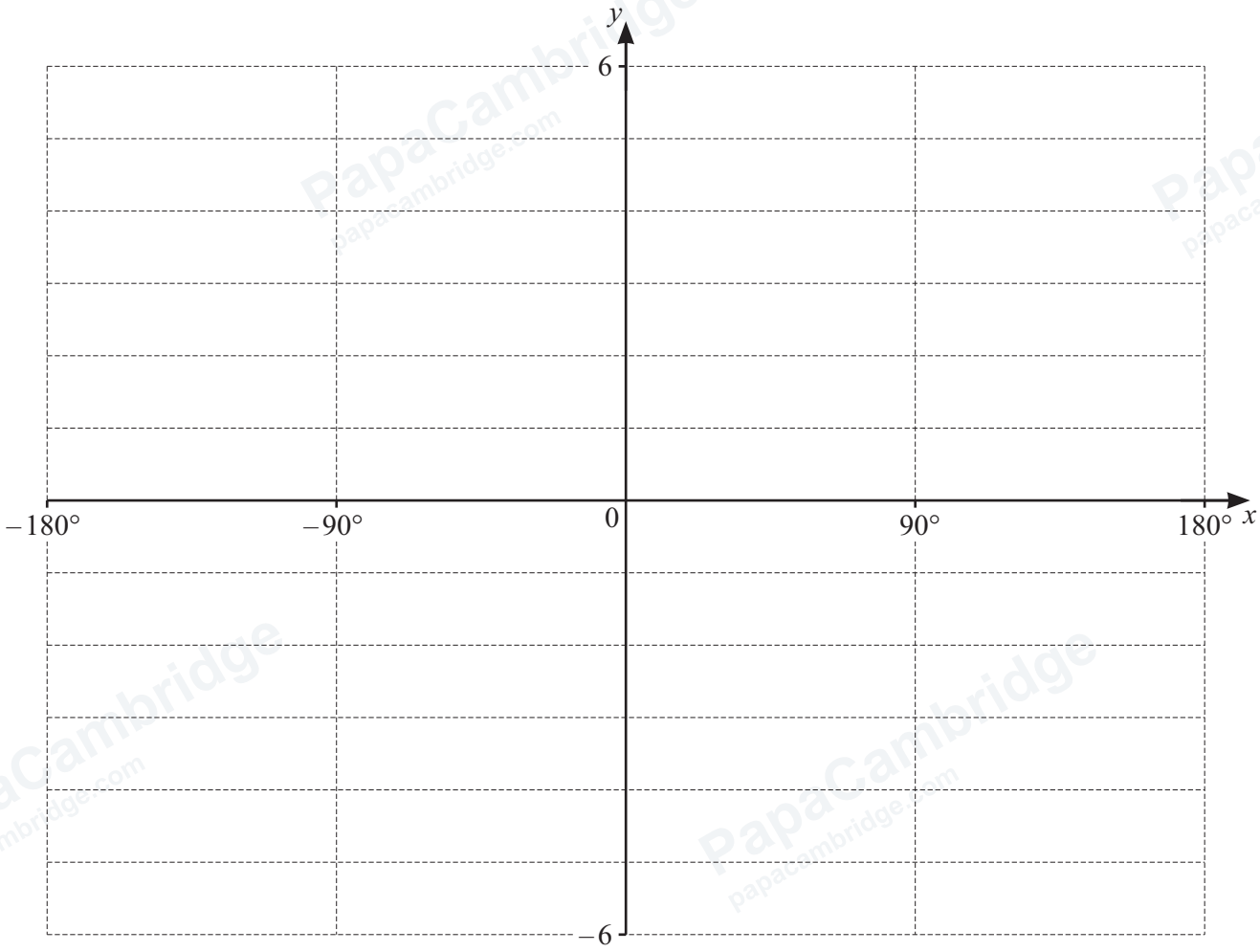

DO NOT WRITE IN THIS MARGIN
DO NOT WRITE IN THIS MARGIN
DO NOT WRITE IN THIS MARGIN
DO NOT WRITE IN THIS MARGIN
DO NOT WRITE IN THIS MARGIN

PapaCambridge
papacambridge.com

GradeMax

7 A ship is sailing with speed v kmh^{-1}.
The sailing cost per hour, \$$C$, is given by $C = v^2 + \frac{3000}{v} + 100$.

(a) Find the speed that makes C a minimum.
Justify that this value of C is a minimum. [5]

(b) Hence find the minimum sailing cost for a journey of 150 km. [3]

DO NOT WRITE IN THIS MARGIN
DO NOT WRITE IN THIS MARGIN
DO NOT WRITE IN THIS MARGIN
DO NOT WRITE IN THIS MARGIN
DO NOT WRITE IN THIS MARGIN

© Cambridge University Press & Assessment 2026

GradeMax

8 A circle has centre $(-2, 0)$ and radius 5.
A line has equation $y = 2x + k$, where k is a constant.
The line does **not** meet the circle.

Find the set of possible values of k. [8]

DO NOT WRITE IN THIS MARGIN
DO NOT WRITE IN THIS MARGIN
DO NOT WRITE IN THIS MARGIN
DO NOT WRITE IN THIS MARGIN
DO NOT WRITE IN THIS MARGIN

PapaCambridge papacambridge.com

9 **(a)** Show that $\tan\theta + \cot\theta + 2\sec\theta$ can be written as $\dfrac{1+2\sin\theta}{\sin\theta\cos\theta}$. [3]

(b) Hence solve the equation $\tan 2x + \cot 2x + 2\sec 2x = 0$ for $-180° \leqslant x \leqslant 180°$. [4]

DO NOT WRITE IN THIS MARGIN
DO NOT WRITE IN THIS MARGIN
DO NOT WRITE IN THIS MARGIN
DO NOT WRITE IN THIS MARGIN
DO NOT WRITE IN THIS MARGIN

PapaCambridge papacambridge.com

© Cambridge University Press & Assessment 2026

GradeMax

(c) Solve the equation $3\sec(x-1)-1=\tan^2(x-1)$ where x is in radians and $-1<x<3$. [5]

DO NOT WRITE IN THIS MARGIN
DO NOT WRITE IN THIS MARGIN
DO NOT WRITE IN THIS MARGIN
DO NOT WRITE IN THIS MARGIN
DO NOT WRITE IN THIS MARGIN

GradeMax

10 In this question time t is in seconds and displacement s is in metres.

For $t \geqslant 0$, a particle moves on the positive x-axis.
At time t the acceleration of the particle is $2t - 9$.
At time $t = 7$ the velocity of the particle is 4.

(a) Find the times when the velocity of the particle is 0. [4]

(b) At time $t = 12$, the displacement of the particle from the origin O is 150.

(i) Find an expression for the displacement of the particle at time t. [3]

DO NOT WRITE IN THIS MARGIN
DO NOT WRITE IN THIS MARGIN
DO NOT WRITE IN THIS MARGIN
DO NOT WRITE IN THIS MARGIN
DO NOT WRITE IN THIS MARGIN

© Cambridge University Press & Assessment 2026

GradeMax

(ii) Find the distance travelled by the particle in the first 6 seconds. [3]

DO NOT WRITE IN THIS MARGIN
DO NOT WRITE IN THIS MARGIN
DO NOT WRITE IN THIS MARGIN
DO NOT WRITE IN THIS MARGIN
DO NOT WRITE IN THIS MARGIN

Question 11 is on the back page.

GradeMax

11 **(a)** Find, in descending powers of x, the first three terms in the expansion of $(x^2 + \frac{1}{2x})^9$.
Give each term in its simplest form. [3]

(b) The expansion of $(x^2 + \frac{1}{2x})^n$, where n is a positive integer, has a term that is independent of x.
Show that n is divisible by 3. [4]

DO NOT WRITE IN THIS MARGIN
DO NOT WRITE IN THIS MARGIN
DO NOT WRITE IN THIS MARGIN
DO NOT WRITE IN THIS MARGIN
DO NOT WRITE IN THIS MARGIN

Permission to reproduce items where third-party owned material protected by copyright is included has been sought and cleared where possible. Every reasonable effort has been made by the publisher (Cambridge University Press & Assessment) to trace copyright holders, but if any items requiring clearance have unwittingly been included, the publisher will be pleased to make amends at the earliest possible opportunity.

To avoid the issue of disclosure of answer-related information to candidates, all copyright acknowledgements are reproduced online in our Copyright Acknowledgements Booklet. This is produced for each series of examinations and is freely available to download at www.cambridgeinternational.org after the live examination series.

Cambridge International Education is the name of our awarding body and a part of Cambridge University Press & Assessment, which is a department of the University of Cambridge.

© Cambridge University Press & Assessment 2026