GradeMax

* 0000800000001 * DFD

CAMBRIDGE
International Education

Cambridge IGCSE™

CANDIDATE NAME

CENTRE NUMBER

CANDIDATE NUMBER

0483747910

BIOLOGY **0610/43**

Paper 4 Theory (Extended) **May/June 2026**

1 hour 15 minutes

You must answer on the question paper.

No additional materials are needed.

INSTRUCTIONS

- Answer **all** questions.
- Use a black or dark blue pen. You may use an HB pencil for any diagrams or graphs.
- Write your name, centre number and candidate number in the boxes at the top of the page.
- Write your answer to each question in the space provided.
- Do **not** use an erasable pen. Do **not** use correction fluid or tape.
- Do **not** write on any bar codes.
- You may use a calculator.
- You should show all your working and use appropriate units.

INFORMATION

- The total mark for this paper is 80.
- The number of marks for each question or part question is shown in brackets [ ].

This document has **24** pages. Any blank pages are indicated.

DC (WW/TC) 357935/5
© Cambridge University Press & Assessment 2026

[Turn over

GradeMax

BLANK PAGE

DO NOT WRITE IN THIS MARGIN
DO NOT WRITE IN THIS MARGIN
DO NOT WRITE IN THIS MARGIN
DO NOT WRITE IN THIS MARGIN
DO NOT WRITE IN THIS MARGIN

© Cambridge University Press & Assessment 2026

GradeMax

1 **(a)** Figure 1.1 shows the five kingdoms of living organisms.

(i) Complete Figure 1.1 by naming the missing kingdoms.

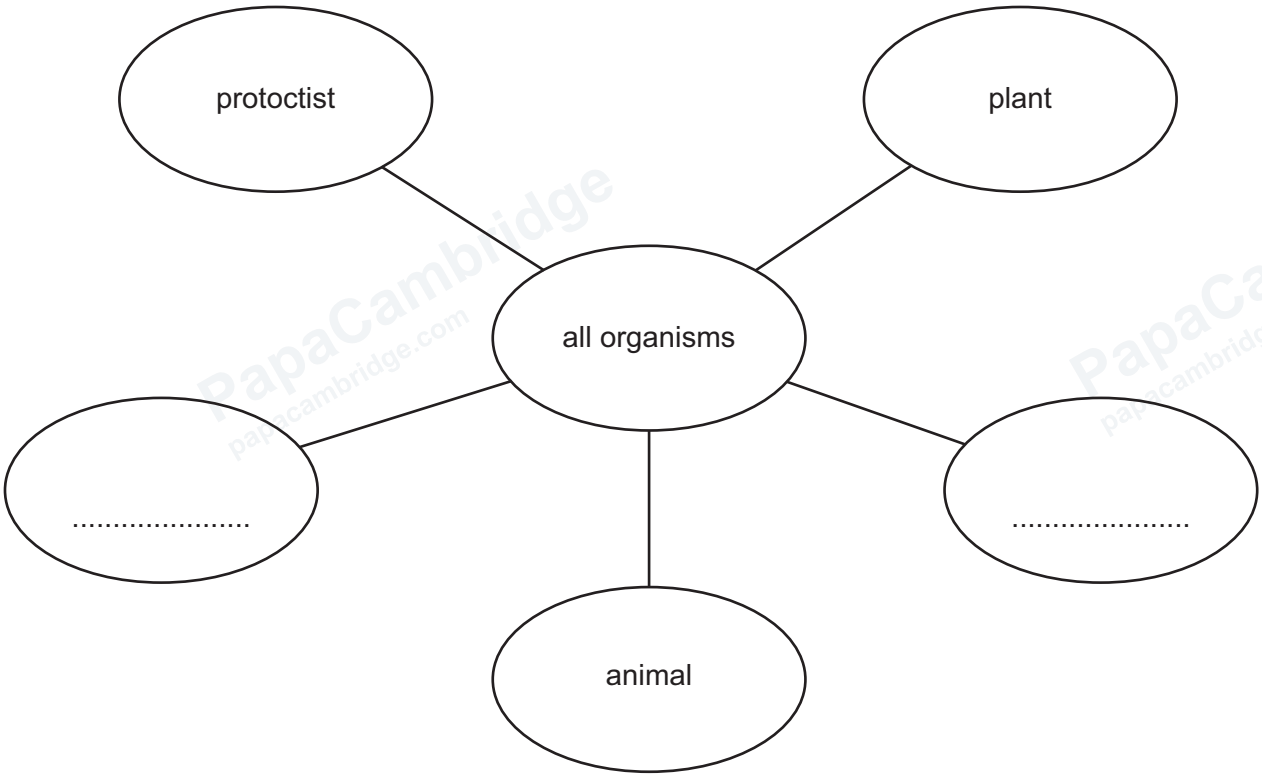

Figure 1.1

[2]

(ii) State the names of **two** cell structures that are found in both plant and animal cells.

1 .....

2 .....

[2]

DO NOT WRITE IN THIS MARGIN
DO NOT WRITE IN THIS MARGIN
DO NOT WRITE IN THIS MARGIN
DO NOT WRITE IN THIS MARGIN
DO NOT WRITE IN THIS MARGIN

© Cambridge University Press & Assessment 2026

GradeMax

(b) Figure 1.2 is a diagram of a single-celled protoctist called *Euglena*.

Euglena can act as a producer and as a consumer.

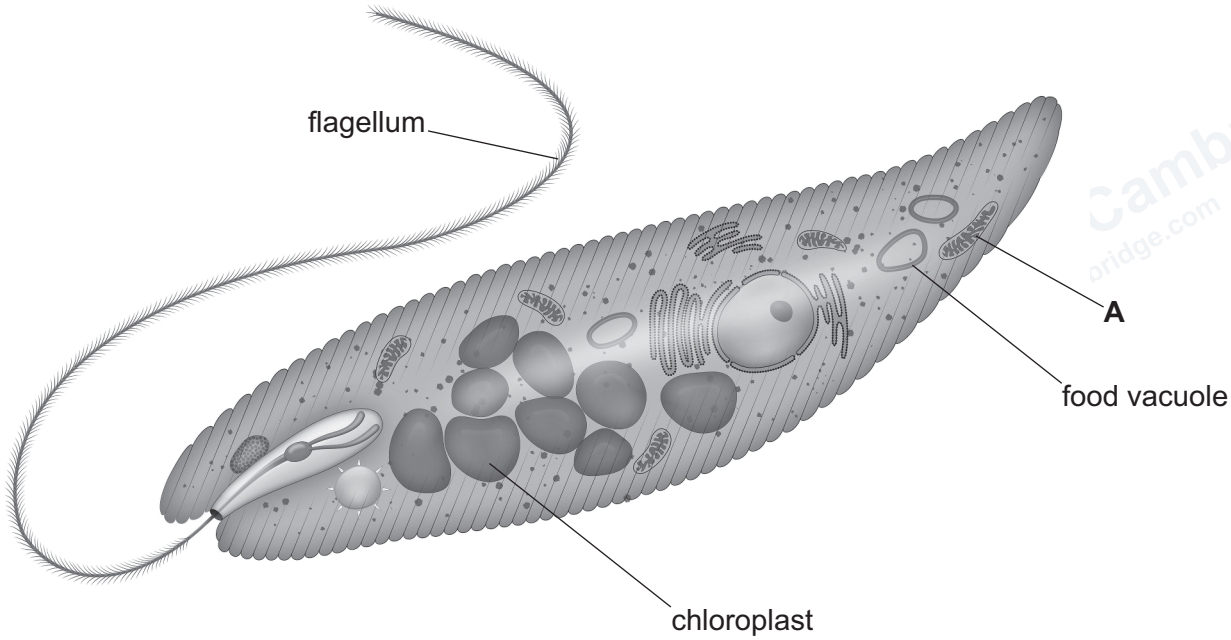

Figure 1.2

(i) State the evidence shown in Figure 1.2, that *Euglena* are producers.

.....

.....

..... [1]

(ii) Suggest the advantages to this organism of being a producer and a consumer.

.....

.....

.....

.....

..... [2]

(iii) State the function of the structure labelled **A** in Figure 1.2.

.....

..... [1]

DO NOT WRITE IN THIS MARGIN
DO NOT WRITE IN THIS MARGIN
DO NOT WRITE IN THIS MARGIN
DO NOT WRITE IN THIS MARGIN
DO NOT WRITE IN THIS MARGIN

© Cambridge University Press & Assessment 2026

GradeMax

DO NOT WRITE IN THIS MARGIN
DO NOT WRITE IN THIS MARGIN
DO NOT WRITE IN THIS MARGIN
DO NOT WRITE IN THIS MARGIN
DO NOT WRITE IN THIS MARGIN

(iv) The protoctist in Figure 1.2 takes up magnesium ions from its surroundings.

Suggest **one** use of the magnesium ions.

..... [1]

(v) The protoctist in Figure 1.2 has specialised structures that detect light.

Suggest which characteristic of living organisms is provided by the structures that detect light.

..... [1]

(c) State the name of a human cell that has a flagellum **and** describe the function of the flagellum.

human cell .....

function .....

.....

[2]

[Total: 12]

2 **(a)** Metabolism produces waste substances that are excreted.

Complete Table 2.1 about the excretion of substances.

Table 2.1

substance	process that produces the substance	organ that excretes the substance
carbon dioxide	.....	.....
.....	photosynthesis	.....

[2]

© Cambridge University Press & Assessment 2026

GradeMax

(b) Figure 2.1 shows the movement of nitrogen-containing substances through the human body.

key

substance

organ

direction of movement

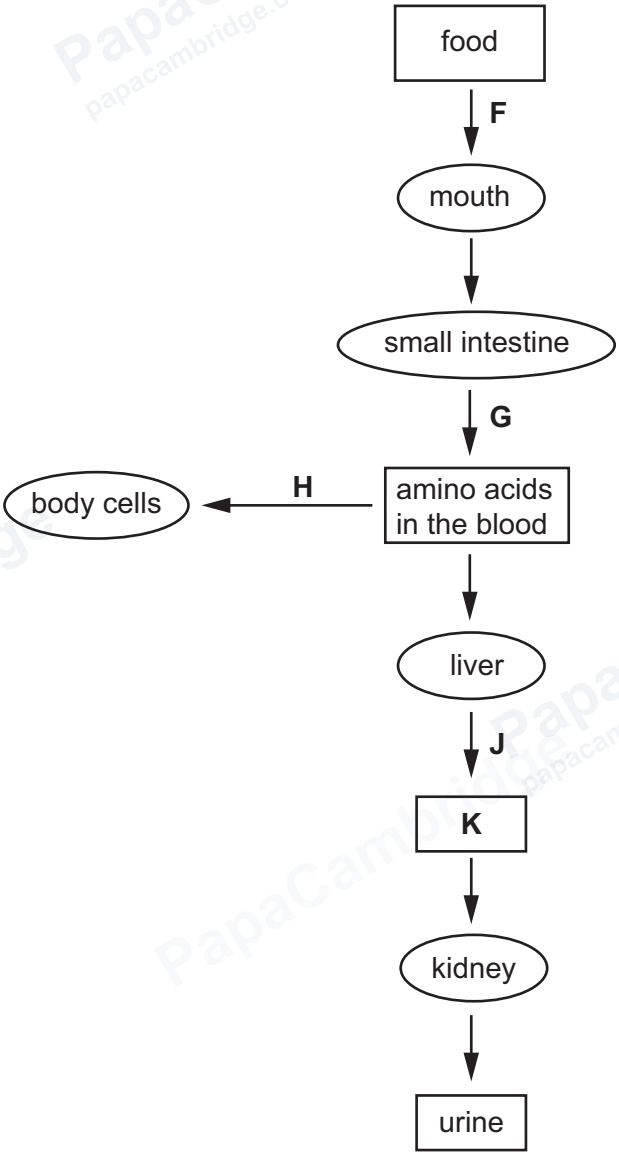

Figure 2.1

DO NOT WRITE IN THIS MARGIN
DO NOT WRITE IN THIS MARGIN
DO NOT WRITE IN THIS MARGIN
DO NOT WRITE IN THIS MARGIN
DO NOT WRITE IN THIS MARGIN

© Cambridge University Press & Assessment 2026

GradeMax

(i) Identify the processes occurring at **F**, **G**, **H** and **J** in Figure 2.1.

F .....

G .....

H .....

J .....

[4]

(ii) State the name of substance **K** in Figure 2.1.

..... [1]

DO NOT WRITE IN THIS MARGIN
DO NOT WRITE IN THIS MARGIN
DO NOT WRITE IN THIS MARGIN
DO NOT WRITE IN THIS MARGIN
DO NOT WRITE IN THIS MARGIN

© Cambridge University Press & Assessment 2026

(c) Figure 2.2 is a diagram of a nephron from a human kidney and its associated blood vessels.

The arrows show the direction of blood flow.

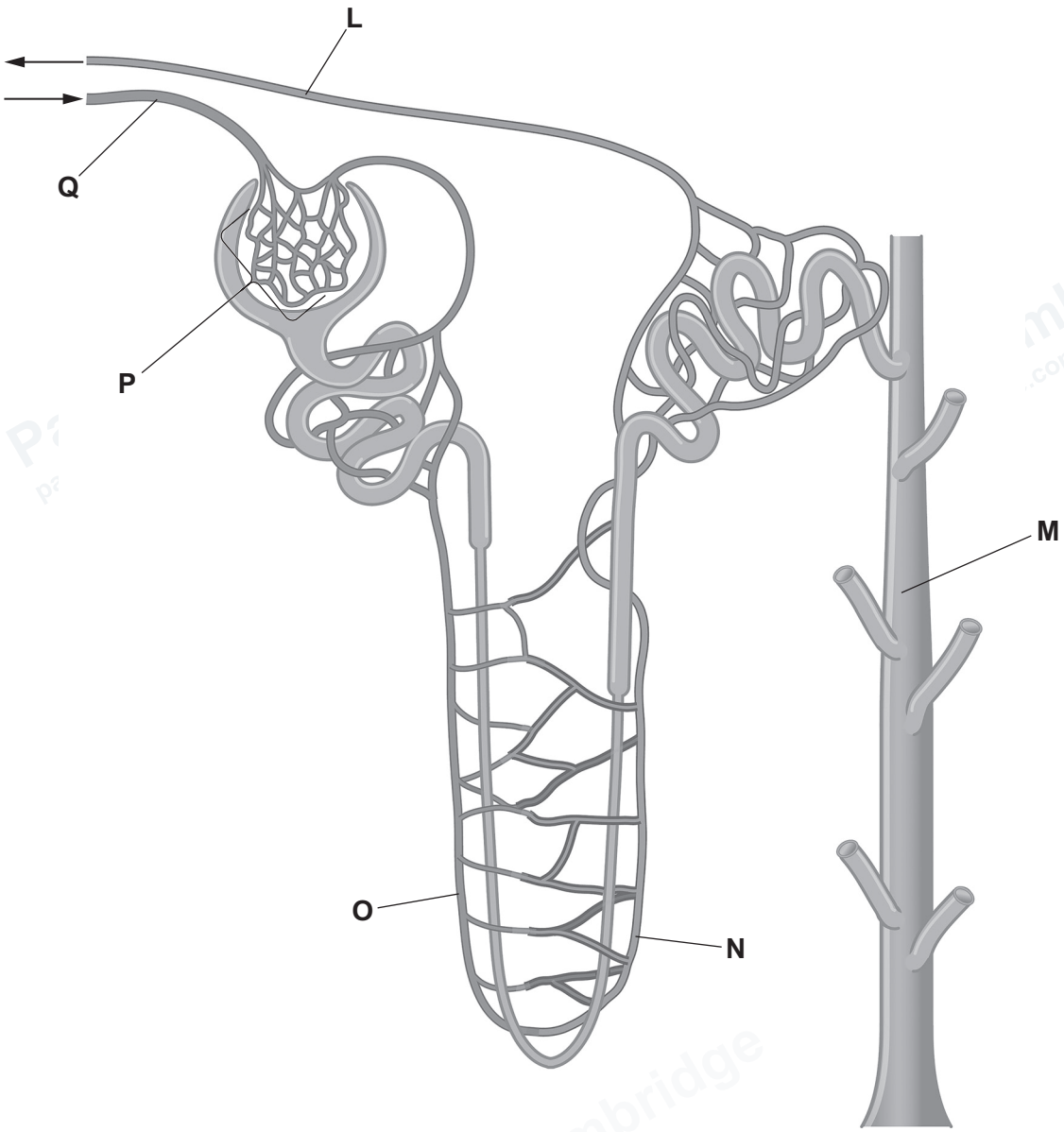

Figure 2.2

(i) State the letter in Figure 2.2 that identifies the glomerulus **and** describe its function.

letter .....

function .....

.....

[2]

DO NOT WRITE IN THIS MARGIN
DO NOT WRITE IN THIS MARGIN
DO NOT WRITE IN THIS MARGIN
DO NOT WRITE IN THIS MARGIN
DO NOT WRITE IN THIS MARGIN

© Cambridge University Press & Assessment 2026

GradeMax

(ii) The oxygen concentrations of the blood in blood vessel **Q** and blood vessel **L** are different.

State **and** explain the difference in oxygen concentration between blood vessel **Q** and blood vessel **L**.

.....

.....

.....

.....

.....

.....

.....

.....

..... [4]

[Total: 13]

DO NOT WRITE IN THIS MARGIN
DO NOT WRITE IN THIS MARGIN
DO NOT WRITE IN THIS MARGIN
DO NOT WRITE IN THIS MARGIN
DO NOT WRITE IN THIS MARGIN

© Cambridge University Press & Assessment 2026

GradeMax

3 Figure 3.1 shows the thickness of the uterus lining during one menstrual cycle.

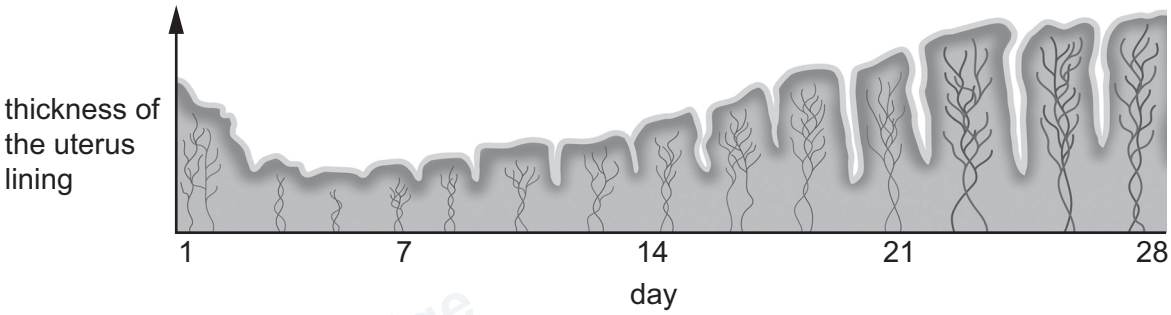

Figure 3.1

(a) Explain how oestrogen and progesterone are involved in the changes shown in Figure 3.1.

.....

.....

.....

.....

.....

.....

.....

.....

.....

..... [4]

(b) Complete the sentences about egg cells by writing words or phrases in the gaps.

The egg cell is the female ..... .

Egg cells form when a cell divides by the process of ..... .

Egg cells have ..... features such as a jelly coat

and ..... .

The nucleus of an egg cell contains a single set of chromosomes and is therefore described

as a ..... nucleus.

[5]

DO NOT WRITE IN THIS MARGIN

© Cambridge University Press & Assessment 2026

GradeMax

(c) If pregnancy occurs, a placenta will form.

Describe **two** functions of the placenta.

1 .....

.....

2 .....

.....

[2]

(d) FSH and LH are two of the hormones that regulate the menstrual cycle.

State the roles of FSH and LH.

FSH .....

.....

LH .....

.....

[2]

(e) State **two** effects of testosterone during puberty in human males.

1 .....

.....

2 .....

.....

[2]

(f) State the name of the component of blood that transports hormones.

..... [1]

[Total: 16]

DO NOT WRITE IN THIS MARGIN
DO NOT WRITE IN THIS MARGIN
DO NOT WRITE IN THIS MARGIN
DO NOT WRITE IN THIS MARGIN
DO NOT WRITE IN THIS MARGIN

PapaCambridge papacambridge.com

GradeMax

4 **(a)** Figure 4.1 shows a cross between a chicken that is pure-breeding for white feathers and a chicken that is pure-breeding for black feathers. All of the offspring have black and white feathers that are described as speckled.



Figure 4.1

The allele for white feathers is represented by $\mathbf{F^W}$.

The allele for black feathers is represented by $\mathbf{F^B}$.

The genotype of all of the speckled chicken offspring is $\mathbf{F^W F^B}$.

(i) State the term that is used to describe the situation where both alleles in heterozygous organisms contribute to the phenotype.

..... [1]

DO NOT WRITE IN THIS MARGIN
DO NOT WRITE IN THIS MARGIN
DO NOT WRITE IN THIS MARGIN
DO NOT WRITE IN THIS MARGIN
DO NOT WRITE IN THIS MARGIN

© Cambridge University Press & Assessment 2026

GradeMax

(ii) Two of the speckled chicken offspring were bred together.

Complete the Punnett square to determine the genotypes and phenotypic ratio of the offspring from this cross.

		male speckled chicken	
		.....	.....
female speckled chicken	.....	.....	.....
	.....	.....	.....

The phenotypic ratio of the offspring is:

.....
[3]

(b) Chickens can be farmed intensively.

Describe **two** disadvantages of intensive livestock production.

1 .....

.....

2 .....

.....
[2]

DO NOT WRITE IN THIS MARGIN
DO NOT WRITE IN THIS MARGIN
DO NOT WRITE IN THIS MARGIN
DO NOT WRITE IN THIS MARGIN
DO NOT WRITE IN THIS MARGIN

© Cambridge University Press & Assessment 2026

GradeMax

(c) DNA controls cell function by controlling the production of proteins.

Explain how a protein is made.

.....

.....

.....

.....

.....

.....

.....

.....

.....

.....

.....

..... [6]

[Total: 12]

DO NOT WRITE IN THIS MARGIN

DO NOT WRITE IN THIS MARGIN

DO NOT WRITE IN THIS MARGIN

DO NOT WRITE IN THIS MARGIN

DO NOT WRITE IN THIS MARGIN

© Cambridge University Press & Assessment 2026

GradeMax

DO NOT WRITE IN THIS MARGIN
DO NOT WRITE IN THIS MARGIN
DO NOT WRITE IN THIS MARGIN
DO NOT WRITE IN THIS MARGIN
DO NOT WRITE IN THIS MARGIN

Turn over

© Cambridge University Press & Assessment 2026

GradeMax

5 Figure 5.1 shows a food web from a marine ecosystem.

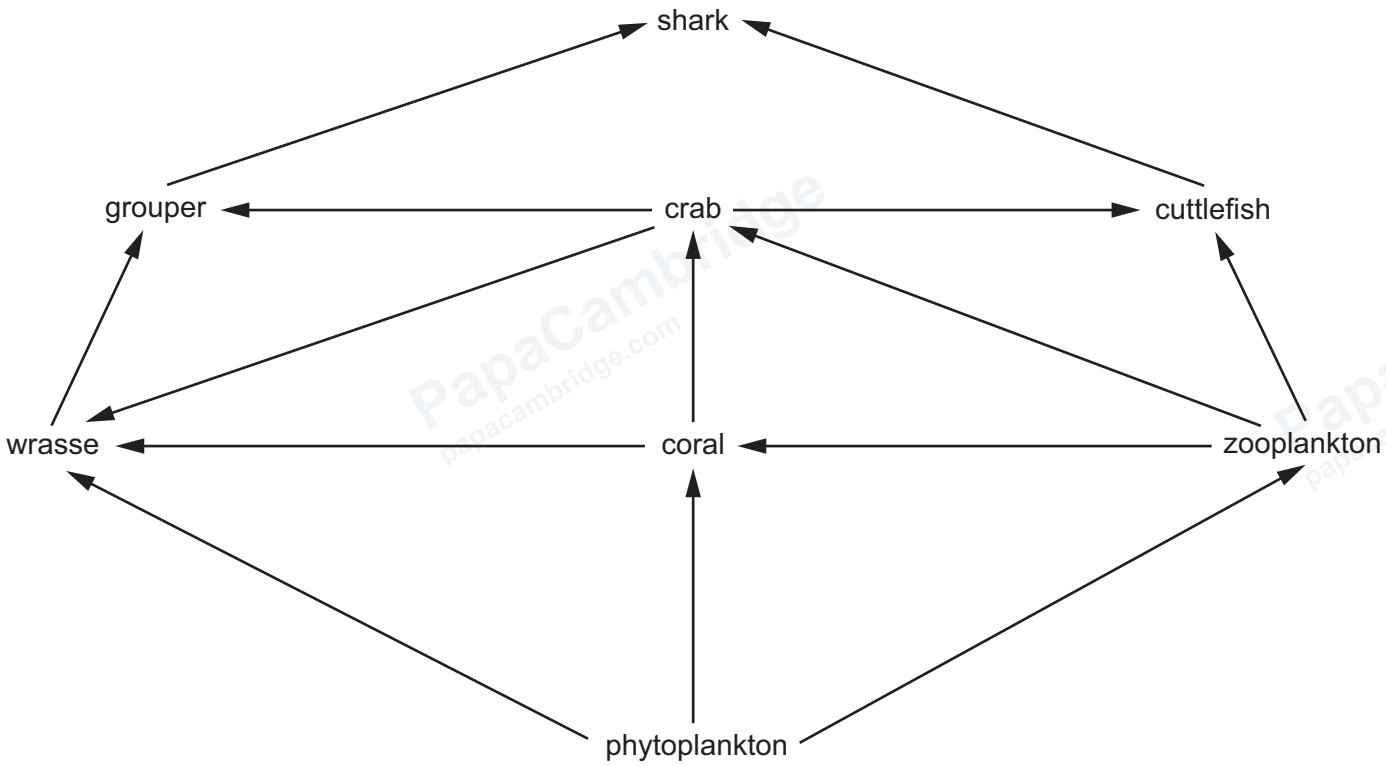

Figure 5.1

(a) Using Figure 5.1, identify:

an organism that **only** feeds as a secondary consumer

.....

an organism that consumes at three different trophic levels

.....

all of the quaternary consumers.

.....

[3]

DO NOT WRITE IN THIS MARGIN
DO NOT WRITE IN THIS MARGIN
DO NOT WRITE IN THIS MARGIN
DO NOT WRITE IN THIS MARGIN
DO NOT WRITE IN THIS MARGIN

© Cambridge University Press & Assessment 2026

GradeMax

(b) Figure 5.2 shows a food chain.

phytoplankton ⟶ zooplankton ⟶ cuttlefish

Figure 5.2

Table 5.1 shows the energy in the organisms shown in Figure 5.2.

Table 5.1

organism	energy / arbitrary units
phytoplankton	960
zooplankton	120
cuttlefish	10

(i) Use the information in Figure 5.2 and Table 5.1 to construct a pyramid of energy on the grid.

Label each trophic level.



[3]

(ii) State **one** reason for using a pyramid of energy rather than a pyramid of biomass.

.....

.....

..... [1]

DO NOT WRITE IN THIS MARGIN
DO NOT WRITE IN THIS MARGIN
DO NOT WRITE IN THIS MARGIN
DO NOT WRITE IN THIS MARGIN
DO NOT WRITE IN THIS MARGIN

© Cambridge University Press & Assessment 2026

(c) Phytoplankton are aquatic producers.

Scientists investigated the factors that affect their rate of population growth. A sample of phytoplankton was grown in a container with conditions similar to those found in the wild.

The phytoplankton were provided with constant light.

The population of phytoplankton was measured as the number of organisms per cm^3.

Figure 5.3 shows the results of the investigation.

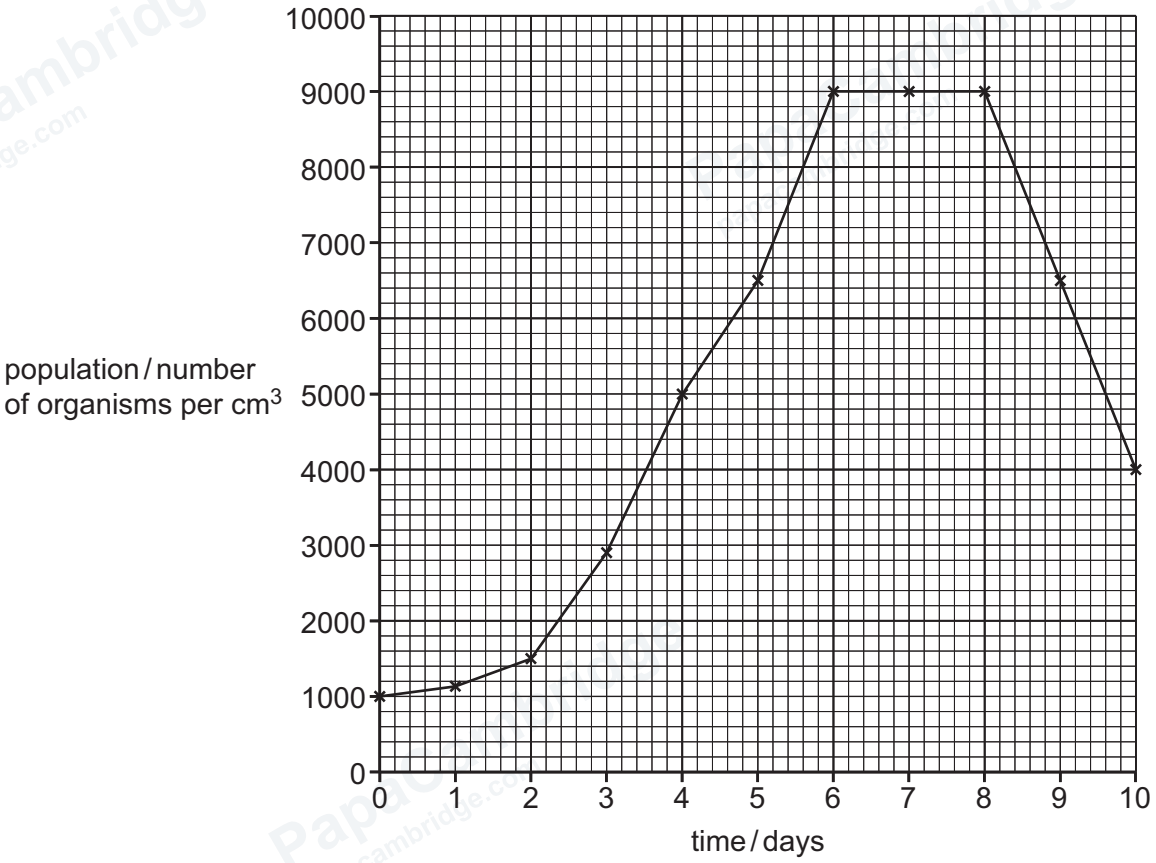

Figure 5.3

(i) Using Figure 5.3, calculate the population of phytoplankton in 0.5 dm^3 on day 4.

Give your answer in standard form.

Space for working.

..... [3]

© Cambridge University Press & Assessment 2026

GradeMax

DO NOT WRITE IN THIS MARGIN

DO NOT WRITE IN THIS MARGIN

DO NOT WRITE IN THIS MARGIN

DO NOT WRITE IN THIS MARGIN

DO NOT WRITE IN THIS MARGIN

GradeMax

(ii) Identify **and** explain the phases of growth shown by the phytoplankton in Figure 5.3.

.....

.....

.....

.....

.....

.....

.....

.....

.....

..... [5]

[Total: 15]

DO NOT WRITE IN THIS MARGIN
DO NOT WRITE IN THIS MARGIN
DO NOT WRITE IN THIS MARGIN
DO NOT WRITE IN THIS MARGIN
DO NOT WRITE IN THIS MARGIN

6 **(a)** Lipase is an enzyme found in the human digestive system.

Complete the word equation to show the substrate and products for a reaction catalysed by lipase.

..... → fatty acids + ...

[2]

(b) There are different types of lipase.

Figure 6.1 shows the effect of pH on the enzyme activity of two types of lipase, type **P** and type **Q**.

key

type **P** lipase

type **Q** lipase

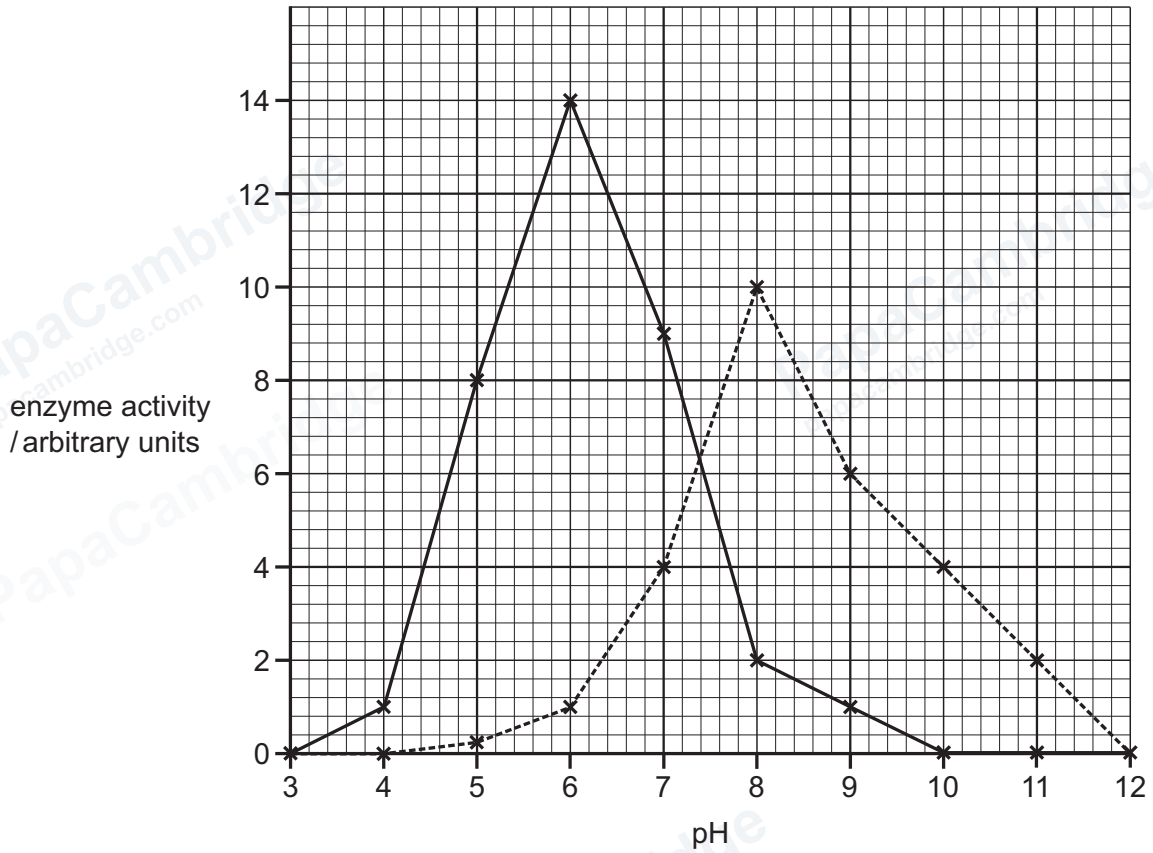

Figure 6.1

DO NOT WRITE IN THIS MARGIN
DO NOT WRITE IN THIS MARGIN
DO NOT WRITE IN THIS MARGIN
DO NOT WRITE IN THIS MARGIN
DO NOT WRITE IN THIS MARGIN

© Cambridge University Press & Assessment 2026

GradeMax

(i) Describe **two** similarities and **two** differences between the effect of pH on the enzyme activity of type **P** lipase and type **Q** lipase.

similarity 1 .....

.....

similarity 2 .....

.....

difference 1 .....

.....

difference 2 .....

..... [4]

(ii) Using Figure 6.1, identify the pH values where type **Q** lipase has 50% of its maximum activity.

..... and ..... [1]

(iii) Explain the effect of pH on the enzyme activity of type **P** lipase shown in Figure 6.1.

.....

.....

.....

.....

.....

.....

..... [3]

(c) In the small intestine, bile provides a suitable pH for type **Q** lipase.

(i) State **one** other function of bile.

.....

..... [1]

(ii) State the name of the organ that produces bile.

..... [1]

[Total: 12]

© Cambridge University Press & Assessment 2026

DO NOT WRITE IN THIS MARGIN DO NOT WRITE IN THIS MARGIN DO NOT WRITE IN THIS MARGIN DO NOT WRITE IN THIS MARGIN DO NOT WRITE IN THIS MARGIN

GradeMax

BLANK PAGE

DO NOT WRITE IN THIS MARGIN
DO NOT WRITE IN THIS MARGIN
DO NOT WRITE IN THIS MARGIN
DO NOT WRITE IN THIS MARGIN
DO NOT WRITE IN THIS MARGIN

© Cambridge University Press & Assessment 2026

GradeMax

BLANK PAGE

DO NOT WRITE IN THIS MARGIN
DO NOT WRITE IN THIS MARGIN
DO NOT WRITE IN THIS MARGIN
DO NOT WRITE IN THIS MARGIN
DO NOT WRITE IN THIS MARGIN

© Cambridge University Press & Assessment 2026

GradeMax

BLANK PAGE

DO NOT WRITE IN THIS MARGIN
DO NOT WRITE IN THIS MARGIN
DO NOT WRITE IN THIS MARGIN
DO NOT WRITE IN THIS MARGIN
DO NOT WRITE IN THIS MARGIN

Permission to reproduce items where third-party owned material protected by copyright is included has been sought and cleared where possible. Every reasonable effort has been made by the publisher (Cambridge University Press & Assessment) to trace copyright holders, but if any items requiring clearance have unwittingly been included, the publisher will be pleased to make amends at the earliest possible opportunity.

To avoid the issue of disclosure of answer-related information to candidates, all copyright acknowledgements are reproduced online in our Copyright Acknowledgements Booklet. This is produced for each series of examinations and is freely available to download at www.cambridgeinternational.org after the live examination series.

Cambridge International Education is the name of our awarding body and a part of Cambridge University Press & Assessment, which is a department of the University of Cambridge.

© Cambridge University Press & Assessment 2026