GradeMax

* 0000800000001 *

Cambridge Assessment International Education

Cambridge IGCSE™

CANDIDATE NAME

CENTRE NUMBER

CANDIDATE NUMBER

* 6 8 4 9 4 4 0 6 3 8 *

CAMBRIDGE INTERNATIONAL MATHEMATICS **0607/22**

Paper 2 Non-calculator (Extended) **February/March 2025**

1 hour 30 minutes

You must answer on the question paper.

You will need: Geometrical instruments

INSTRUCTIONS

- Answer **all** questions.
- Use a black or dark blue pen. You may use an HB pencil for any diagrams or graphs.
- Write your name, centre number and candidate number in the boxes at the top of the page.
- Write your answer to each question in the space provided.
- Do **not** use an erasable pen or correction fluid.
- Do **not** write on any bar codes.
- Calculators must **not** be used in this paper.
- You may use tracing paper.
- You must show all necessary working clearly. You will be given marks for correct methods even if your answer is incorrect.

INFORMATION

- The total mark for this paper is 75.
- The number of marks for each question or part question is shown in brackets [ ].

This document has **16** pages. Any blank pages are indicated.

DC (SL/CGW) 342556/2

© UCLES 2025

[Turn over

GradeMax

List of formulas

Area, A, of triangle, base b, height h.	$A = \frac{1}{2}bh$
Area, A, of circle of radius r.	$A = \pi r^2$
Circumference, C, of circle of radius r.	$C = 2\pi r$
Curved surface area, A, of cylinder of radius r, height h.	$A = 2\pi rh$
Curved surface area, A, of cone of radius r, sloping edge l.	$A = \pi rl$
Surface area, A, of sphere of radius r.	$A = 4\pi r^2$
Volume, V, of prism, cross-sectional area A, length l.	$V = Al$
Volume, V, of pyramid, base area A, height h.	$V = \frac{1}{3}Ah$
Volume, V, of cylinder of radius r, height h.	$V = \pi r^2 h$
Volume, V, of cone of radius r, height h.	$V = \frac{1}{3}\pi r^2 h$
Volume, V, of sphere of radius r.	$V = \frac{4}{3}\pi r^3$
For the equation $ax^2 + bx + c = 0$, where $a \neq 0$,	$x = \frac{-b \pm \sqrt{b^2 - 4ac}}{2a}$

For the triangle shown,

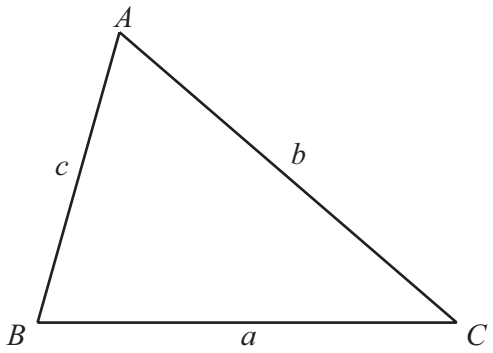

$$\frac{a}{\sin A} = \frac{b}{\sin B} = \frac{c}{\sin C}$$

$$a^2 = b^2 + c^2 - 2bc\cos A$$

$$\text{Area} = \frac{1}{2}ab\sin C$$

DO NOT WRITE IN THIS MARGIN
DO NOT WRITE IN THIS MARGIN
DO NOT WRITE IN THIS MARGIN
DO NOT WRITE IN THIS MARGIN
DO NOT WRITE IN THIS MARGIN

* 0000800000003 *

Calculators must **not** be used in this paper.

1 Write down the reciprocal of $\frac{1}{5}$.

..... [1]

2 Show the inequality $-2 < x \leqslant 3$ on the number line.

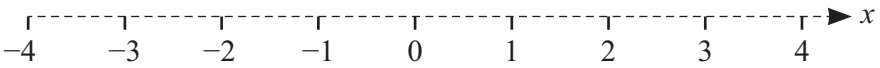

[2]

3 Draw an angle of 215° at A.



[1]

4 9 15 12 8 13 14

Find the range of these numbers.

..... [1]

DO NOT WRITE IN THIS MARGIN
DO NOT WRITE IN THIS MARGIN
DO NOT WRITE IN THIS MARGIN
DO NOT WRITE IN THIS MARGIN
DO NOT WRITE IN THIS MARGIN

5

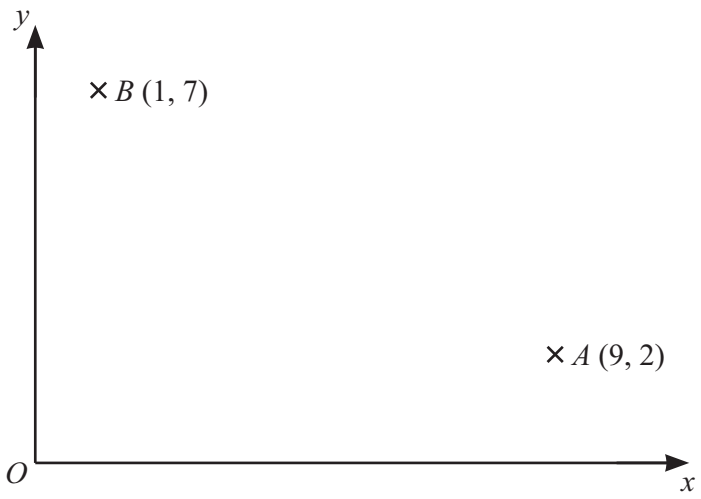

Point A is translated to point B.

Find vector $\overrightarrow{AB}$.

$\overrightarrow{AB} = \begin{pmatrix} \quad \\ \quad \end{pmatrix}$ [2]

6 U = {natural numbers $\leqslant 20$}
A = {multiples of 3}
B = {triangle numbers}

(a) Write down the elements of set A and the elements of set B.

Set A .....

Set B .....
[2]

(b) Write down the elements of $A \cap B$.

..... [1]

7 Write 84 as a product of its prime factors.

..... [2]

DO NOT WRITE IN THIS MARGIN
DO NOT WRITE IN THIS MARGIN
DO NOT WRITE IN THIS MARGIN
DO NOT WRITE IN THIS MARGIN
DO NOT WRITE IN THIS MARGIN

GradeMax

8 By writing each number correct to 1 significant figure, estimate the value of

$$\frac{5923-2198}{0.5461\times 39.43}.$$

..... [2]

9 These are the equations of two lines.

$$4y = x+7 \qquad y+4x = 6$$

(a) Find the coordinates of the point where these two lines intersect.

(..... , ...) [3]

(b) Are the two lines perpendicular?
Give a reason for your answer.

..... because .....

..... [2]

DO NOT WRITE IN THIS MARGIN
DO NOT WRITE IN THIS MARGIN
DO NOT WRITE IN THIS MARGIN
DO NOT WRITE IN THIS MARGIN
DO NOT WRITE IN THIS MARGIN

GradeMax

10 **(a)** The probability that an event happens is 0.95 .

Write down the probability that the event does not happen.

..... [1]

(b) An unbiased die is numbered 1, 2, 3, 4, 5, 6.
Jamisha rolls the die once.

Find the probability that Jamisha rolls

(i) an even number

..... [1]

(ii) a 3 or a 5.

..... [1]

11 These are the first five terms of a sequence.

3 9 19 33 51

Find the *n*th term of this sequence.

..... [2]

DO NOT WRITE IN THIS MARGIN
DO NOT WRITE IN THIS MARGIN
DO NOT WRITE IN THIS MARGIN
DO NOT WRITE IN THIS MARGIN
DO NOT WRITE IN THIS MARGIN

GradeMax

12

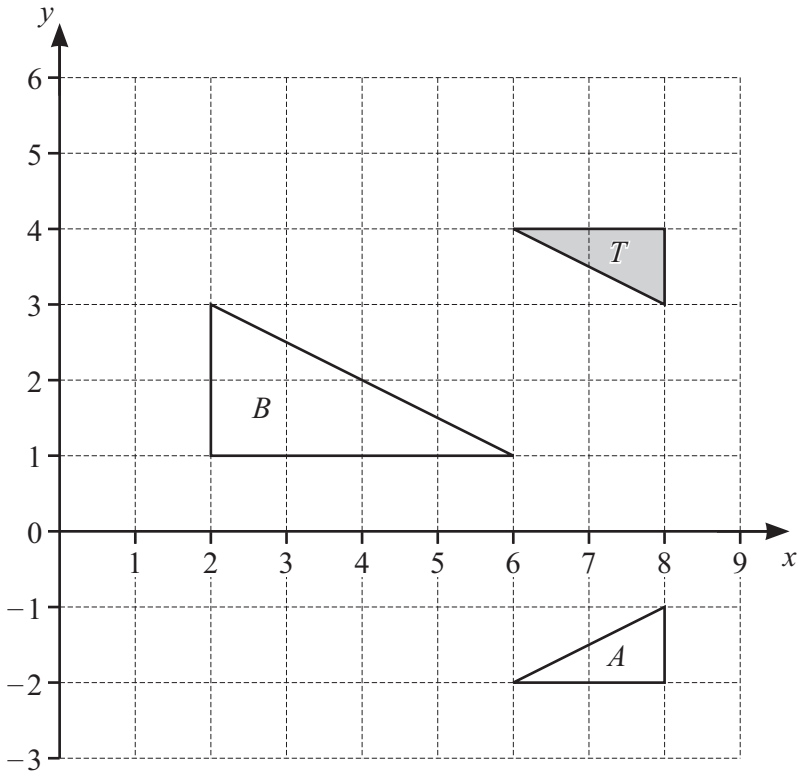

(a) Describe fully the **single** transformation that maps

(i) triangle T onto triangle A

.....

..... [2]

(ii) triangle T onto triangle B.

.....

..... [3]

(b) Draw the image of triangle T after a translation of $\begin{pmatrix} -4 \\ 1 \end{pmatrix}$. [2]

DO NOT WRITE IN THIS MARGIN
DO NOT WRITE IN THIS MARGIN
DO NOT WRITE IN THIS MARGIN
DO NOT WRITE IN THIS MARGIN
DO NOT WRITE IN THIS MARGIN

GradeMax

13

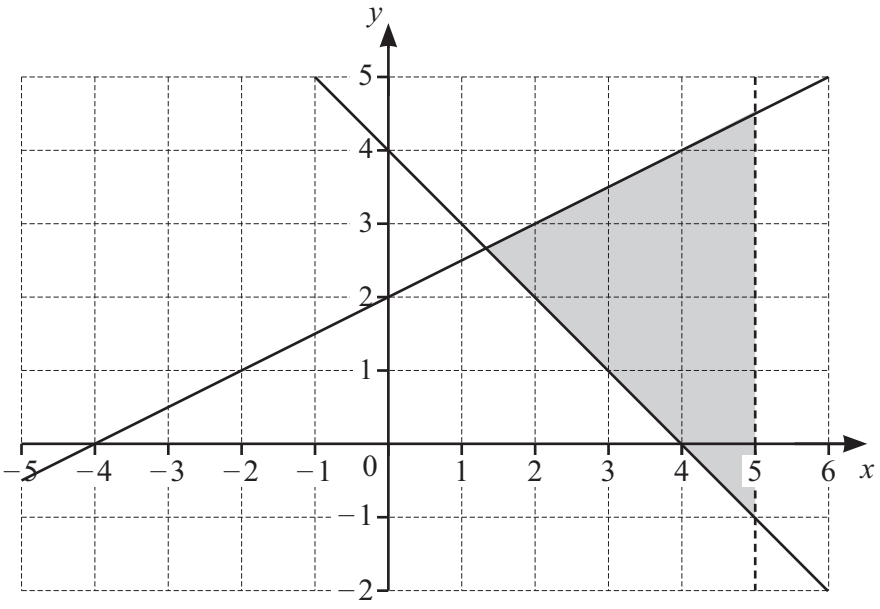

Find the 3 inequalities that define the shaded region.

..... [4]

14 **(a)** Work out $(0.5)^2$.

..... [1]

(b) Work out $\sqrt[3]{64} \times 3^2$.

..... [2]

(c) $16^n = 2^{n-1}$

Find the value of n.

$n =$ ..... [2]

DO NOT WRITE IN THIS MARGIN
DO NOT WRITE IN THIS MARGIN
DO NOT WRITE IN THIS MARGIN
DO NOT WRITE IN THIS MARGIN
DO NOT WRITE IN THIS MARGIN

15 Expand and simplify.

$$(3a+4b)(a-2b)$$

..... [2]

16

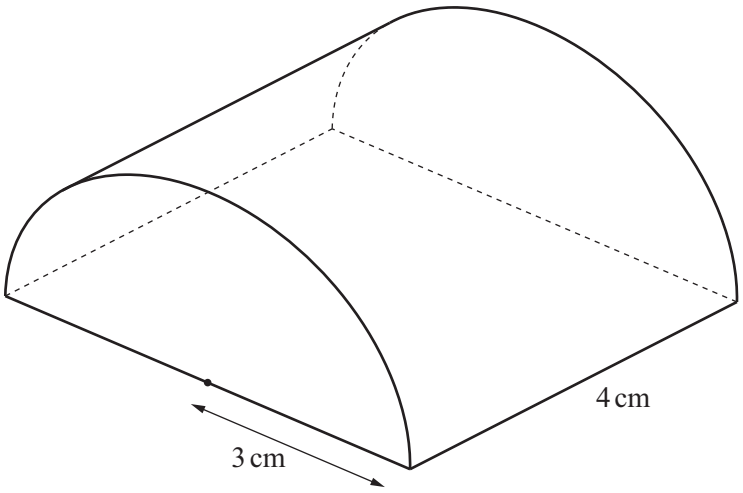

NOT TO SCALE

The diagram shows a solid half cylinder.
The radius of the cross-section is 3 cm.
The length of the solid is 4 cm.

Find the total surface area of the solid.
Give your answer in terms of π.

..... cm^2 [4]

DO NOT WRITE IN THIS MARGIN
DO NOT WRITE IN THIS MARGIN
DO NOT WRITE IN THIS MARGIN
DO NOT WRITE IN THIS MARGIN
DO NOT WRITE IN THIS MARGIN

GradeMax

17 A is the point (–5, 7) and B is the point (5, –2).

Find the equation of the line AB.
Give your answer in the form $ax + by = k$ where a, b and k are integers.

..... [4]

18 **(a)** Rearrange the formula to make a the subject.

$$\sqrt{a-b} = 2c$$

$a =$ ..... [2]

(b) Rearrange the formula to make p the subject.

$$\frac{p-5}{3p-2} = q$$

$p =$ ..... [3]

DO NOT WRITE IN THIS MARGIN
DO NOT WRITE IN THIS MARGIN
DO NOT WRITE IN THIS MARGIN
DO NOT WRITE IN THIS MARGIN
DO NOT WRITE IN THIS MARGIN

GradeMax

19

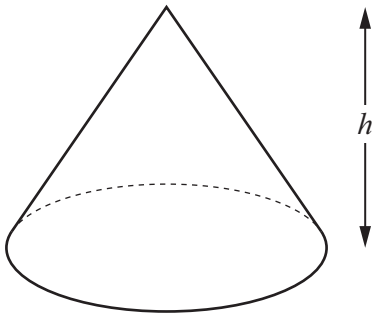

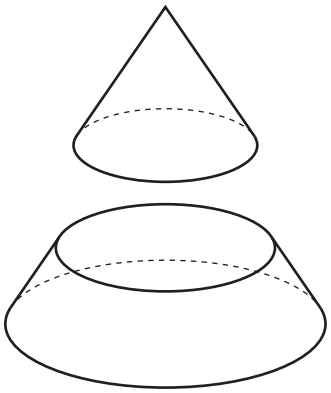

NOT TO SCALE

A large cone has height h.
The large cone is cut parallel to its base to make a smaller cone and a frustum.
The height of the frustum is $\frac{3}{5}h$.

Find the ratio volume of small cone : volume of frustum.

..... : ..... [3]

DO NOT WRITE IN THIS MARGIN
DO NOT WRITE IN THIS MARGIN
DO NOT WRITE IN THIS MARGIN
DO NOT WRITE IN THIS MARGIN
DO NOT WRITE IN THIS MARGIN

GradeMax

20 A box contains 2 yellow pencils, 3 blue pencils and 4 green pencils.
Micah takes two pencils from the box at random without replacement.

Find the probability that the pencils are both blue.

..... [2]

21 **(a)** Simplify.

$$3\sqrt{12} - \sqrt{48} + \sqrt{75}$$

..... [3]

(b) Rationalise the denominator and simplify.

$$\frac{6}{\sqrt{5} - \sqrt{2}}$$

..... [3]

DO NOT WRITE IN THIS MARGIN
DO NOT WRITE IN THIS MARGIN
DO NOT WRITE IN THIS MARGIN
DO NOT WRITE IN THIS MARGIN
DO NOT WRITE IN THIS MARGIN

* 0000800000013 *

22 The equation of a quadratic function is $y = ax^2 + bx + c$.
The vertex of the quadratic function is at (1, 3).
The quadratic function passes through the point (2, 5).

Find the equation of the quadratic function.

$y =$ ..... [4]

DO NOT WRITE IN THIS MARGIN
DO NOT WRITE IN THIS MARGIN
DO NOT WRITE IN THIS MARGIN
DO NOT WRITE IN THIS MARGIN
DO NOT WRITE IN THIS MARGIN

GradeMax

23 (a)

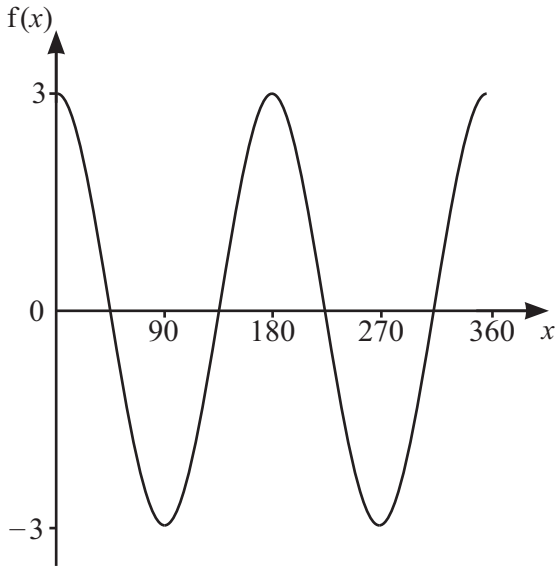

The diagram shows the graph of $f(x°) = a\cos bx$.

Find the value of a and the value of b.

$a =$ .....

$b =$ .....

[2]

(b) Solve $\dfrac{\sqrt{3}}{\tan x} - 1 = 0$ for values of x between 0° and 360°.

..... [3]

DO NOT WRITE IN THIS MARGIN
DO NOT WRITE IN THIS MARGIN
DO NOT WRITE IN THIS MARGIN
DO NOT WRITE IN THIS MARGIN
DO NOT WRITE IN THIS MARGIN

GradeMax

BLANK PAGE

DO NOT WRITE IN THIS MARGIN
DO NOT WRITE IN THIS MARGIN
DO NOT WRITE IN THIS MARGIN
DO NOT WRITE IN THIS MARGIN
DO NOT WRITE IN THIS MARGIN

GradeMax

BLANK PAGE

DO NOT WRITE IN THIS MARGIN
DO NOT WRITE IN THIS MARGIN
DO NOT WRITE IN THIS MARGIN
DO NOT WRITE IN THIS MARGIN
DO NOT WRITE IN THIS MARGIN

Permission to reproduce items where third-party owned material protected by copyright is included has been sought and cleared where possible. Every reasonable effort has been made by the publisher (UCLES) to trace copyright holders, but if any items requiring clearance have unwittingly been included, the publisher will be pleased to make amends at the earliest possible opportunity.

To avoid the issue of disclosure of answer-related information to candidates, all copyright acknowledgements are reproduced online in the Cambridge Assessment International Education Copyright Acknowledgements Booklet. This is produced for each series of examinations and is freely available to download at www.cambridgeinternational.org after the live examination series.

Cambridge Assessment International Education is part of Cambridge Assessment. Cambridge Assessment is the brand name of the University of Cambridge Local Examinations Syndicate (UCLES), which is a department of the University of Cambridge.