GradeMax

* 0000800000001 * DFD

CAMBRIDGE
International Education

Cambridge IGCSE™

CANDIDATE NAME

CENTRE NUMBER

CANDIDATE NUMBER

* 7 5 7 5 2 0 5 3 5 2 *

CAMBRIDGE INTERNATIONAL MATHEMATICS **0607/32**

Paper 3 Calculator (Core) **February/March 2026**

1 hour 15 minutes

You must answer on the question paper.

You will need: Geometrical instruments

INSTRUCTIONS

- Answer **all** questions.
- Use a black or dark blue pen. You may use an HB pencil for any diagrams or graphs.
- Write your name, centre number and candidate number in the boxes at the top of the page.
- Write your answer to each question in the space provided.
- Do **not** use an erasable pen. Do **not** use correction fluid or tape.
- Do **not** write on any bar codes.
- You should use a graphic display calculator where appropriate.
- You may use tracing paper.
- You must show all necessary working clearly. You will be given marks for correct methods, including sketches, even if your answer is incorrect.
- Give non-exact numerical answers correct to 3 significant figures, or 1 decimal place for angles in degrees, unless a different level of accuracy is specified in the question.
- For π, use either your calculator value or 3.142.

INFORMATION

- The total mark for this paper is 60.
- The number of marks for each question or part question is shown in brackets [ ].

This document has **12** pages. Any blank pages are indicated.

DC (WW/SG) 356184/1
© Cambridge University Press & Assessment 2026

[Turn over

GradeMax

List of formulas

Area, A, of triangle, base b, height h.	$A = \frac{1}{2}bh$
Area, A, of circle of radius r.	$A = \pi r^2$
Circumference, C, of circle of radius r.	$C = 2\pi r$
Curved surface area, A, of cylinder of radius r, height h.	$A = 2\pi rh$
Curved surface area, A, of cone of radius r, sloping edge l.	$A = \pi rl$
Surface area, A, of sphere of radius r.	$A = 4\pi r^2$
Volume, V, of prism, cross-sectional area A, length l.	$V = Al$
Volume, V, of pyramid, base area A, height h.	$V = \frac{1}{3}Ah$
Volume, V, of cylinder of radius r, height h.	$V = \pi r^2 h$
Volume, V, of cone of radius r, height h.	$V = \frac{1}{3}\pi r^2 h$
Volume, V, of sphere of radius r.	$V = \frac{4}{3}\pi r^3$

DO NOT WRITE IN THIS MARGIN
DO NOT WRITE IN THIS MARGIN
DO NOT WRITE IN THIS MARGIN
DO NOT WRITE IN THIS MARGIN
DO NOT WRITE IN THIS MARGIN

© Cambridge University Press & Assessment 2026

GradeMax

1 The pictogram shows the numbers of different types of drink sold by a shop one lunchtime.

lemon	
orange	
apple	
mango	

key  = 4 drinks

(a) Work out the total number of drinks sold.

..... [1]

(b) Work out the difference between the number of apple drinks sold and the number of mango drinks sold.

..... [1]

2 A book costs $6.72 .

(a) Work out the cost of 5 of these books.

$ ..... [1]

(b) Work out the greatest number of these books that can be bought with $100.

..... [2]

DO NOT WRITE IN THIS MARGIN
DO NOT WRITE IN THIS MARGIN
DO NOT WRITE IN THIS MARGIN
DO NOT WRITE IN THIS MARGIN
DO NOT WRITE IN THIS MARGIN

© Cambridge University Press & Assessment 2026

GradeMax

3 Complete the statement using one of < , > or = .

-6^2 ..... $(-6)^2$

[1]

4 **(a)** Write $\frac{4}{5}$, 82% and 0.78 in order of size, starting with the smallest.

..... , ... , ... [1]

smallest

(b) Write \$93 as a percentage of \$150.

.....% [1]

(c) Find 3% of 1800 g.

..... g [1]

5 Solve.

$x + 5 = 13$

$x =$ ..... [1]

6 Kaya watches 25 minutes of a film.
This is $\frac{5}{26}$ of the film.

Work out how long the whole film lasts.
Give your answer in hours and minutes.

.....h .....min [3]

© Cambridge University Press & Assessment 2026

DO NOT WRITE IN THIS MARGIN
DO NOT WRITE IN THIS MARGIN
DO NOT WRITE IN THIS MARGIN
DO NOT WRITE IN THIS MARGIN
DO NOT WRITE IN THIS MARGIN

GradeMax

7 The diagram shows three angles a, b and c.

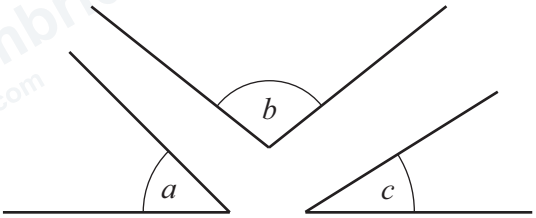

NOT TO SCALE

(a) Write down the mathematical name for an angle of 56°.

..... [1]

(b) Angle $a = 56°$.

(i) The ratio $a : b : c = 4 : 7 : 2$.

Work out the size of angle b and the size of angle c.

$b =$ .....

$c =$ .....

[3]

(ii) Give a geometrical reason why angles a, b and c cannot be joined to form a straight line.

..... [1]

8 **(a)** Factorise.

$8x + 12$

..... [1]

(b) Expand.

$3x(5x^2 - 2)$

..... [2]

© Cambridge University Press & Assessment 2026

DO NOT WRITE IN THIS MARGIN
DO NOT WRITE IN THIS MARGIN
DO NOT WRITE IN THIS MARGIN
DO NOT WRITE IN THIS MARGIN
DO NOT WRITE IN THIS MARGIN

9 Work out.

(a) $\sqrt{0.09} + 5.7$

..... [1]

(b) 1.5^0

..... [1]

(c) $(3^2)^4$

..... [1]

(d) $(2.5 \times 10^{-12}) - (7.6 \times 10^{-13})$

..... [1]

10 A circle has circumference 58 cm.

Work out the area of the circle.

..... cm^2 [3]

11 Make x the subject of the formula.

$$9y + 16x = 48$$

$x =$ ..... [2]

DO NOT WRITE IN THIS MARGIN
DO NOT WRITE IN THIS MARGIN
DO NOT WRITE IN THIS MARGIN
DO NOT WRITE IN THIS MARGIN
DO NOT WRITE IN THIS MARGIN

© Cambridge University Press & Assessment 2026

GradeMax

12 The diagram shows a cube.

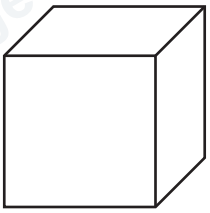

NOT TO SCALE

(a) The total surface area of the cube is $384\,cm^2$.

Show that the volume of the cube is $512\,cm^3$.

[3]

(b)

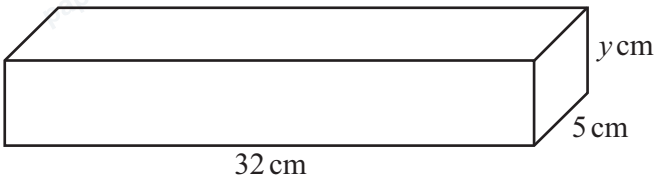

NOT TO SCALE

The cuboid has length 32 cm, width 5 cm and height y cm.
The cuboid has the same volume as the cube.

Work out the value of y.

$y =$ ..... [2]

DO NOT WRITE IN THIS MARGIN
DO NOT WRITE IN THIS MARGIN
DO NOT WRITE IN THIS MARGIN
DO NOT WRITE IN THIS MARGIN
DO NOT WRITE IN THIS MARGIN

© Cambridge University Press & Assessment 2026

13 The price of a ticket is $175.
The price is reduced by 12%.

Work out the new price of the ticket.

$ ..... [2]

14 This is a list of the times, in seconds, for 8 boys to swim 50 metres.

43.9 30.6 31.3 49.8 46.4 39.7 52.3 44.8

(a) Work out the mean.

..... seconds [1]

(b) Work out the range.

..... seconds [1]

(c) The table shows a summary of the times, in seconds, for 8 girls to swim 50 metres.

mean	37.25
range	26.3

Make two comparisons between the swimming times of the boys and of the girls.

1 .....

.....

2 .....

.....
[2]

DO NOT WRITE IN THIS MARGIN

© Cambridge University Press & Assessment 2026

GradeMax

15 **(a)** The diagram shows an isosceles triangle.



Draw any lines of symmetry on the triangle. [1]

(b) This pattern is drawn using 10 identical squares and 5 identical isosceles triangles.



(i) Write down the order of rotational symmetry of the pattern.

..... [1]

(ii) The total shaded area of the pattern is 231cm^2.
Each square has side length 3 cm.
Each isosceles triangle has base length x cm and height 9.4 cm.

Work out the value of x.

$x =$ ..... [4]

DO NOT WRITE IN THIS MARGIN
DO NOT WRITE IN THIS MARGIN
DO NOT WRITE IN THIS MARGIN
DO NOT WRITE IN THIS MARGIN
DO NOT WRITE IN THIS MARGIN

© Cambridge University Press & Assessment 2026

16 The diagram shows a right-angled triangle.

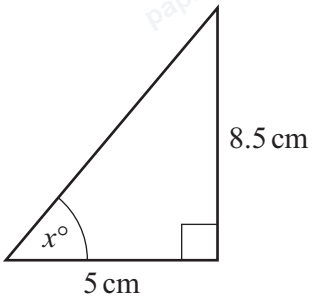

NOT TO SCALE

(a) Calculate the perimeter of the triangle.

..... cm [3]

(b) Find the value of x.

$x =$ ..... [2]

DO NOT WRITE IN THIS MARGIN
DO NOT WRITE IN THIS MARGIN
DO NOT WRITE IN THIS MARGIN
DO NOT WRITE IN THIS MARGIN

GradeMax

17

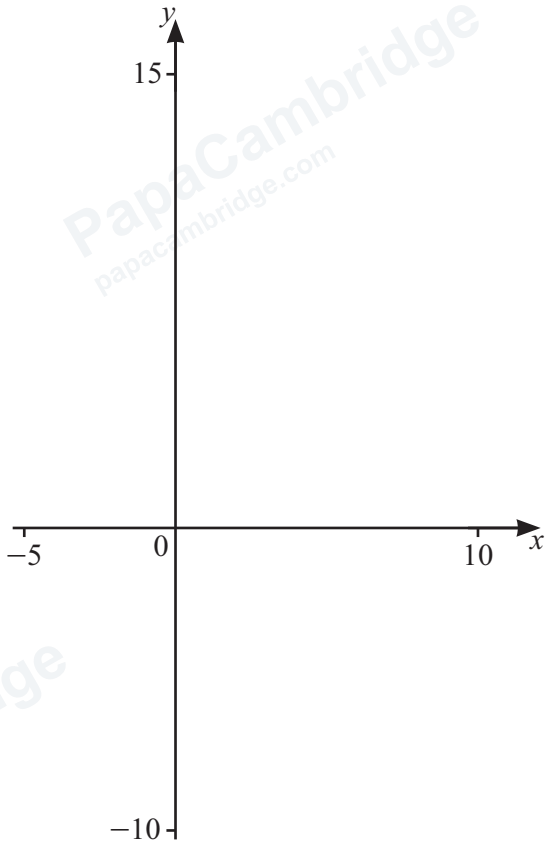

(a) On the diagram, sketch the graph of $y = \frac{6}{4-x}$ for values of x between -5 and 10. [3]

(b) Find the coordinates of the point where the graph crosses the y-axis.

(..... , ...) [1]

(c) On the diagram, sketch the graph of $y = 5-x$ for values of x between -5 and 10. [2]

(d) Find the coordinates of the points of intersection of $y = \frac{6}{4-x}$ and $y = 5-x$.

(..... , ...) and (..... , ...) [2]

© Cambridge University Press & Assessment 2026

DO NOT WRITE IN THIS MARGIN
DO NOT WRITE IN THIS MARGIN
DO NOT WRITE IN THIS MARGIN
DO NOT WRITE IN THIS MARGIN
DO NOT WRITE IN THIS MARGIN

GradeMax

BLANK PAGE

DO NOT WRITE IN THIS MARGIN
DO NOT WRITE IN THIS MARGIN
DO NOT WRITE IN THIS MARGIN
DO NOT WRITE IN THIS MARGIN
DO NOT WRITE IN THIS MARGIN

Permission to reproduce items where third-party owned material protected by copyright is included has been sought and cleared where possible. Every reasonable effort has been made by the publisher (Cambridge University Press & Assessment) to trace copyright holders, but if any items requiring clearance have unwittingly been included, the publisher will be pleased to make amends at the earliest possible opportunity.

To avoid the issue of disclosure of answer-related information to candidates, all copyright acknowledgements are reproduced online in our Copyright Acknowledgements Booklet. This is produced for each series of examinations and is freely available to download at www.cambridgeinternational.org after the live examination series.

Cambridge International Education is the name of our awarding body and a part of Cambridge University Press & Assessment, which is a department of the University of Cambridge.

© Cambridge University Press & Assessment 2026