GradeMax

* 0000800000001 * DFD

CAMBRIDGE
International Education

Cambridge IGCSE™

CANDIDATE NAME

CENTRE NUMBER

CANDIDATE NUMBER

5561144460

CAMBRIDGE INTERNATIONAL MATHEMATICS **0607/52**

Paper 5 Investigation (Core) **February/March 2026**

1 hour 15 minutes

You must answer on the question paper.

No additional materials are needed.

INSTRUCTIONS

- Answer **all** questions.
- Use a black or dark blue pen. You may use an HB pencil for any diagrams or graphs.
- Write your name, centre number and candidate number in the boxes at the top of the page.
- Write your answer to each question in the space provided.
- Do **not** use an erasable pen. Do **not** use correction fluid or tape.
- Do **not** write on any bar codes.
- You should use a graphic display calculator where appropriate.
- You may use tracing paper.
- You must show all necessary working clearly, including sketches, to gain full marks for correct methods.
- In this paper you will be awarded marks for providing full reasons, examples and steps in your working to communicate your mathematics clearly and precisely.

INFORMATION

- The total mark for this paper is 40.
- The number of marks for each question or part question is shown in brackets [ ].

This document has **8** pages.

DC (WW/FC) 356206/3
© Cambridge University Press & Assessment 2026

[Turn over

GradeMax

Investigation Eisenstein triples

In this investigation you will look at the lengths of the sides of a triangle where one angle is 60°.

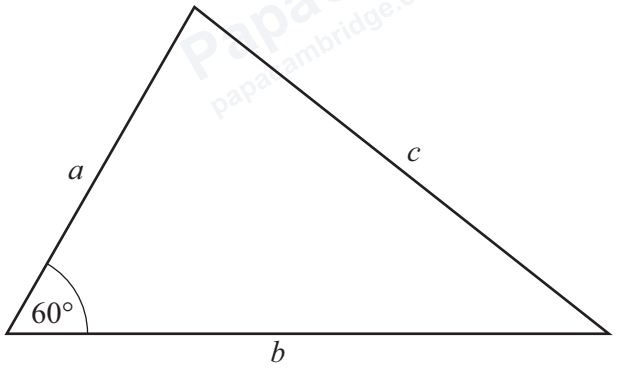

In the triangle:

- the length of the shortest side is a centimetres
- the length of the longest side is b centimetres
- the length of the side opposite the 60° angle is c centimetres.

When a, b and c are integers the sides of the triangle make an Eisenstein triple (a, b, c).

1 The sides of this triangle make an Eisenstein triple.

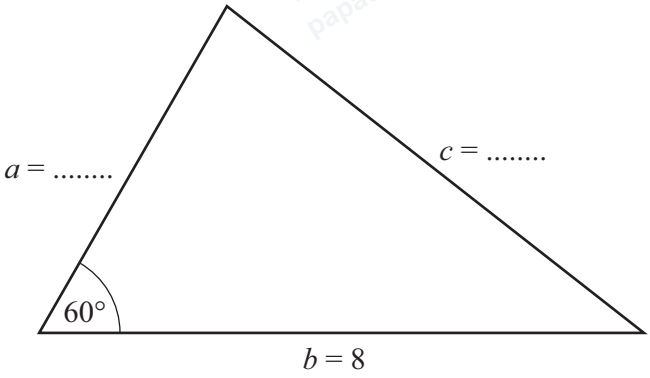

(a) By measuring, complete the number of centimetres in the length of each side. [2]

(b) Calculate the squares of your answers to **1(a)**.

$a^2 =$ ..... $=$ ..... $\quad b^2 = 8^2 = 64 \quad c^2 =$ ..... $=$ ..... [2]

(c) Use **1(b)** to show that $a^2 + b^2 - c^2 = 40$.

[1]

© Cambridge University Press & Assessment 2026

DO NOT WRITE IN THIS MARGIN
DO NOT WRITE IN THIS MARGIN
DO NOT WRITE IN THIS MARGIN
DO NOT WRITE IN THIS MARGIN
DO NOT WRITE IN THIS MARGIN

GradeMax

2 The sides of this triangle also make an Eisenstein triple.

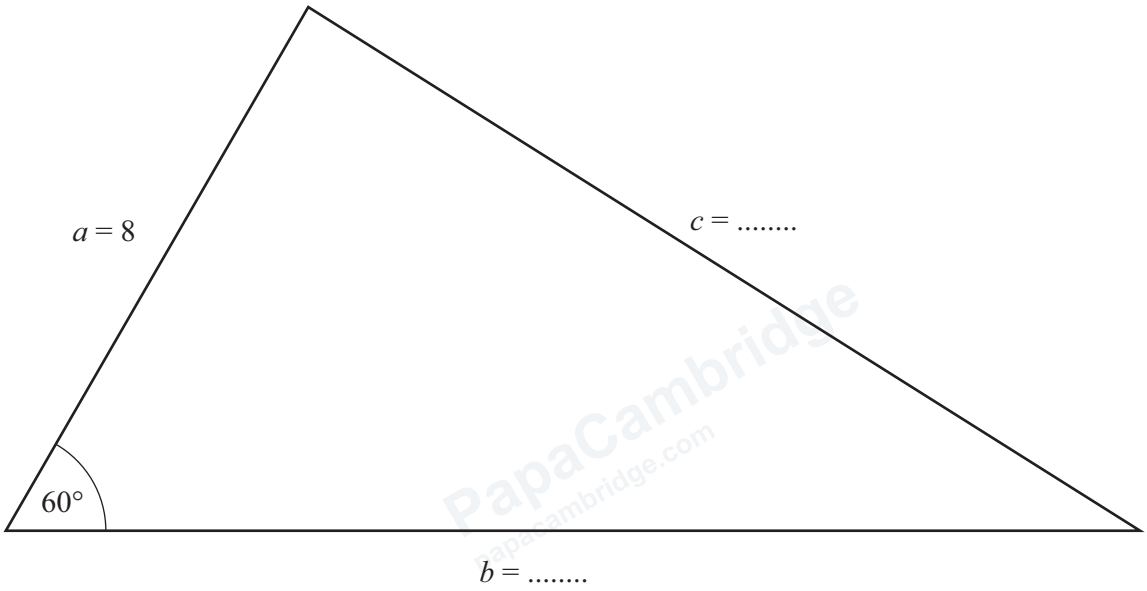

(a) By measuring, complete the number of centimetres in the length of each side. [2]

(b) Calculate the squares of your answers to **2(a)**.

$a^2 = 8^2 = 64$ $b^2 =$ ..... $=$ ..... $c^2 =$ ..... $=$ ..... [2]

(c) Use **2(b)** to show that $a^2 + b^2 - c^2 = 120$.

[1]

DO NOT WRITE IN THIS MARGIN
DO NOT WRITE IN THIS MARGIN
DO NOT WRITE IN THIS MARGIN
DO NOT WRITE IN THIS MARGIN
DO NOT WRITE IN THIS MARGIN

© Cambridge University Press & Assessment 2026

3 Complete the table for Eisenstein triples (a, b, c).

	a	b	c	a^2	b^2	c^2	$a^2+b^2-c^2$	$a\times b$
Question 1		8			64		40	
Question 2	8			64			120	
	5	21	19	25	441		105	
	6		14		256		96	96
	9	24	21			441		216
		35	31			961	385	385

[5]

DO NOT WRITE IN THIS MARGIN
DO NOT WRITE IN THIS MARGIN
DO NOT WRITE IN THIS MARGIN
DO NOT WRITE IN THIS MARGIN
DO NOT WRITE IN THIS MARGIN

© Cambridge University Press & Assessment 2026

GradeMax

4 **(a)** Use the headings of the last two columns of the table in **Question 3** to show that $c^2 = a^2 + b^2 - ab$.

[1]

(b) Use $c^2 = a^2 + b^2 - ab$ to complete the Eisenstein triple for this triangle.

NOT TO SCALE

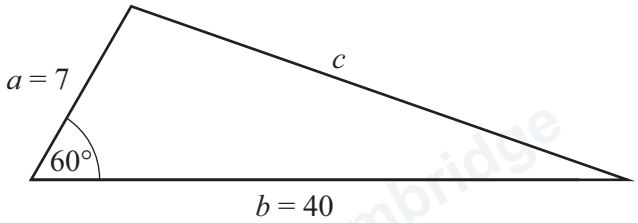

(7, 40, ...) [3]

(c) Show that $c^2 = a^2 + b^2 - ab$ is true for every **equilateral** triangle.

[2]

DO NOT WRITE IN THIS MARGIN
DO NOT WRITE IN THIS MARGIN
DO NOT WRITE IN THIS MARGIN
DO NOT WRITE IN THIS MARGIN
DO NOT WRITE IN THIS MARGIN

© Cambridge University Press & Assessment 2026

5 **(a)** Show that $(9, 65, 61)$ is an Eisenstein triple.

[3]

(b) The diagrams show how you can use one Eisenstein triple to find another Eisenstein triple.

The sides of triangle PQR make the Eisenstein triple $(9, 65, 61)$.

NOT TO SCALE

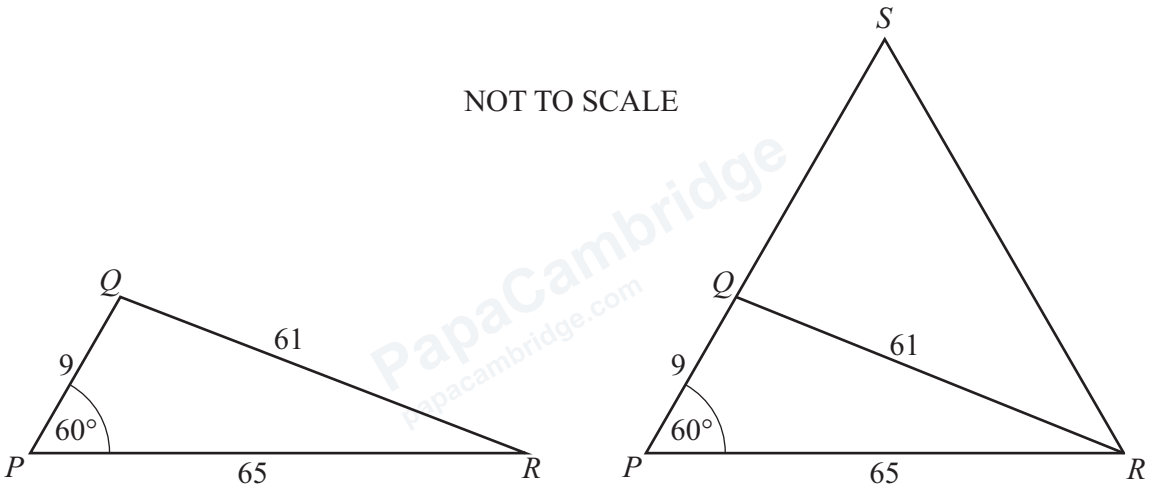

In the diagram on the right, PQ has been extended to S so that $PS = PR$.

(i) Give geometrical reasons why angle $PSR = 60°$.

.....

..... [2]

(ii) Use triangle QSR to find another Eisenstein triple.

(..... , ... , 61) [2]

© Cambridge University Press & Assessment 2026

DO NOT WRITE IN THIS MARGIN
DO NOT WRITE IN THIS MARGIN
DO NOT WRITE IN THIS MARGIN
DO NOT WRITE IN THIS MARGIN
DO NOT WRITE IN THIS MARGIN

GradeMax

(c) The two Eisenstein triples in **5(b)** are related to each other by the diagrams.

The Eisenstein triples (7, 40, 37)
and (33, 40, 37) are also related to each other in the same way.

Find the Eisenstein triple that is related to (9, 24, 21).
You may use the diagram to help you.

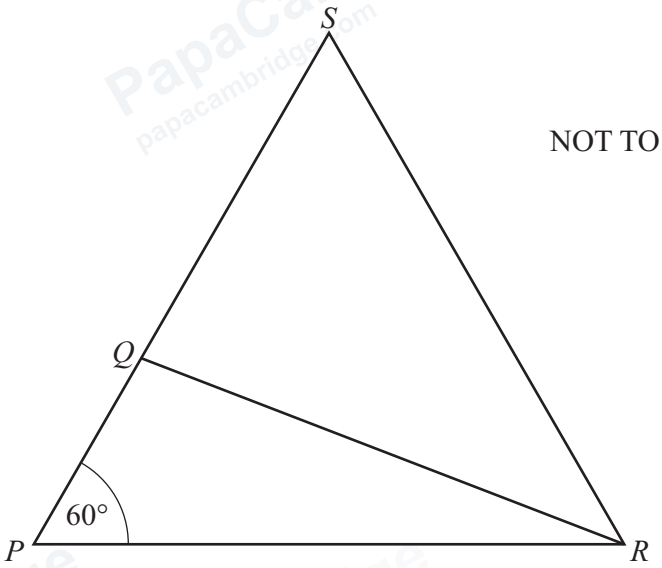

NOT TO SCALE

(..... , ... , ...) [1]

Question 6 is on the back page.

DO NOT WRITE IN THIS MARGIN
DO NOT WRITE IN THIS MARGIN
DO NOT WRITE IN THIS MARGIN
DO NOT WRITE IN THIS MARGIN
DO NOT WRITE IN THIS MARGIN

© Cambridge University Press & Assessment 2026

6 The table shows a sequence of Eisenstein triples (a, b, c) and the value of $2\times\sqrt{b+1}$.

(a) Continue the sequence and complete the last 4 rows of the table.

a	b	c	$2\times\sqrt{b+1}$ **answer**
5	8	7	$2\times\sqrt{8+1} = 2\times3 = 6$
7	15	13	$2\times\sqrt{15+1} = 2\times4 = 8$
9	24	21	
11	35	31	

[5]

(b) Write down the connection between a and $2\times\sqrt{b+1}$.

..... [1]

(c) Find **two** Eisenstein triples with $b = 899$.

(..... , 899, ...)

(..... , 899, ...)

[5]

Permission to reproduce items where third-party owned material protected by copyright is included has been sought and cleared where possible. Every reasonable effort has been made by the publisher (Cambridge University Press & Assessment) to trace copyright holders, but if any items requiring clearance have unwittingly been included, the publisher will be pleased to make amends at the earliest possible opportunity.

To avoid the issue of disclosure of answer-related information to candidates, all copyright acknowledgements are reproduced online in our Copyright Acknowledgements Booklet. This is produced for each series of examinations and is freely available to download at www.cambridgeinternational.org after the live examination series.

Cambridge International Education is the name of our awarding body and a part of Cambridge University Press & Assessment, which is a department of the University of Cambridge.

© Cambridge University Press & Assessment 2026

DO NOT WRITE IN THIS MARGIN DO NOT WRITE IN THIS MARGIN DO NOT WRITE IN THIS MARGIN DO NOT WRITE IN THIS MARGIN