GradeMax

* 0000800000001 *



Cambridge Assessment International Education

Cambridge IGCSE™

CANDIDATE NAME

CENTRE NUMBER

CANDIDATE NUMBER

6833788872

MATHEMATICS **0580/22**

Paper 2 Non-calculator (Extended) **February/March 2025**

2 hours

You must answer on the question paper.

You will need: Geometrical instruments

INSTRUCTIONS

- Answer **all** questions.
- Use a black or dark blue pen. You may use an HB pencil for any diagrams or graphs.
- Write your name, centre number and candidate number in the boxes at the top of the page.
- Write your answer to each question in the space provided.
- Do **not** use an erasable pen or correction fluid.
- Do **not** write on any bar codes.
- Calculators must **not** be used in this paper.
- You may use tracing paper.
- You must show all necessary working clearly.

INFORMATION

- The total mark for this paper is 100.
- The number of marks for each question or part question is shown in brackets [ ].

This document has **20** pages.

DC (DE/FC) 341757/2
© UCLES 2025

[Turn over

GradeMax

List of formulas

Area, A, of triangle, base b, height h.	$A = \frac{1}{2}bh$
Area, A, of circle of radius r.	$A = \pi r^2$
Circumference, C, of circle of radius r.	$C = 2\pi r$
Curved surface area, A, of cylinder of radius r, height h.	$A = 2\pi rh$
Curved surface area, A, of cone of radius r, sloping edge l.	$A = \pi rl$
Surface area, A, of sphere of radius r.	$A = 4\pi r^2$
Volume, V, of prism, cross-sectional area A, length l.	$V = Al$
Volume, V, of pyramid, base area A, height h.	$V = \frac{1}{3}Ah$
Volume, V, of cylinder of radius r, height h.	$V = \pi r^2 h$
Volume, V, of cone of radius r, height h.	$V = \frac{1}{3}\pi r^2 h$
Volume, V, of sphere of radius r.	$V = \frac{4}{3}\pi r^3$
For the equation $ax^2 + bx + c = 0$, where $a \neq 0$,	$x = \frac{-b \pm \sqrt{b^2 - 4ac}}{2a}$

For the triangle shown,

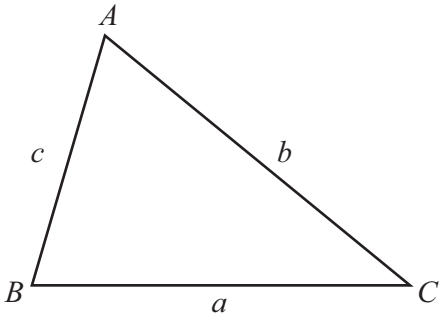

$$\frac{a}{\sin A} = \frac{b}{\sin B} = \frac{c}{\sin C}$$

$$a^2 = b^2 + c^2 - 2bc\cos A$$

$$\text{Area} = \frac{1}{2}ab\sin C$$

DO NOT WRITE IN THIS MARGIN
DO NOT WRITE IN THIS MARGIN
DO NOT WRITE IN THIS MARGIN
DO NOT WRITE IN THIS MARGIN
DO NOT WRITE IN THIS MARGIN

GradeMax

Calculators must **not** be used in this paper.

1 Oranges cost 220 rupees per kilogram.

Work out the cost of 9 kg of these oranges.

..... rupees [1]

2 Aryan goes on a journey.
He leaves home at 11 40 and arrives at 14 18.

Find how many hours and minutes the journey took.

..... h ..... min [1]

3 A quadrilateral has one line of symmetry.
The diagonals of the quadrilateral cross at right angles.

Write down the mathematical name of the quadrilateral.

..... [1]

DO NOT WRITE IN THIS MARGIN
DO NOT WRITE IN THIS MARGIN
DO NOT WRITE IN THIS MARGIN
DO NOT WRITE IN THIS MARGIN
DO NOT WRITE IN THIS MARGIN

GradeMax

4 $V = 4mp^2$

(a) Find V when $m = 10$ and $p = -3$.

$V =$ ..... [2]

(b) Find the positive value of p when $V = 3200$ and $m = 2$.

$p =$ ..... [2]

5 Write these lengths in order of size, starting with the smallest.

0.03 m 2.9 cm 32 mm 0.000 02 km

..... , ... , ... , ... [2]

smallest

DO NOT WRITE IN THIS MARGIN
DO NOT WRITE IN THIS MARGIN
DO NOT WRITE IN THIS MARGIN
DO NOT WRITE IN THIS MARGIN
DO NOT WRITE IN THIS MARGIN

DO NOT WRITE IN THIS MARGIN
DO NOT WRITE IN THIS MARGIN
DO NOT WRITE IN THIS MARGIN
DO NOT WRITE IN THIS MARGIN
DO NOT WRITE IN THIS MARGIN

6

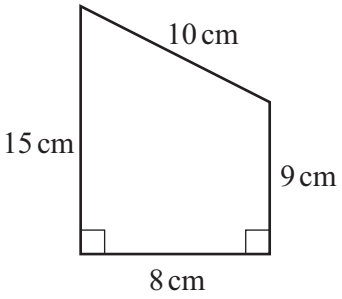

NOT TO SCALE

Work out the area of the trapezium.

..... cm^2 [2]

7

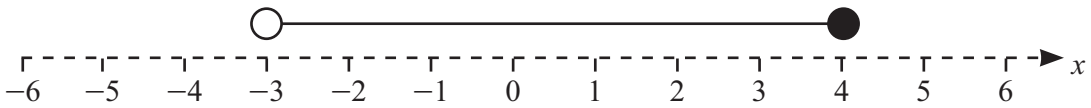

Write down the inequality for x represented on the number line.

..... [2]

GradeMax

8 Pryanka plays a game in which she can win, lose or draw.
The table shows the probability of her winning or losing a game.

Result of game	win	lose	draw
Probability	0.3	0.25	

(a) Complete the table. [2]

(b) Pryanka plays this game 120 times.

Work out the expected number of games she wins.

..... [1]

9 $D = \sqrt{\dfrac{1.95 \times 9.92^2}{8.07}}$

By writing each number correct to 1 significant figure, work out an estimate for D.

$D =$ ..... [3]

DO NOT WRITE IN THIS MARGIN
DO NOT WRITE IN THIS MARGIN
DO NOT WRITE IN THIS MARGIN
DO NOT WRITE IN THIS MARGIN
DO NOT WRITE IN THIS MARGIN

GradeMax

10

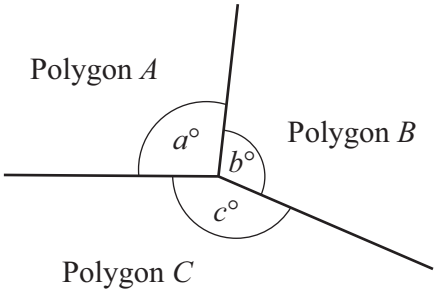

NOT TO SCALE

Three regular polygons *A*, *B* and *C* meet at a point.
The interior angles of the polygons are in the ratio $a : b : c = 3 : 4 : 5$.

Show that polygon *C* has twice the number of sides as polygon *B*.

[5]

DO NOT WRITE IN THIS MARGIN
DO NOT WRITE IN THIS MARGIN
DO NOT WRITE IN THIS MARGIN
DO NOT WRITE IN THIS MARGIN
DO NOT WRITE IN THIS MARGIN

GradeMax

11 A company sells items either on a website or in shops.
The composite bar chart shows the percentage of sales on the website and in shops for January, February and March.

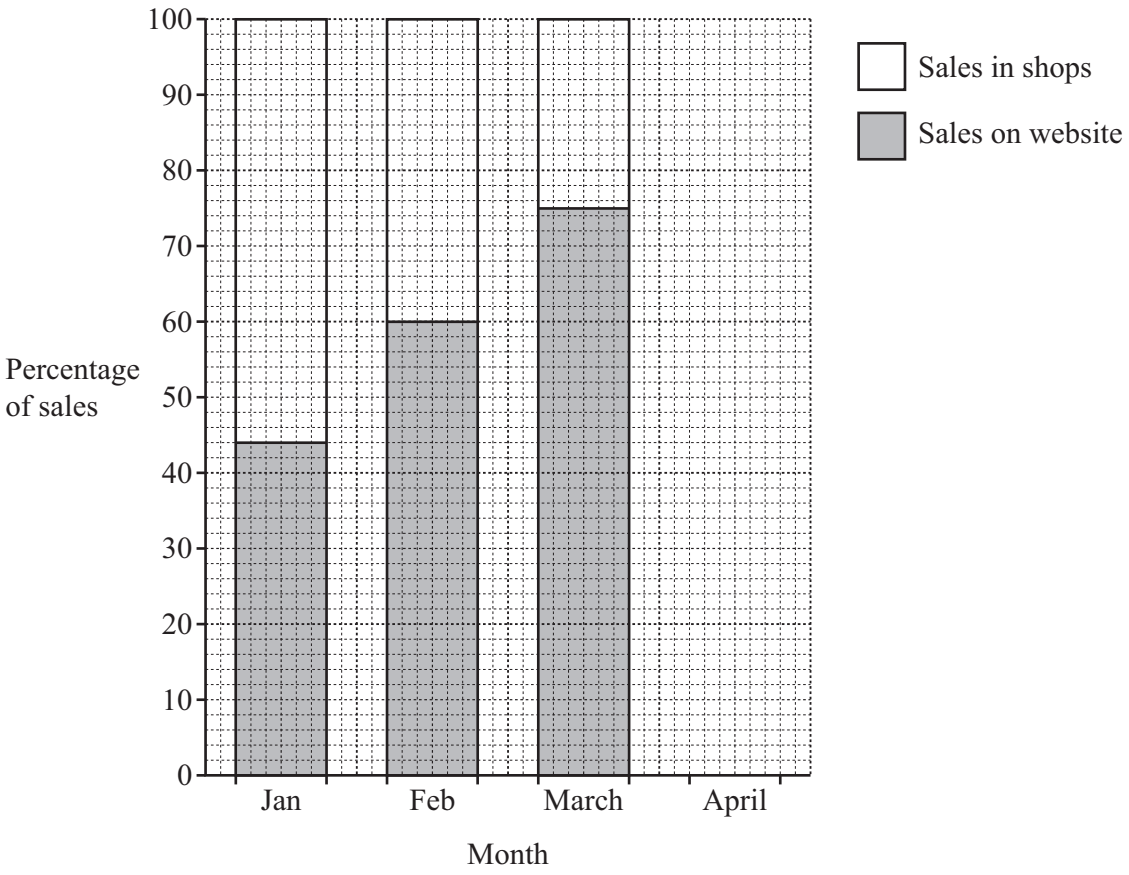

(a) In April, $\frac{17}{20}$ of the company's sales were on the website.

On the grid, draw the bar for April. [2]

(b) In February, the company had sales of $3.5 million.

Work out the value of sales **in shops** in February.

$ ..... million [3]

DO NOT WRITE IN THIS MARGIN
DO NOT WRITE IN THIS MARGIN
DO NOT WRITE IN THIS MARGIN
DO NOT WRITE IN THIS MARGIN
DO NOT WRITE IN THIS MARGIN

(c) In May, the company had sales of $6 million.
In June, the company had sales of $7.5 million.

Find the percentage increase in sales from May to June.

..... % [3]

(d) In 2024, the company had total sales of $52 million.
This was an increase of 30% on the total sales for 2023.

Work out the total sales in 2023.

$ ..... million [2]

12 **(a)** Write as a single fraction in its simplest form.

$$\frac{x}{4}+\frac{3x}{8}-\frac{x+2}{12}$$

..... [3]

(b) Factorise.

$$3x(a+4y)-ay-4y^2$$

..... [1]

DO NOT WRITE IN THIS MARGIN
DO NOT WRITE IN THIS MARGIN
DO NOT WRITE IN THIS MARGIN
DO NOT WRITE IN THIS MARGIN
DO NOT WRITE IN THIS MARGIN

GradeMax

13

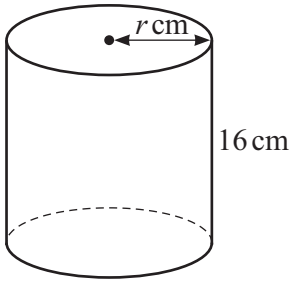

NOT TO SCALE

The diagram shows a cylinder with radius r cm and height 16 cm.
A sphere has radius 3 cm.
The volume of the cylinder is equal to the volume of the sphere.

Find the value of r.

$r =$ ..... [4]

DO NOT WRITE IN THIS MARGIN
DO NOT WRITE IN THIS MARGIN
DO NOT WRITE IN THIS MARGIN
DO NOT WRITE IN THIS MARGIN
DO NOT WRITE IN THIS MARGIN

14

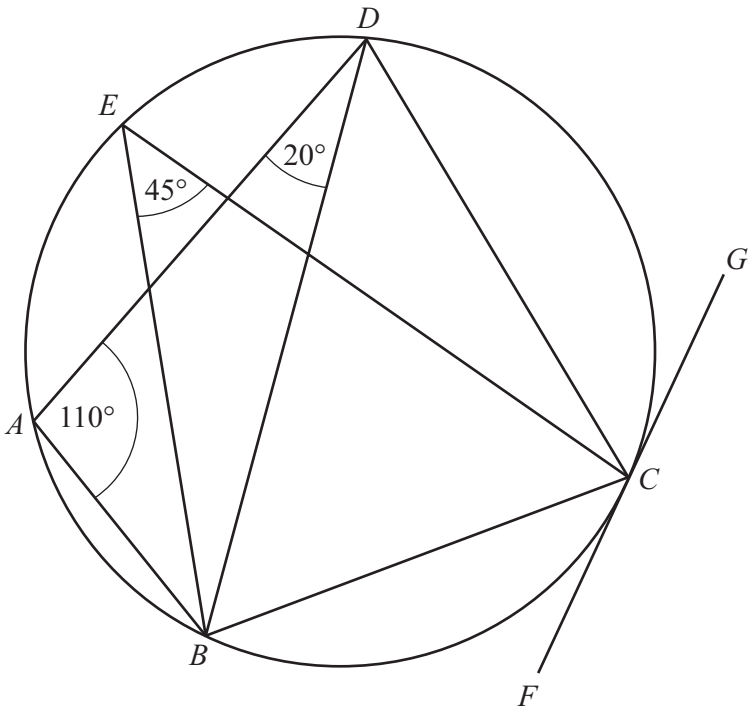

NOT TO SCALE

A, B, C, D and E lie on a circle.
FG is a tangent to the circle at C.
Angle $BAD = 110°$, angle $ADB = 20°$ and angle $BEC = 45°$.

(a) Find angle BCD.
Give a geometrical reason for your answer.

Angle BCD = ... because .....

..... [2]

(b) **(i)** Find angle DBC.

Angle DBC = ... [2]

(ii) Find angle DCG.

Angle DCG = ... [1]

DO NOT WRITE IN THIS MARGIN
DO NOT WRITE IN THIS MARGIN
DO NOT WRITE IN THIS MARGIN
DO NOT WRITE IN THIS MARGIN
DO NOT WRITE IN THIS MARGIN

GradeMax

15 Point A has coordinates $(-4, 1)$ and $\overrightarrow{BA} = \begin{pmatrix} -5 \\ -12 \end{pmatrix}$.

(a) Find the coordinates of point B.

(....., ...) [2]

(b) Point C has coordinates $(5, -2)$.

Find the vector $\overrightarrow{CA}$.

$\overrightarrow{CA} = \begin{pmatrix} \quad \\ \quad \end{pmatrix}$ [2]

(c) $\overrightarrow{EF} = 3\overrightarrow{BA}$

Find $\left|\overrightarrow{EF}\right|$.

..... [3]

DO NOT WRITE IN THIS MARGIN
DO NOT WRITE IN THIS MARGIN
DO NOT WRITE IN THIS MARGIN
DO NOT WRITE IN THIS MARGIN
DO NOT WRITE IN THIS MARGIN

GradeMax

16 The stem-and-leaf diagram shows the mass of each of 13 packets.

3	1 2 8
4	0 1 2 3 3 8
5	1 2 3 4

Key: 3 | 1 represents 31 g

(a) Work out the interquartile range.

..... g [3]

(b) Two of these packets are chosen at random.

Find the probability that the one packet has a mass of more than 50 g and the other packet has a mass of less than 50 g.

..... [3]

DO NOT WRITE IN THIS MARGIN
DO NOT WRITE IN THIS MARGIN
DO NOT WRITE IN THIS MARGIN
DO NOT WRITE IN THIS MARGIN
DO NOT WRITE IN THIS MARGIN

GradeMax

17 Work out.

$$\frac{5}{9} + 0.2\dot{8}$$

Give your answer as a fraction in its simplest form.

..... [4]

DO NOT WRITE IN THIS MARGIN
DO NOT WRITE IN THIS MARGIN
DO NOT WRITE IN THIS MARGIN
DO NOT WRITE IN THIS MARGIN
DO NOT WRITE IN THIS MARGIN

* 0000800000015 *

18

NOT TO SCALE

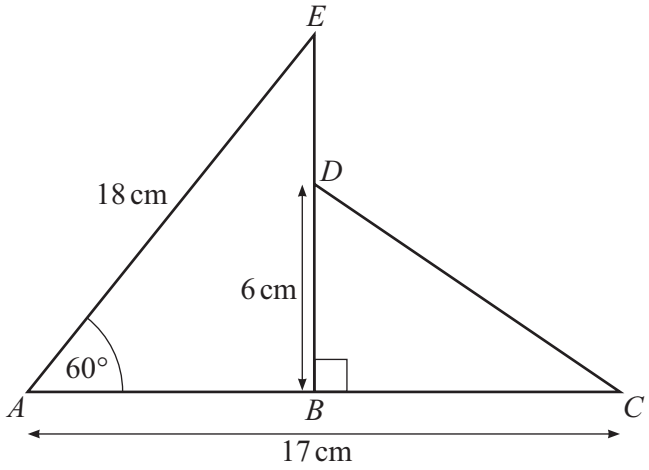

The quadrilateral $ACDE$ is formed by two right-angled triangles ABE and BCD.
$AC = 17$ cm, $AE = 18$ cm and $BD = 6$ cm.

(a) Show that $CD = 10$ cm.

[5]

(b) Find the perimeter of the quadrilateral $ACDE$.
Give your answer in the form $p + k\sqrt{q}$.

..... cm [4]

DO NOT WRITE IN THIS MARGIN
DO NOT WRITE IN THIS MARGIN
DO NOT WRITE IN THIS MARGIN
DO NOT WRITE IN THIS MARGIN
DO NOT WRITE IN THIS MARGIN

19

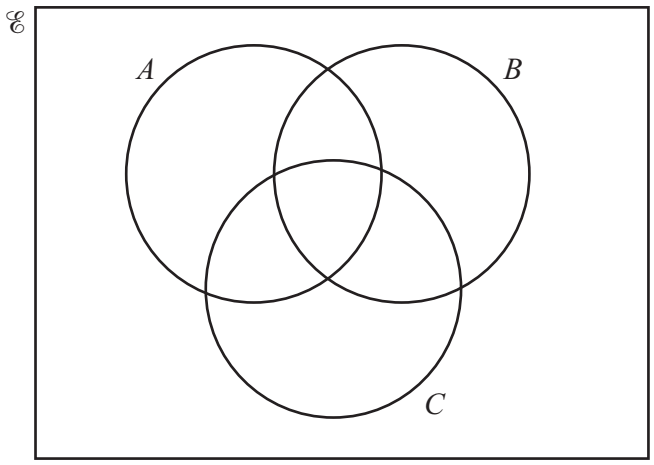

In the Venn diagram, shade the region $(A \cup B \cup C)'$. [1]

20 **(a)** Simplify.

$$\sqrt{300} + \sqrt{48}$$

..... [2]

(b) Rationalise the denominator and simplify.

$$\frac{9}{2+\sqrt{7}}$$

..... [3]

DO NOT WRITE IN THIS MARGIN
DO NOT WRITE IN THIS MARGIN
DO NOT WRITE IN THIS MARGIN
DO NOT WRITE IN THIS MARGIN
DO NOT WRITE IN THIS MARGIN

GradeMax

DO NOT WRITE IN THIS MARGIN
DO NOT WRITE IN THIS MARGIN
DO NOT WRITE IN THIS MARGIN
DO NOT WRITE IN THIS MARGIN
DO NOT WRITE IN THIS MARGIN

21 **(a)** Write down the coordinates of the point where the graph of $y = 5x - 3$ crosses the y – axis.

(....., ...) [1]

(b) A is the point $(1, 7)$ and B is the point $(5, 15)$.

Find the equation of the perpendicular bisector of the line AB.
Give your answer in the form $y = mx + c$.

$y =$ ..... [5]

GradeMax

22 A curve has equation $y = x^3 + x^2 - x$.

The curve has a stationary point at $\left(\frac{1}{3}, -\frac{5}{27}\right)$.

(a) Find the coordinates of the other stationary point.

(....., ...) [5]

DO NOT WRITE IN THIS MARGIN
DO NOT WRITE IN THIS MARGIN
DO NOT WRITE IN THIS MARGIN
DO NOT WRITE IN THIS MARGIN
DO NOT WRITE IN THIS MARGIN

DO NOT WRITE IN THIS MARGIN
DO NOT WRITE IN THIS MARGIN
DO NOT WRITE IN THIS MARGIN
DO NOT WRITE IN THIS MARGIN
DO NOT WRITE IN THIS MARGIN

(b) By sketching the graph of $y = x^3 + x^2 - x$, determine whether the stationary point $\left(\frac{1}{3}, -\frac{5}{27}\right)$ is a maximum or a minimum.

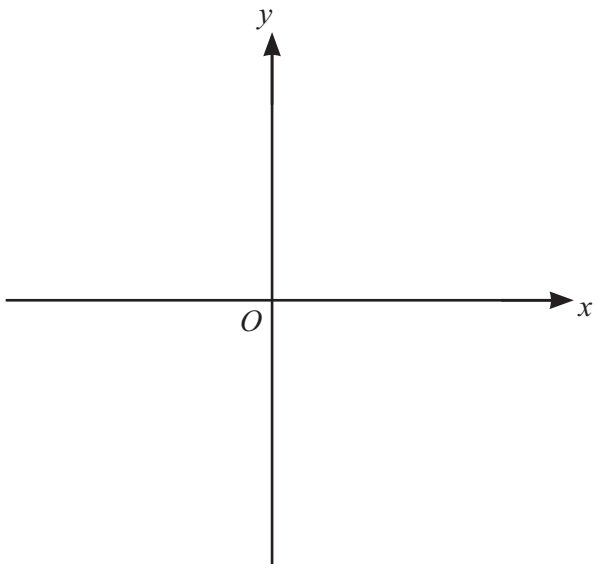

$\left(\frac{1}{3}, -\frac{5}{27}\right)$ is a ..... [2]

(c) The equation $x^3 + x^2 - x = k$ has fewer than 3 solutions.

Find the range of possible values for k.

..... [2]

Question 23 is printed on the next page.

GradeMax

23 **(a)** Simplify $\left(\frac{x^2}{4}\right)^{\frac{3}{2}}$.

..... [2]

(b) $16^x \times \left(\frac{1}{2}\right)^x = 4^{x+3}$

Find the value of x.

$x =$ ..... [4]

DO NOT WRITE IN THIS MARGIN

DO NOT WRITE IN THIS MARGIN

DO NOT WRITE IN THIS MARGIN

DO NOT WRITE IN THIS MARGIN

DO NOT WRITE IN THIS MARGIN

Permission to reproduce items where third-party owned material protected by copyright is included has been sought and cleared where possible. Every reasonable effort has been made by the publisher (UCLES) to trace copyright holders, but if any items requiring clearance have unwittingly been included, the publisher will be pleased to make amends at the earliest possible opportunity.

To avoid the issue of disclosure of answer-related information to candidates, all copyright acknowledgements are reproduced online in the Cambridge Assessment International Education Copyright Acknowledgements Booklet. This is produced for each series of examinations and is freely available to download at www.cambridgeinternational.org after the live examination series.

Cambridge Assessment International Education is part of Cambridge Assessment. Cambridge Assessment is the brand name of the University of Cambridge Local Examinations Syndicate (UCLES), which is a department of the University of Cambridge.