GradeMax

Cambridge Assessment International Education

Cambridge IGCSE™

PHYSICS **0625/22**

Paper 2 Multiple Choice (Extended) **February/March 2024**

45 minutes

You must answer on the multiple choice answer sheet.

You will need: Multiple choice answer sheet
Soft clean eraser
Soft pencil (type B or HB is recommended)

INSTRUCTIONS

- There are **forty** questions on this paper. Answer **all** questions.
- For each question there are four possible answers **A**, **B**, **C** and **D**. Choose the **one** you consider correct and record your choice in soft pencil on the multiple choice answer sheet.
- Follow the instructions on the multiple choice answer sheet.
- Write in soft pencil.
- Write your name, centre number and candidate number on the multiple choice answer sheet in the spaces provided unless this has been done for you.
- Do **not** use correction fluid.
- Do **not** write on any bar codes.
- You may use a calculator.
- Take the weight of 1.0 kg to be 9.8 N (acceleration of free fall = 9.8 m / s^2).

INFORMATION

- The total mark for this paper is 40.
- Each correct answer will score one mark.
- Any rough working should be done on this question paper.

IB24 03_0625_22/4RP
© UCLES 2024

[Turn over

GradeMax

1 A student has a measuring cylinder containing water and also has a balance.

Which of these could she use to find the volume of a small metal sphere?

She has no other apparatus.

A either the measuring cylinder containing water or the balance

B the measuring cylinder containing water only

C the balance only

D neither the measuring cylinder nor the balance

2 The diagram shows a solid object on a flat surface, with two forces acting on the object.

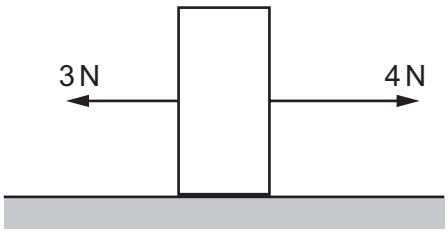

What is the resultant force on the object?

A 1 N to the left

B 1 N to the right

C 7 N to the left

D 7 N to the right

3 A ball is falling towards the ground.

Which transfer between energy stores is taking place?

A elastic energy to kinetic energy

B gravitational potential energy to elastic energy

C gravitational potential energy to kinetic energy

D kinetic energy to gravitational potential energy

4 Which row contains one scalar quantity and one vector quantity?

	quantity 1	quantity 2
A	energy	velocity
B	mass	time
C	momentum	weight
D	distance	temperature

© UCLES 2024

GradeMax

5 The table gives data about four liquids, W, X, Y and Z.

liquid	mass / g	volume / cm^3
W	10	10
X	20	15
Y	30	50
Z	40	50

None of the liquids mixes with any of the other liquids.

All the liquids are put in the same container and settle to form four separate layers.

Which statement is correct?

A W forms the layer below X.

B X forms the top layer.

C Y forms the bottom layer.

D Z forms the layer below Y.

6 A weightless beam is balanced on a pivot as shown. Forces P, Q and R act on the beam.

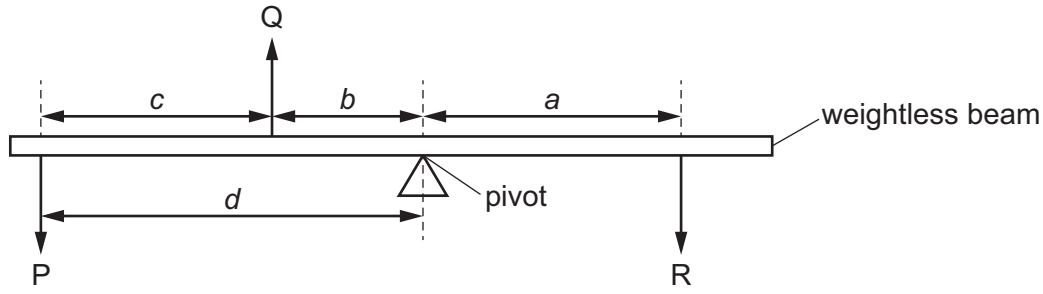

Which equation is correct?

A $(P \times c) + (Q \times b) = (R \times a)$

B $(P \times c) - (Q \times b) = (R \times a)$

C $(P \times d) + (Q \times b) = (R \times a)$

D $(P \times d) - (Q \times b) = (R \times a)$

© UCLES 2024

[Turn over

GradeMax

7 An object is moving at +3.0 m / s.

A force acts on the object.

After a time, the object is moving at –4.0 m / s.

The mass of the object is 5.0 kg.

What is the change in momentum of the body?

A –35 kg m / s **B** –5.0 kg m / s **C** +5.0 kg m / s **D** +35 kg m / s

8 The diagram shows a column of liquid. The pressure, due to the liquid, at the bottom of the liquid is 6000 N / m^2.

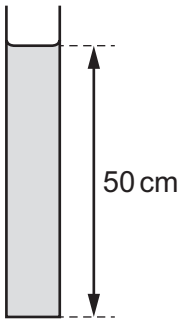

What is the density of the liquid?

A 310 kg / m^3

B 1200 kg / m^3

C 29 000 kg / m^3

D 120 000 kg / m^3

9 Which statement correctly describes a change of state?

A A gas condenses to form a liquid.

B A liquid melts to form a solid.

C A solid condenses to form a liquid.

D A solid boils to form a gas.

© UCLES 2024

10 The diagram shows a pan used for cooking food.

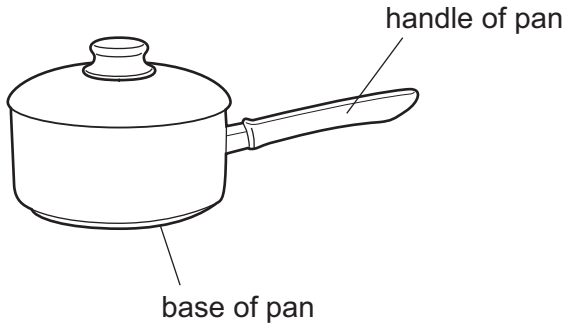

Which row is correct for the materials used to make the base of the pan and the handle of the pan?

	base of pan	handle of pan
A	good thermal conductor	good thermal conductor
B	good thermal conductor	poor thermal conductor
C	poor thermal conductor	good thermal conductor
D	poor thermal conductor	poor thermal conductor

11 Solar heating panels consist of pipes carrying water that absorb radiation from the Sun.

Which texture and colour is the surface of the pipes so that the temperature of the water rises at the quickest rate?

A dull black

B dull white

C shiny black

D shiny white

12 When pollen grains in water are viewed through a microscope, they are seen to be in continuous, rapid, random motion.

What causes a pollen grain to move in this way?

A convection currents in the water

B bombardment by a single molecule of water

C uneven bombardment on different sides by water molecules

D collision with another pollen grain

© UCLES 2024

GradeMax

13 A circular, flat-bottomed dish contains 100 cm^3 of water.

Students are asked how to increase the rate at which the water evaporates.

Their suggestions are listed.

student 1 Pour the water into a flat-bottomed dish of larger diameter.

student 2 Cool the dish and water.

student 3 Create a current of air over the dish with a fan.

Which suggestions will increase the rate of evaporation?

A 1, 2 and 3 **B** 1 and 2 only **C** 1 and 3 only **D** 2 and 3 only

14 Matter consists of very small particles in a continual state of motion.

Which row describes the behaviour of particles in a liquid?

	force between particles	motion of particles
A	strong	move randomly at high speed
B	strong	vibrate, but change positions
C	weak	vibrate in fixed positions
D	weak	move randomly at high speed

© UCLES 2024

GradeMax

15 The diagram shows the equipment used in an experiment on the heating of aluminium.

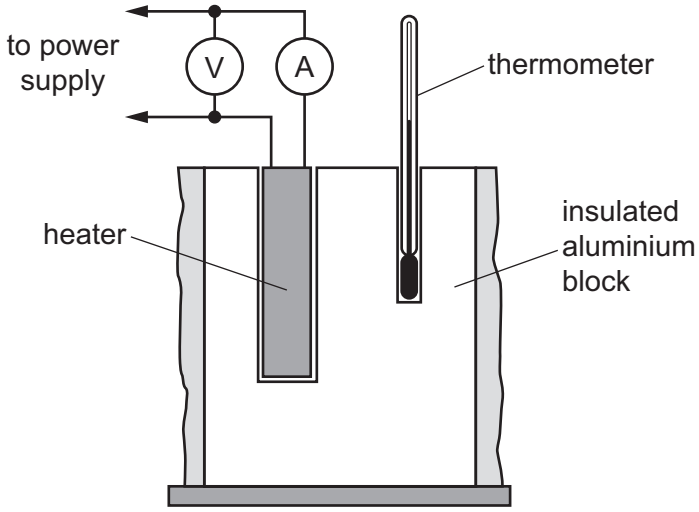

The table gives the results for the experiment.

mass of block	0.80 kg
voltmeter reading	12 V
ammeter reading	5.0 A
time	300 s

The specific heat capacity of aluminium is 900 J / (kg °C).

What is the maximum possible temperature rise in the block?

A 9 °C **B** 20 °C **C** 25 °C **D** 225 °C

16 The diagram shows a wave.

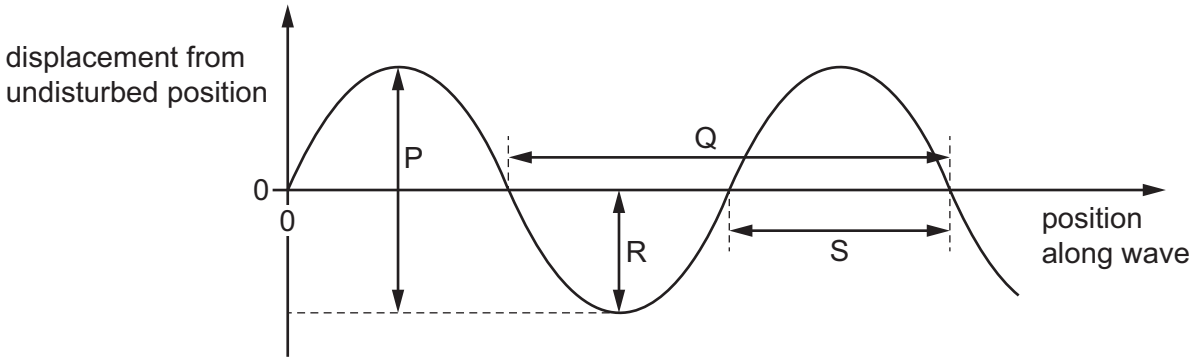

Which dimensions describe the properties of the wave?

A P = amplitude, S = speed

B P = speed, Q = wavelength

C R = amplitude, Q = wavelength

D R = amplitude, S = wavelength

© UCLES 2024

GradeMax

17 Which row describes some characteristics of an image formed in a plane mirror?

	image type	image size
A	real	diminished
B	real	same size as the object
C	virtual	diminished
D	virtual	same size as the object

18 The range of audible frequencies for elephants is 10 Hz to 12 000 Hz, and for horses is 55 Hz to 33 000 Hz.

Which statement about the range of audible frequencies for a healthy human ear is correct?

A The human ear can hear all sounds heard by both elephants and horses.

B The human ear can hear all sounds heard by elephants but not all those heard by horses.

C The human ear can hear all sounds heard by horses but not all those heard by elephants.

D The human ear cannot hear all sounds heard by elephants nor those heard by horses.

© UCLES 2024

GradeMax

19 An object is placed in front of a plane mirror.

The ray diagram shows the reflection of one ray of light from the object by the mirror.

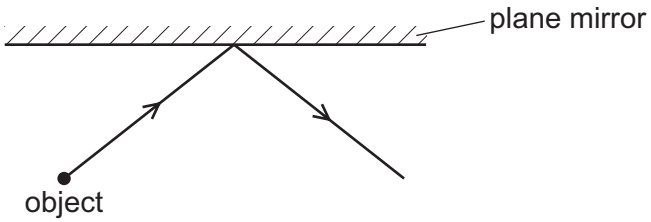

Where does the mirror form an image of the object?

A

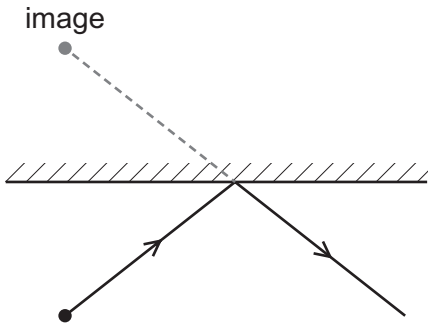

B

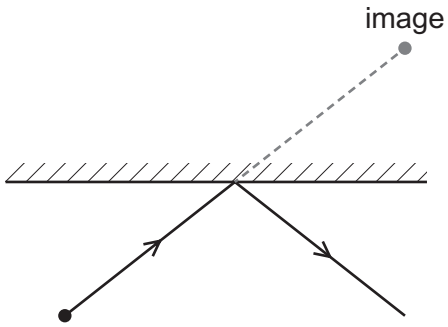

C

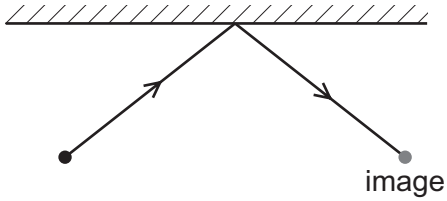

D

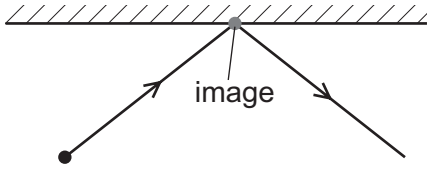

20 Light refracts as it enters glass from air, as shown.

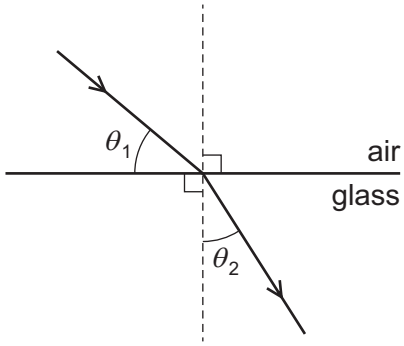

Which expression is equal to the refractive index of glass?

A $\dfrac{\sin\theta_1}{\sin\theta_2}$ **B** $\dfrac{\sin\theta_1}{\sin(90° - \theta_2)}$ **C** $\dfrac{\sin(90° - \theta_1)}{\sin\theta_2}$ **D** $\dfrac{\sin(90° - \theta_1)}{\sin(90° - \theta_2)}$

© UCLES 2024

[Turn over

GradeMax

21 Light travelling at a speed of 3.0×10^8 m/s strikes the surface of a glass block and undergoes refraction as it enters the block.

The diagram shows a ray of this light before and after it enters the block.

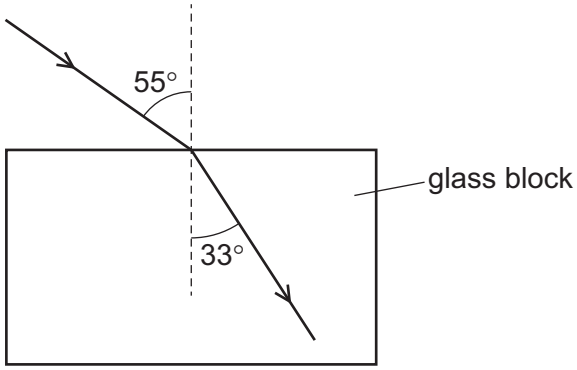

What is the speed of light in the glass?

A 1.8×10^8 m/s

B 2.0×10^8 m/s

C 4.5×10^8 m/s

D 5.0×10^8 m/s

22 Which row about converging lenses and diverging lenses is correct?

	converging lenses	diverging lenses
A	always produce inverted images	can focus a parallel beam of light
B	can be used as magnifying glasses	do not have a principal focus
C	can be used to correct short-sightedness	are usually thinner than converging lenses
D	can produce real and virtual images	can be used to correct short-sightedness

© UCLES 2024

GradeMax

23 A charged rod X is placed on a balance and another rod Y is brought close to it, as shown.

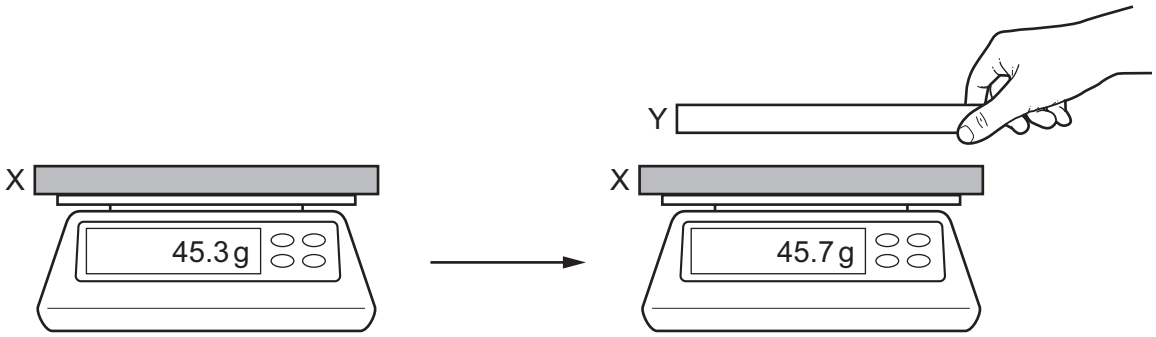

Which combination of charges would cause the change in the balance reading shown?

	X	Y
A	negative charge	negative charge
B	negative charge	positive charge
C	negative charge	no charge
D	positive charge	no charge

24 What is the unit of potential difference (p.d.)?

A ampere

B coulomb

C coulomb / second

D volt

25 The diagram shows a transformer.

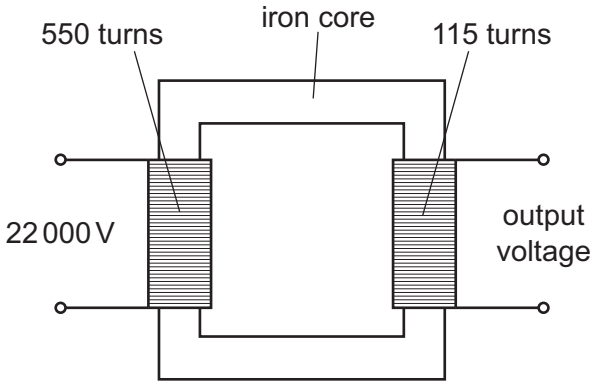

What is the output voltage?

A 0.35 V **B** 2.9 V **C** 4600 V **D** 105 000 V

© UCLES 2024

[Turn over

GradeMax

26 The diagrams show two arrangements of a pair of identical bar magnets.

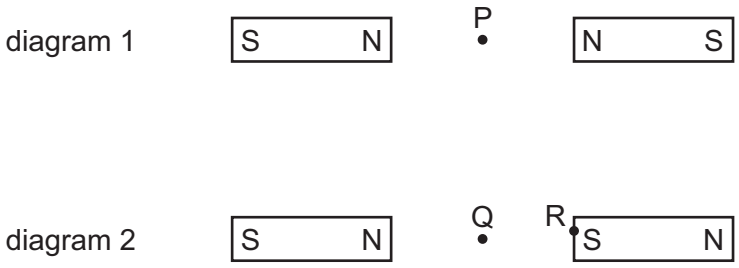

Three points, P, Q and R, are shown.

At which point is the magnetic field due to the magnets weakest and at which point is it strongest?

	weakest magnetic field	strongest magnetic field
A	P	Q
B	P	R
C	Q	P
D	Q	R

27 A nichrome wire, P, has a length of 1.0 m and a diameter of 1.0 mm.

A second nichrome wire, Q, has a length of 2.0 m and a diameter of 2.0 mm.

Which statement correctly compares the resistance of Q with that of P?

A The resistance of Q is one-quarter the resistance of P.

B The resistance of Q is one-half the resistance of P.

C The resistance of Q is the same as the resistance of P.

D The resistance of Q is four times the resistance of P.

28 A student has two resistors.

One resistor has a resistance of 2.0 Ω and the other has a resistance of 40 kΩ.

Which statement is correct?

A When connected in parallel, the combined resistance is 1.9 Ω.

B When connected in parallel, the combined resistance is 2.0 Ω.

C When connected in series, the combined resistance is 1.9 Ω.

D When connected in series, the combined resistance is 42 Ω.

© UCLES 2024

29 In which circuit do both lamps light?

A

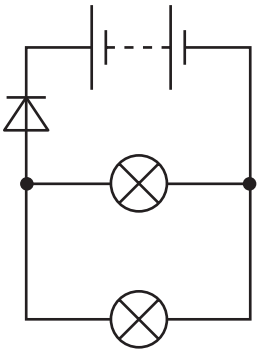

B

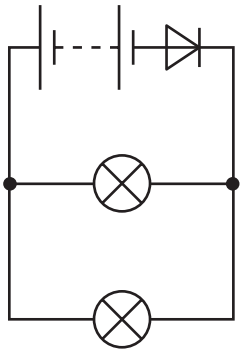

C

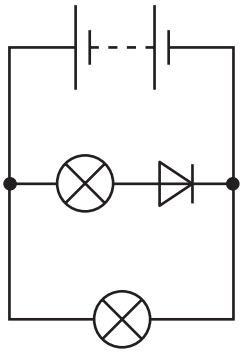

D

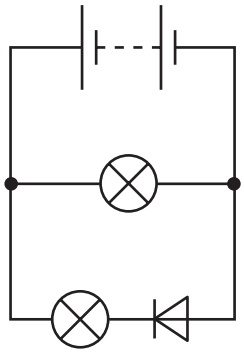

30 An isotope of strontium has the nuclide notation $^{84}_{38}\text{Sr}$.

How many protons and neutrons are there in a nucleus of this isotope?

	protons	neutrons
A	38	46
B	38	84
C	46	38
D	46	84

31 A student is investigating the count rate of a radioactive substance.

How must he adjust his reading for the background count?

A Add the background count to his reading.

B Ignore the background count as it will not affect his reading.

C Subtract the background count from his reading.

D Take repeat readings to eliminate the background count.

32 What occurs during nuclear fusion?

A Two light atomic nuclei join together and emit energy.

B Two light atomic nuclei join together and absorb energy.

C A heavy atomic nucleus splits and emits energy.

D A heavy atomic nucleus splits and absorbs energy.

33 A beta-particle enters a uniform magnetic field directed into the page and deflects downwards, as shown.

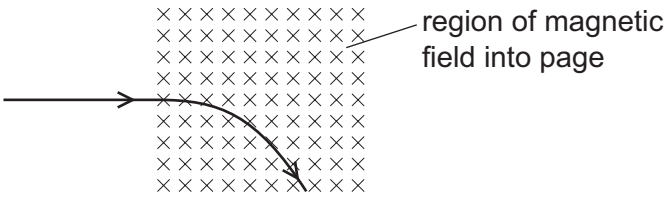

Which direction of electric field would also deflect an electron downwards?

A into the page

B out of the page

C down the page

D up the page

34 The radioactive isotope radon, $^{222}_{86}Rn$, is an alpha (α) emitter.

During this radioactive decay, an isotope of polonium, Po, is produced.

How many neutrons does a nucleus of this isotope of polonium contain?

A 130 **B** 132 **C** 134 **D** 136

35 Which statement gives **two** safety precautions to take when a person is working with ionising radiation?

A decrease exposure time and decrease distance between the person and the source

B decrease exposure time and increase distance between the person and the source

C increase exposure time and decrease distance between the person and the source

D increase exposure time and increase distance between the person and the source

36 Which list correctly shows the planets in decreasing order of distance from the Sun?

A Jupiter $\rightarrow$ Saturn $\rightarrow$ Neptune $\rightarrow$ Uranus

B Jupiter $\rightarrow$ Saturn $\rightarrow$ Uranus $\rightarrow$ Neptune

C Neptune $\rightarrow$ Uranus $\rightarrow$ Saturn $\rightarrow$ Jupiter

D Uranus $\rightarrow$ Neptune $\rightarrow$ Saturn $\rightarrow$ Jupiter

© UCLES 2024

GradeMax

37 The Sun radiates most of its energy in three regions of the electromagnetic spectrum.

In the pie chart, region 1 is infrared radiation and region 2 is visible radiation.

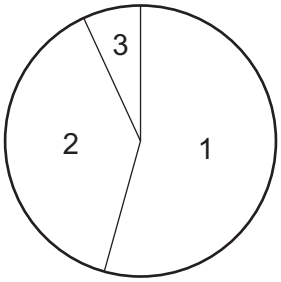

What is region 3?

A microwave

B radio

C ultraviolet

D X-ray

38 The diagram shows a comet moving in an elliptical orbit around the Sun.

At which position is the comet moving with the greatest speed?

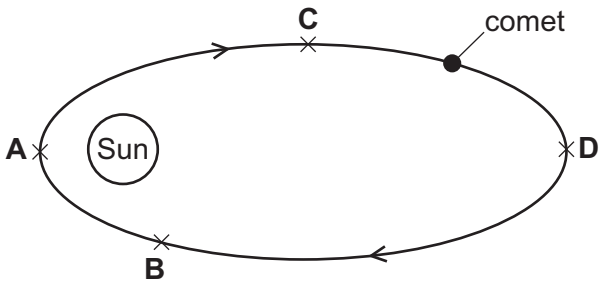

39 Nuclear reactions in the Sun release large quantities of energy.

Which statement about this process is correct?

A It involves the fission of helium to produce hydrogen.

B It involves the fission of hydrogen to produce helium.

C It involves the fusion of helium to produce hydrogen.

D It involves the fusion of hydrogen to produce helium.

© UCLES 2024

[Turn over

GradeMax

40 The table gives data about four planets in our Solar System.

	Uranus	Earth	planet X	planet Y
mean surface temperature / °C	–195	15	–65	–140

What are planets X and Y?

	planet X	planet Y
A	Mars	Saturn
B	Mars	Neptune
C	Mercury	Saturn
D	Mercury	Neptune

Permission to reproduce items where third-party owned material protected by copyright is included has been sought and cleared where possible. Every reasonable effort has been made by the publisher (UCLES) to trace copyright holders, but if any items requiring clearance have unwittingly been included, the publisher will be pleased to make amends at the earliest possible opportunity.

To avoid the issue of disclosure of answer-related information to candidates, all copyright acknowledgements are reproduced online in the Cambridge Assessment International Education Copyright Acknowledgements Booklet. This is produced for each series of examinations and is freely available to download at www.cambridgeinternational.org after the live examination series.

Cambridge Assessment International Education is part of Cambridge Assessment. Cambridge Assessment is the brand name of the University of Cambridge Local Examinations Syndicate (UCLES), which is a department of the University of Cambridge.

© UCLES 2024