GradeMax

* 0000800000001 * DFD

CAMBRIDGE
International Education

Cambridge IGCSE™

CANDIDATE NAME

CENTRE NUMBER

CANDIDATE NUMBER

* 5 2 6 9 8 9 5 8 7 0 *

PHYSICS **0625/42**

Paper 4 Theory (Extended) **May/June 2026**

1 hour 15 minutes

You must answer on the question paper.

No additional materials are needed.

INSTRUCTIONS

- Answer **all** questions.
- Use a black or dark blue pen. You may use an HB pencil for any diagrams or graphs.
- Write your name, centre number and candidate number in the boxes at the top of the page.
- Write your answer to each question in the space provided.
- Do **not** use an erasable pen. Do **not** use correction fluid or tape.
- Do **not** write on any bar codes.
- You may use a calculator.
- You should show all your working and use appropriate units.
- Take the weight of 1.0 kg to be 9.8 N (acceleration of free fall = 9.8 m / s^2).

INFORMATION

- The total mark for this paper is 80.
- The number of marks for each question or part question is shown in brackets [ ].

This document has **16** pages. Any blank pages are indicated.

DC (WW/CB) 356659/2
© Cambridge University Press & Assessment 2026

[Turn over

GradeMax

1 **(a)** Figure 1.1 shows a speed–time graph for a car journey.

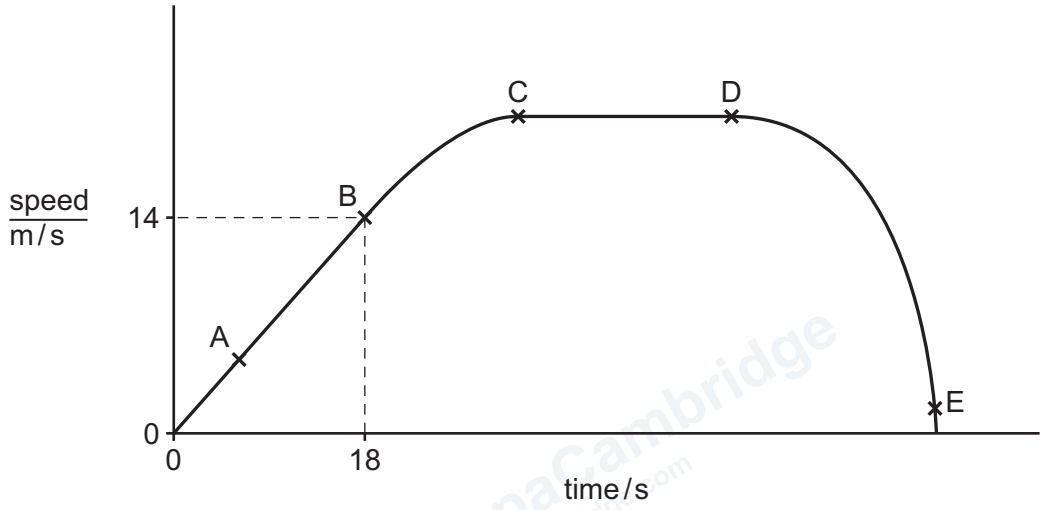

Figure 1.1

(i) State the motion of the car between:

A and B .....

C and D .....

D and E .....

[3]

(ii) Calculate the distance travelled between time = 0 and time = 18 s.

distance = ... m [2]

(b) Velocity is a vector quantity.

(i) Complete the sentence.

A vector quantity has magnitude (size) and ..... . [1]

(ii) Draw a line under each of the quantities in the list that is a vector quantity.

acceleration **electric field strength** **energy**

mass **time** **weight**

[2]

[Total: 8]

© Cambridge University Press & Assessment 2026

DO NOT WRITE IN THIS MARGIN
DO NOT WRITE IN THIS MARGIN
DO NOT WRITE IN THIS MARGIN
DO NOT WRITE IN THIS MARGIN
DO NOT WRITE IN THIS MARGIN

GradeMax

DO NOT WRITE IN THIS MARGIN
DO NOT WRITE IN THIS MARGIN
DO NOT WRITE IN THIS MARGIN
DO NOT WRITE IN THIS MARGIN
DO NOT WRITE IN THIS MARGIN

2 **(a)** A satellite is in a circular orbit around the Earth.

(i) State the direction of the force acting on the satellite.

..... [1]

(ii) A rocket is used to carry the satellite into space.

The initial mass of the rocket and satellite is 1.5×10^4 kg.

The initial force provided by the rocket is 1.9×10^5 N.

Calculate the initial acceleration of the rocket.

acceleration = ... m/s^2 [3]

(b) A large balloon filled with helium floats in the Earth's atmosphere.

(i) Explain, in terms of particles, how the helium gas exerts a pressure on the inside of the balloon.

.....

.....

..... [3]

(ii) The temperature of the air at the balloon's highest point above the Earth is 228 K.

Determine, in °C, the temperature of the air at this height.

temperature = ...°C [1]

[Total: 8]

© Cambridge University Press & Assessment 2026

GradeMax

3 Figure 3.1 shows an electric shower.

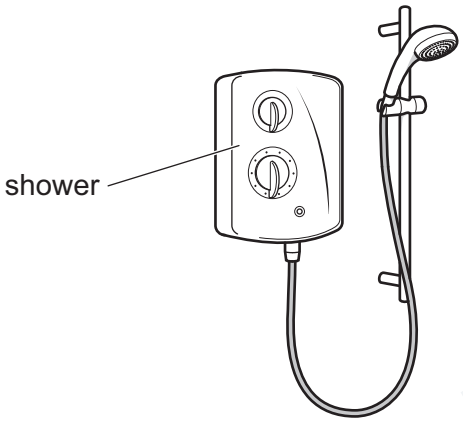

Figure 3.1

The temperature of water as it enters the shower is 15 °C. The water is heated in the shower. The water leaves the shower at a temperature of 38 °C.

(a) The density of water is 1000 kg / m^3.
The specific heat capacity of water is 4200 J / (kg °C).

(i) The water flows through the shower at a rate of 0.0045 m^3 / min.

Show that the mass of water that leaves the shower in 4.0 min is 18 kg.

[2]

(ii) Calculate the energy required to increase the temperature of 18 kg of water from 15 °C to 38 °C.

energy = ... J [2]

DO NOT WRITE IN THIS MARGIN
DO NOT WRITE IN THIS MARGIN
DO NOT WRITE IN THIS MARGIN
DO NOT WRITE IN THIS MARGIN
DO NOT WRITE IN THIS MARGIN

© Cambridge University Press & Assessment 2026

GradeMax

(iii) The energy in **3(a)(ii)** is transferred to the water in 4.0 min.

Calculate the power transferred to the water.

power = ... W [2]

(b) At another time, the temperature of the water leaving the shower is higher. The power supplied to the water remains constant.

Suggest **one** reason for this increase in temperature.

.....

..... [1]

[Total: 7]

DO NOT WRITE IN THIS MARGIN
DO NOT WRITE IN THIS MARGIN
DO NOT WRITE IN THIS MARGIN
DO NOT WRITE IN THIS MARGIN

GradeMax

4 **(a)** Define 'impulse' in words.

..... [1]

(b) A student jumps from the top of a low wall to the ground. The mass of the student is 55 kg. As the student reaches the ground, her speed is 4.6 m / s.

(i) The student stops moving 0.95 s after her feet first touch the ground.

Calculate the resultant force exerted on the student as she stops moving.

resultant force = ... N [2]

(ii) As the student lands, she bends her knees.

Explain how this prevents the student from being injured.

Use ideas about force, momentum and time in your answer.

.....

.....

..... [3]

(iii) Another student stands on the ground.

The area in contact with the ground is 380 cm^2.

The weight of the student is 530 N.

Calculate the pressure exerted by the student on the ground. State the unit.

pressure = ... unit = ... [2]

[Total: 8]

© Cambridge University Press & Assessment 2026

DO NOT WRITE IN THIS MARGIN
DO NOT WRITE IN THIS MARGIN
DO NOT WRITE IN THIS MARGIN
DO NOT WRITE IN THIS MARGIN
DO NOT WRITE IN THIS MARGIN

GradeMax

5 **(a)** On a hot day, a student wets his skin with cold water. The water on the student's skin evaporates.

Explain, in terms of particles, why the student's skin temperature decreases.

.....

.....

.....

.....

.....

..... [3]

(b) Figure 5.1 shows wet clothes on a line in the open air.



Figure 5.1

Water evaporates from the clothes.

State **two** factors which affect the rate of evaporation of the water.

1 .....

2 .....

[2]

[Total: 5]

DO NOT WRITE IN THIS MARGIN
DO NOT WRITE IN THIS MARGIN
DO NOT WRITE IN THIS MARGIN
DO NOT WRITE IN THIS MARGIN
DO NOT WRITE IN THIS MARGIN

© Cambridge University Press & Assessment 2026

GradeMax

6 **(a)** Complete the definition of the 'principal focus' of a lens.

The principal focus of a lens is a point on the principal axis where .....

.....

..... [2]

(b) Figure 6.1 is a full-scale diagram of a converging lens and an object O.

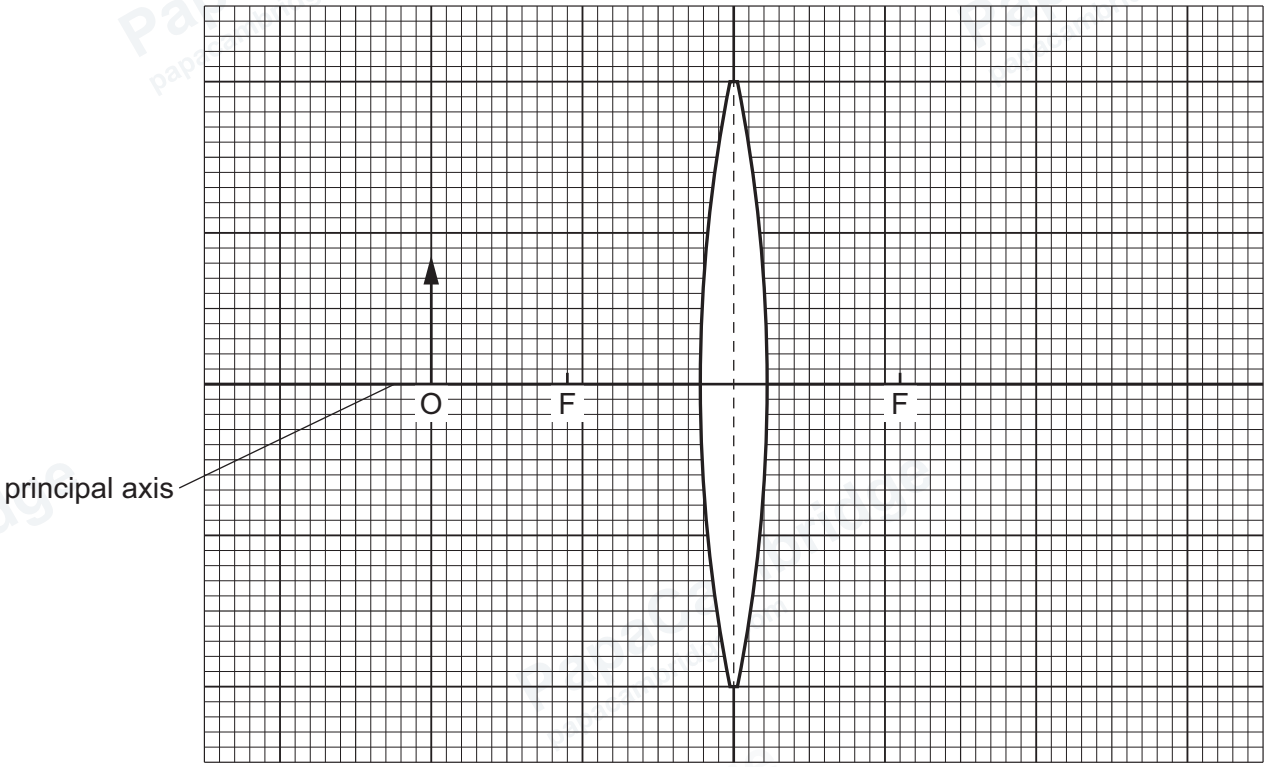

Figure 6.1

The two points labelled F show the positions of the focal points.

On Figure 6.1, draw **two** rays to locate the position of the image. Label the image I. [3]

(c) Visible light is one region of the electromagnetic spectrum.

State the name of the region of the electromagnetic spectrum which has the lowest frequency.

..... [1]

[Total: 6]

© Cambridge University Press & Assessment 2026

DO NOT WRITE IN THIS MARGIN
DO NOT WRITE IN THIS MARGIN
DO NOT WRITE IN THIS MARGIN
DO NOT WRITE IN THIS MARGIN
DO NOT WRITE IN THIS MARGIN

GradeMax

DO NOT WRITE IN THIS MARGIN
DO NOT WRITE IN THIS MARGIN
DO NOT WRITE IN THIS MARGIN
DO NOT WRITE IN THIS MARGIN
DO NOT WRITE IN THIS MARGIN

7 **(a)** Figure 7.1 shows a simplified diagram of a loudspeaker.

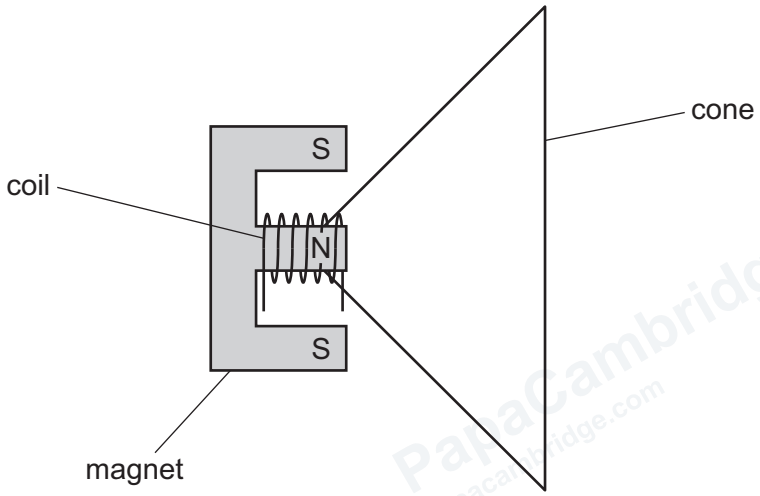

Figure 7.1

(i) Complete the sentences to describe and explain how a loudspeaker produces sound.

A changing magnetic field is produced by the ..... in the coil.

This magnetic field interacts with the magnetic field due to

the ..... .

This causes the cone to vibrate. The vibration of the .....

transfers energy to a student as sound.

[3]

(ii) A sound of frequency 440 Hz is produced by the loudspeaker. The speed of the sound is 340 m / s.

Calculate the wavelength of this sound. State the unit.

wavelength = ... unit ..... [2]

(b) Define 'ultrasound'.

.....

..... [1]

[Total: 6]

© Cambridge University Press & Assessment 2026 **[Turn over**

GradeMax

8 **(a)** **(i)** Complete the definition of an 'electric field'.

An electric field is a region where .....

experiences ..... .

[2]

(ii) Figure 8.1 shows two parallel, oppositely charged metal plates.



Figure 8.1

On Figure 8.1, draw **four** field lines to show the pattern and the direction of the electric field between the two parallel plates. [2]

(b) Figure 8.2 shows an electric circuit that includes a thermistor, component X and a relay. The relay operates a lamp.

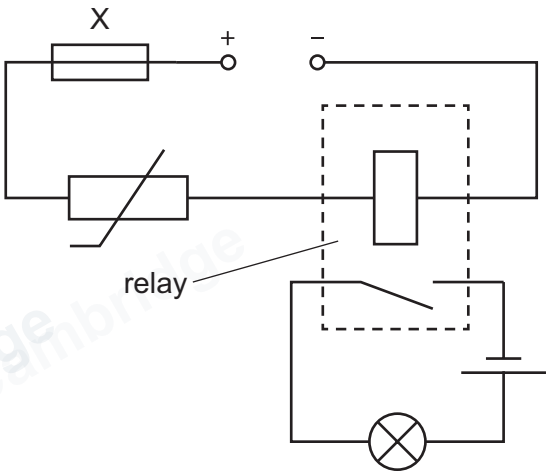

Figure 8.2

(i) Identify component X.

..... [1]

© Cambridge University Press & Assessment 2026

DO NOT WRITE IN THIS MARGIN
DO NOT WRITE IN THIS MARGIN
DO NOT WRITE IN THIS MARGIN
DO NOT WRITE IN THIS MARGIN
DO NOT WRITE IN THIS MARGIN

GradeMax

(ii) The temperature increases. The lamp lights.

Complete the sentences to explain, in terms of potential difference (p.d.) and resistance, why the lamp lights.

When the temperature of the thermistor increases, the .....

of the thermistor ..... . This causes the p.d. across the

..... to increase. The magnetic field produced by the relay

coil ..... . The relay coil attracts ..... ,

which causes the lamp to light.

[3]

(iii) The current in the lamp is 3.2A.

Calculate the charge that flows through the lamp in 120s.

charge = ... C [2]

[Total: 10]

DO NOT WRITE IN THIS MARGIN
DO NOT WRITE IN THIS MARGIN
DO NOT WRITE IN THIS MARGIN
DO NOT WRITE IN THIS MARGIN
DO NOT WRITE IN THIS MARGIN

© Cambridge University Press & Assessment 2026

9 **(a)** Carbon-14 is the only radioactive isotope of carbon that occurs naturally.

(i) State **one** similarity and **one** difference in the composition of the nuclei of atoms of different isotopes of the same element.

similarity .....

difference .....

[1]

(ii) When a tree dies, no new carbon-14 is absorbed by the tree.

A tree contains 16 μg of carbon-14 when it dies.

Carbon-14 has a half-life of 5700 years.

On Figure 9.1, sketch a graph to show how the mass of carbon-14 in the tree decreases during the first 15 000 years after the tree dies.

Show your working and label the axes with suitable values for **one** point on the graph.



Figure 9.1

[3]

(b) Complete the sentence about radiation.

Ionising nuclear radiation that is always present in the environment is known

as ..... radiation.

[1]

(c) State **one** source that makes a significant contribution to the ionising nuclear radiation that is always present in the environment.

..... [1]

[Total: 6]

© Cambridge University Press & Assessment 2026

DO NOT WRITE IN THIS MARGIN
DO NOT WRITE IN THIS MARGIN
DO NOT WRITE IN THIS MARGIN
DO NOT WRITE IN THIS MARGIN
DO NOT WRITE IN THIS MARGIN

GradeMax

10 **(a)** Nuclear fission is the process used to transfer energy in a nuclear reactor in a power station.

(i) Describe the process which occurs when heavy nuclei undergo fission in a power station.

.....

.....

.....

.....

..... [3]

(ii) Complete the sentences to describe how energy is used to generate electricity in a nuclear power station.

Thermal energy is used to heat ..... to produce

..... at high pressure. This drives a .....

connected to a generator.

[2]

(iii) State **one** advantage and **one** disadvantage of the use of nuclear energy to generate electricity compared with the use of light from the Sun (solar cells).

advantage .....

.....

disadvantage .....

.....

[2]

(b) Radiation from the Sun is **not** the source of energy for nuclear energy.

State **one** other energy resource which does **not** have the Sun as its main source of energy.

..... [1]

[Total: 8]

DO NOT WRITE IN THIS MARGIN
DO NOT WRITE IN THIS MARGIN
DO NOT WRITE IN THIS MARGIN
DO NOT WRITE IN THIS MARGIN
DO NOT WRITE IN THIS MARGIN

11 (a) Figure 11.1 shows some statements about the Earth and the approximate time taken for the events described in these statements to take place.

statement	approximate time taken
The Earth orbits the Sun once.	8.3 minutes
The Earth rotates once on its axis.	24 hours
Light travels from the Sun to the Earth.	1 month
The Moon orbits the Earth once.	365 days

Figure 11.1

Draw a line from each statement to the correct time taken. One has been completed for you. [2]

(b) The planet Jupiter orbits the Sun. The average radius of the orbit of Jupiter is 7.78×10^8 km. The average orbital speed of Jupiter is 4.70×10^4 km/h.

Show that the orbital period of Jupiter is 11.9 years.

[3]

DO NOT WRITE IN THIS MARGIN
DO NOT WRITE IN THIS MARGIN
DO NOT WRITE IN THIS MARGIN
DO NOT WRITE IN THIS MARGIN
DO NOT WRITE IN THIS MARGIN

© Cambridge University Press & Assessment 2026

GradeMax

(c) (i) Define a 'light-year' in words.

.....

..... [1]

(ii) A distant galaxy is 1.6×10^{8} light-years away from the Earth.

The current estimate for the Hubble constant is 2.2×10^{-18} per second.

Calculate the speed at which this galaxy moves away from the Earth.

Give your answer in m/s.

speed = ... m/s [2]

[Total: 8]

DO NOT WRITE IN THIS MARGIN
DO NOT WRITE IN THIS MARGIN
DO NOT WRITE IN THIS MARGIN
DO NOT WRITE IN THIS MARGIN
DO NOT WRITE IN THIS MARGIN

© Cambridge University Press & Assessment 2026

GradeMax

BLANK PAGE

DO NOT WRITE IN THIS MARGIN
DO NOT WRITE IN THIS MARGIN
DO NOT WRITE IN THIS MARGIN
DO NOT WRITE IN THIS MARGIN
DO NOT WRITE IN THIS MARGIN

Permission to reproduce items where third-party owned material protected by copyright is included has been sought and cleared where possible. Every reasonable effort has been made by the publisher (Cambridge University Press & Assessment) to trace copyright holders, but if any items requiring clearance have unwittingly been included, the publisher will be pleased to make amends at the earliest possible opportunity.

To avoid the issue of disclosure of answer-related information to candidates, all copyright acknowledgements are reproduced online in our Copyright Acknowledgements Booklet. This is produced for each series of examinations and is freely available to download at www.cambridgeinternational.org after the live examination series.

Cambridge International Education is the name of our awarding body and a part of Cambridge University Press & Assessment, which is a department of the University of Cambridge.

© Cambridge University Press & Assessment 2026